Exprimer des fractions sous forme de mots Nom:

Écrivez le montant ombré sous forme de mot.

Ex)



1)

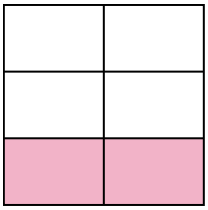

2)



3)

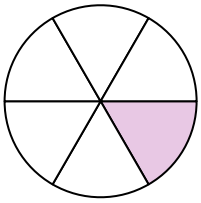

4)

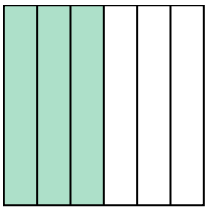

5)

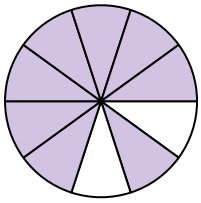

6)

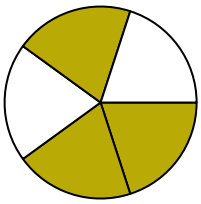

7)

8)

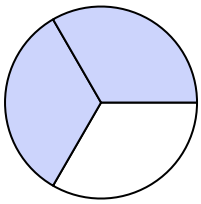

9)

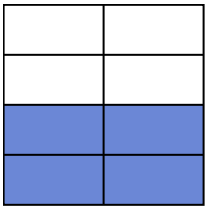

10)

11)



12)



13)



14)

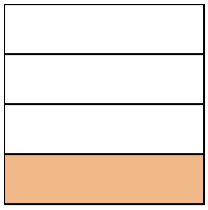

Réponses

Ex. **une moitié**

1. _____
2. _____
3. _____
4. _____
5. _____
6. _____
7. _____
8. _____
9. _____
10. _____
11. _____
12. _____
13. _____
14. _____

1-10	93	86	79	71	64	57	50	43	36	29
11-14	21	14	7	0						

Exprimer des fractions sous forme de mots Nom: **Clé**

Écrivez le montant ombré sous forme de mot.

Ex)



1)

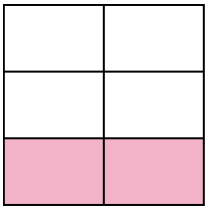

2)



3)

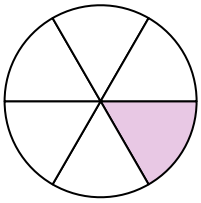

4)

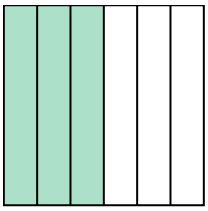

5)

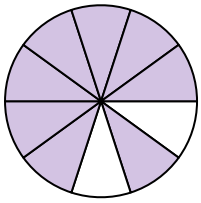

6)

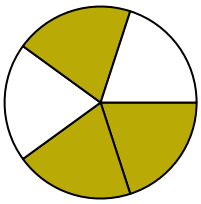

7)

8)

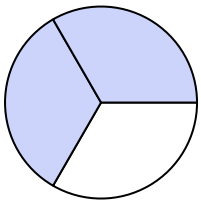

9)

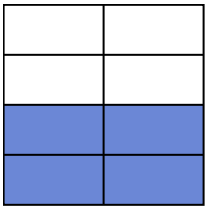

10)

11)



12)



13)



14)

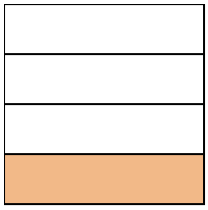

Réponses

Ex. **une moitié**

1. **deux cinquièmes**
2. **deux neuvièmes**
3. **un sixième**
4. **trois sixièmes**
5. **huit dixièmes**
6. **les trois cinquièmes**
7. **trois quarts**
8. **les deux tiers**
9. **quatre septièmes**
10. **un dixième**
11. **les deux tiers**
12. **quatre huitièmes**
13. **une moitié**
14. **un quart**

1-10	93	86	79	71	64	57	50	43	36	29
11-14	21	14	7	0						