Exprimer des fractions sous forme de mots Nom:

Écrivez le montant ombré sous forme de mot.

Ex)

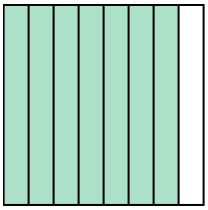

1)

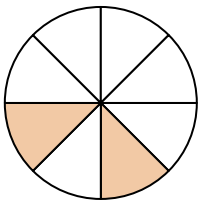

2)

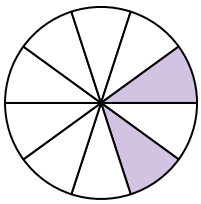

3)

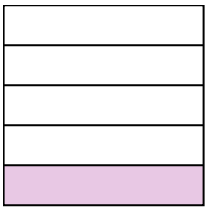

4)



5)

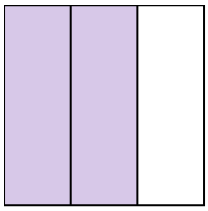

6)

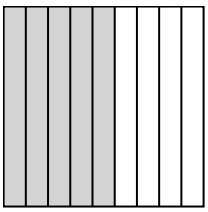

7)

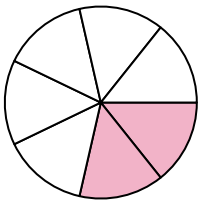

8)



9)



10)

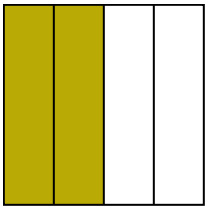

11)



12)



13)

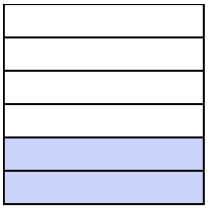

14)

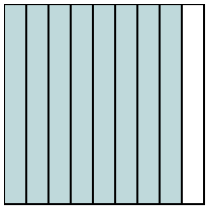

Réponses

Ex. sept huitièmes

1. _____
2. _____
3. _____
4. _____
5. _____
6. _____
7. _____
8. _____
9. _____
10. _____
11. _____
12. _____
13. _____
14. _____

1-10	93	86	79	71	64	57	50	43	36	29
11-14	21	14	7	0						

Exprimer des fractions sous forme de mots Nom: **Clé**

Écrivez le montant ombré sous forme de mot.

Ex)

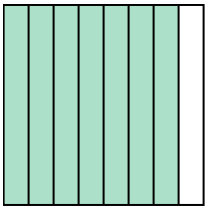

1)

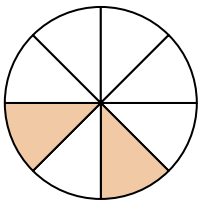

2)

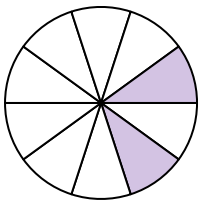

3)

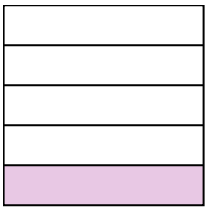

4)



5)

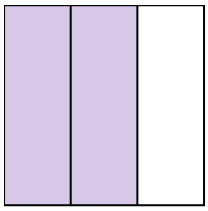

6)

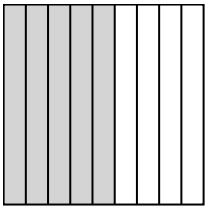

7)

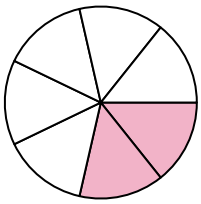

8)



9)



10)

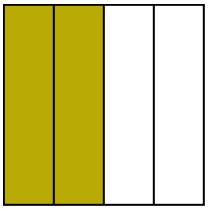

11)



12)



13)

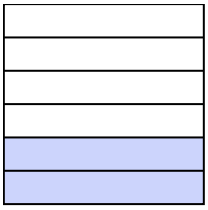

14)

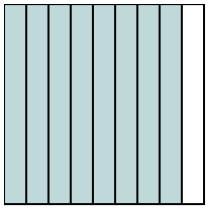

Réponses

Ex. sept huitièmes

1. deux huitièmes
2. les deux dixièmes
3. un cinquième
4. une moitié
5. les deux tiers
6. cinq neuvièmes
7. deux septièmes
8. un tiers
9. les trois cinquièmes
10. les deux quarts
11. cinq sixièmes
12. huit dixièmes
13. les deux sixièmes
14. huit neuvièmes

1-10	93	86	79	71	64	57	50	43	36	29
11-14	21	14	7	0						