Exprimer des fractions sous forme de mots

Nom:

Écrivez le montant ombré sous forme de mot.

Ex)

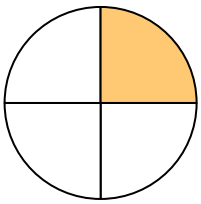

1)

2)



3)

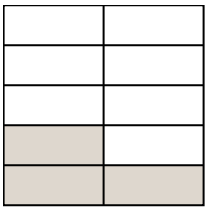

4)

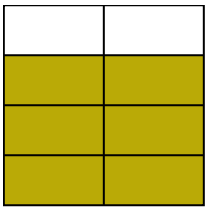

5)

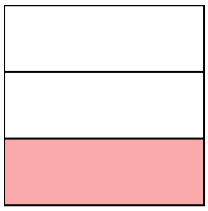

6)

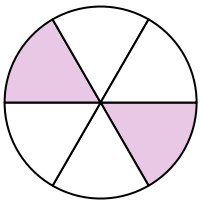

7)



8)

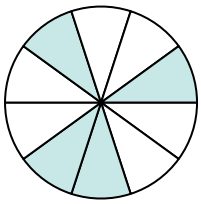

9)

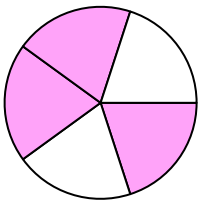

10)

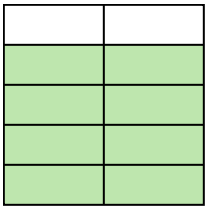

11)

12)

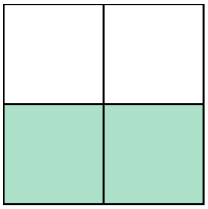

13)

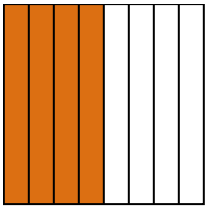

14)

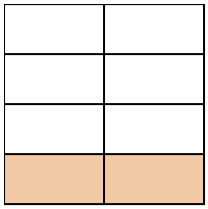

Réponses

Ex. **un quart**

1. _____
2. _____
3. _____
4. _____
5. _____
6. _____
7. _____
8. _____
9. _____
10. _____
11. _____
12. _____
13. _____
14. _____

1-10	93	86	79	71	64	57	50	43	36	29
11-14	21	14	7	0						

Exprimer des fractions sous forme de mots Nom: **Clé**

Écrivez le montant ombré sous forme de mot.

Ex)

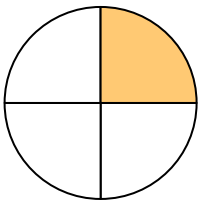

1)

2)



3)

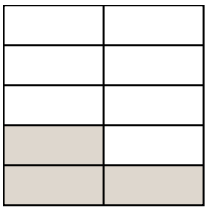

4)

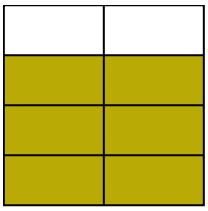

5)

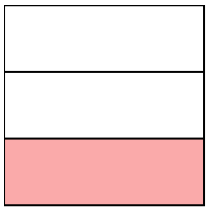

6)

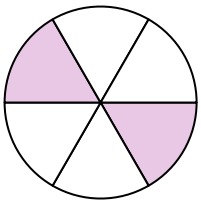

7)



8)

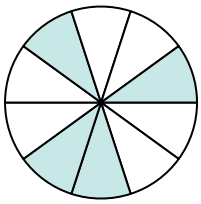

9)

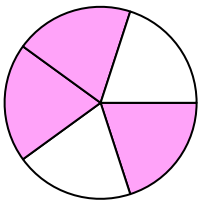

10)

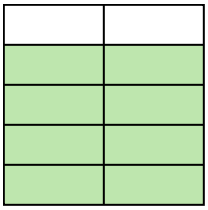

11)

12)

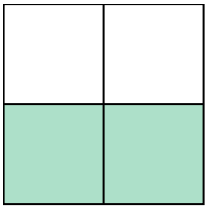

13)

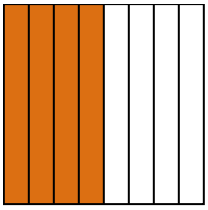

14)

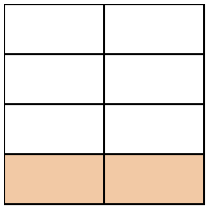

Réponses

Ex. un quart

1. les deux sixièmes
2. une moitié
3. trois neuvièmes
4. six-septièmes
5. un tiers
6. les deux sixièmes
7. quatre dixièmes
8. quatre dixièmes
9. les trois cinquièmes
10. huit neuvièmes
11. les deux quarts
12. les deux tiers
13. quatre huitièmes
14. deux septièmes

1-10	93	86	79	71	64	57	50	43	36	29
11-14	21	14	7	0						