Trouver la Fraction Équivalente - Visuel

Nom:

Déterminez quelle lettre représente le mieux chaque fraction.

1)

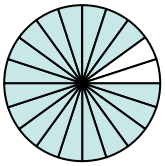

$\frac{18}{20}$

2)

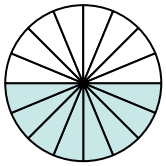

$\frac{8}{16}$

3)

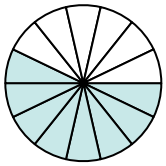

$\frac{8}{14}$

4)

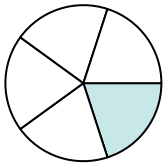

$\frac{1}{5}$

5)

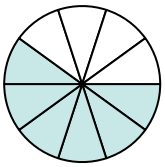

$\frac{6}{10}$

6)

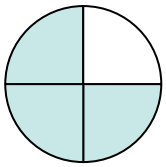

$\frac{3}{4}$

7)

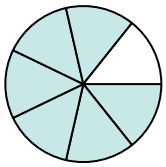

$\frac{6}{7}$

8)

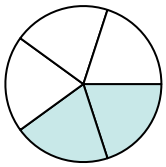

$\frac{2}{5}$

9)

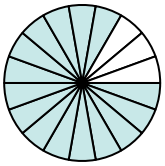

$\frac{15}{18}$

10)

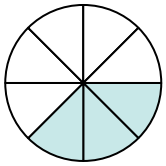

$\frac{3}{8}$

11)

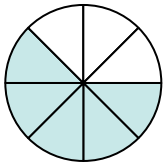

$\frac{5}{8}$

12)

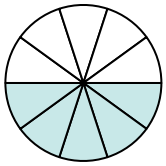

$\frac{5}{10}$

A.

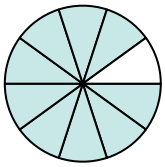

$\frac{9}{10}$

B.



$\frac{10}{20}$

C.

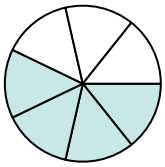

$\frac{4}{7}$

D.

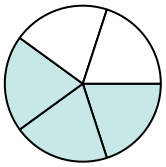

$\frac{3}{5}$

E.

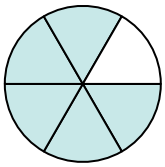

$\frac{5}{6}$

F.

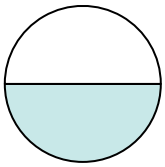

$\frac{1}{2}$

G.

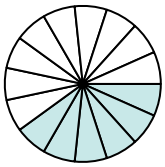

$\frac{6}{15}$

H.

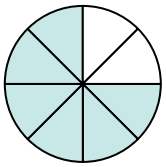

$\frac{6}{8}$

I.

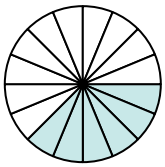

$\frac{6}{16}$

J.



$\frac{4}{20}$

K.

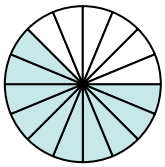

$\frac{10}{16}$

L.

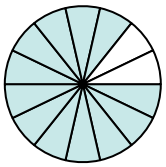

$\frac{12}{14}$

Réponses

1. _____
2. _____
3. _____
4. _____
5. _____
6. _____
7. _____
8. _____
9. _____
10. _____
11. _____
12. _____

1-10	92	83	75	67	58	50	42	33	25	17
11-12	8	0								

Trouver la Fraction Équivalente - Visuel

Nom: **Clé**

Déterminez quelle lettre représente le mieux chaque fraction.

1)

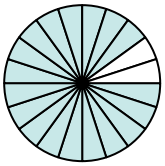

$\frac{18}{20}$

2)

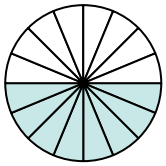

$\frac{8}{16}$

3)

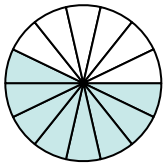

$\frac{8}{14}$

4)

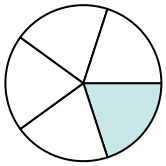

$\frac{1}{5}$

5)

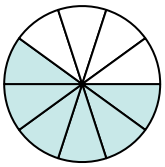

$\frac{6}{10}$

6)

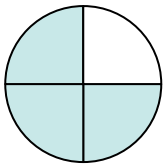

$\frac{3}{4}$

7)

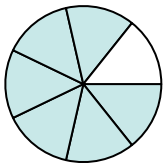

$\frac{6}{7}$

8)

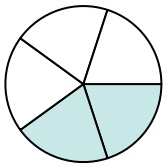

$\frac{2}{5}$

9)

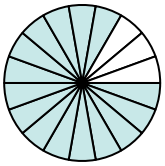

$\frac{15}{18}$

10)

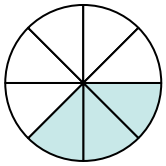

$\frac{3}{8}$

11)

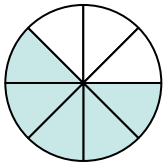

$\frac{5}{8}$

12)

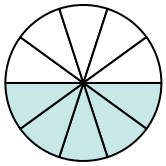

$\frac{5}{10}$

A.

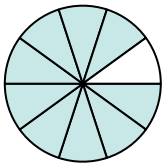

$\frac{9}{10}$

B.



$\frac{10}{20}$

C.

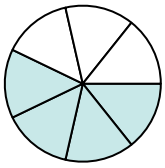

$\frac{4}{7}$

D.

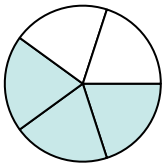

$\frac{3}{5}$

E.

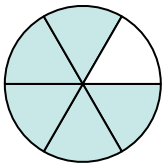

$\frac{5}{6}$

F.

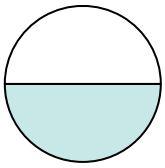

$\frac{1}{2}$

G.

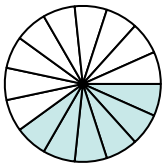

$\frac{6}{15}$

H.

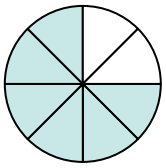

$\frac{6}{8}$

I.

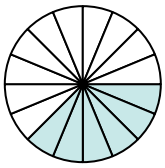

$\frac{6}{16}$

J.

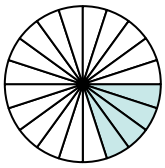

$\frac{4}{20}$

K.

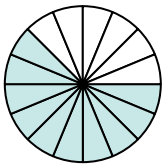

$\frac{10}{16}$

L.

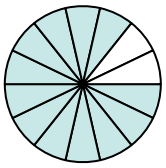

$\frac{12}{14}$

Réponses

1. A
2. F
3. C
4. J
5. D
6. H
7. L
8. G
9. E
10. I
11. K
12. B

1-10	92	83	75	67	58	50	42	33	25	17
11-12	8	0								