Identifier les Fractions

Nom:

Déterminer quelle lettre représente le mieux chaque fraction.

1) Quelle réponse représente le mieux $^{2}/_{3}$?

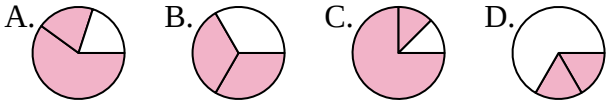

2) Quelle réponse représente le mieux $^{2}/_{4}$?

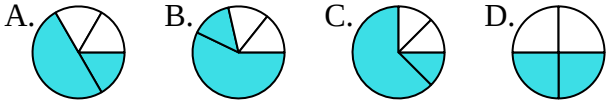

3) Quelle réponse représente le mieux $^{3}/_{6}$?

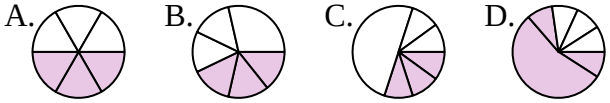

4) Quelle réponse représente le mieux $^{6}/_{8}$?

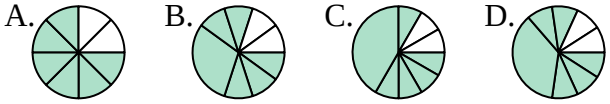

5) Quelle réponse représente le mieux $^{1}/_{3}$?

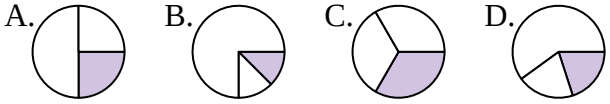

6) Quelle réponse représente le mieux $^{3}/_{4}$?

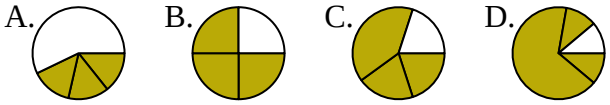

7) Quelle réponse représente le mieux $^{2}/_{6}$?

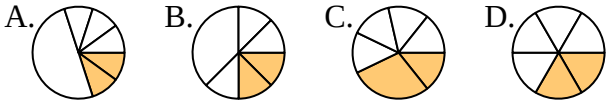

8) Quelle réponse représente le mieux $^{3}/_{8}$?

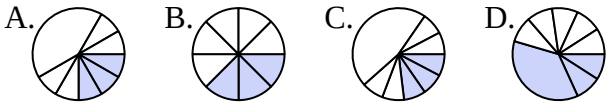

9) Quelle réponse représente le mieux $^{1}/_{4}$?

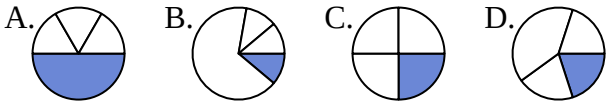

10) Quelle réponse représente le mieux $^{5}/_{6}$?

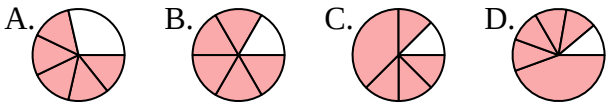

11) Quelle réponse représente le mieux $^{2}/_{8}$?

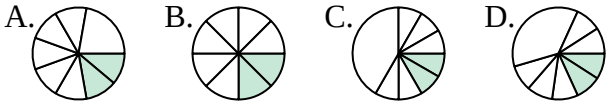

12) Quelle réponse représente le mieux $^{4}/_{6}$?

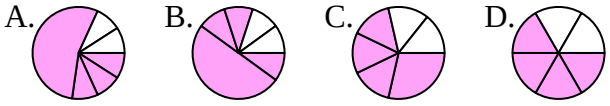

Réponses

1. _____
2. _____
3. _____
4. _____
5. _____
6. _____
7. _____
8. _____
9. _____
10. _____
11. _____
12. _____

1-10	92	83	75	67	58	50	42	33	25	17
11-12	8	0								

Identifier les Fractions

Nom: **Clé**

Déterminer quelle lettre représente le mieux chaque fraction.

1) Quelle réponse représente le mieux $^{2}/_{3}$?

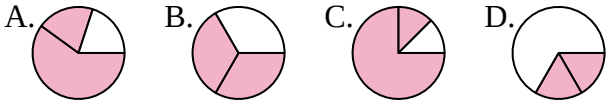

2) Quelle réponse représente le mieux $^{2}/_{4}$?

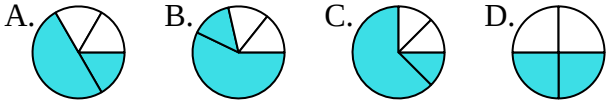

3) Quelle réponse représente le mieux $^{3}/_{6}$?

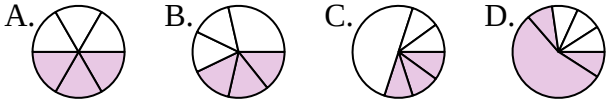

4) Quelle réponse représente le mieux $^{6}/_{8}$?

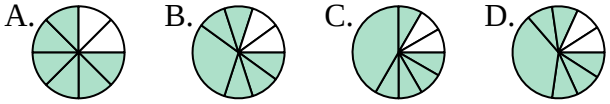

5) Quelle réponse représente le mieux $^{1}/_{3}$?

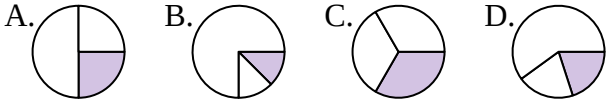

6) Quelle réponse représente le mieux $^{3}/_{4}$?

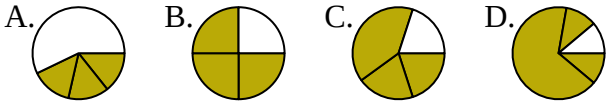

7) Quelle réponse représente le mieux $^{2}/_{6}$?

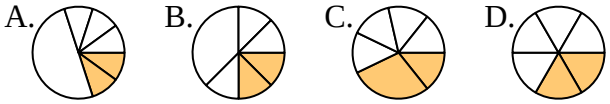

8) Quelle réponse représente le mieux $^{3}/_{8}$?

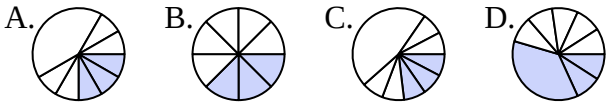

9) Quelle réponse représente le mieux $^{1}/_{4}$?

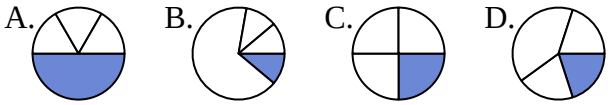

10) Quelle réponse représente le mieux $^{5}/_{6}$?

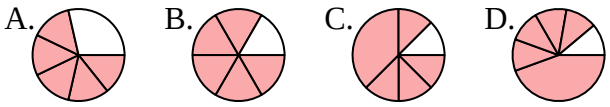

11) Quelle réponse représente le mieux $^{2}/_{8}$?

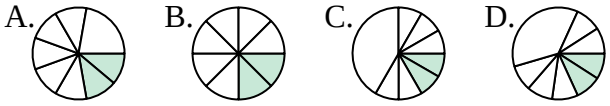

12) Quelle réponse représente le mieux $^{4}/_{6}$?

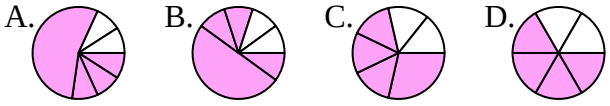

Réponses

1. **B**
2. **D**
3. **A**
4. **A**
5. **C**
6. **B**
7. **D**
8. **B**
9. **C**
10. **B**
11. **B**
12. **D**

1-10	92	83	75	67	58	50	42	33	25	17
11-12	8	0								