Fractions Impropres et Nombres Mixtes (Visuel) Nom:

Exprimez chaque montant en un nombre mixte.

1) 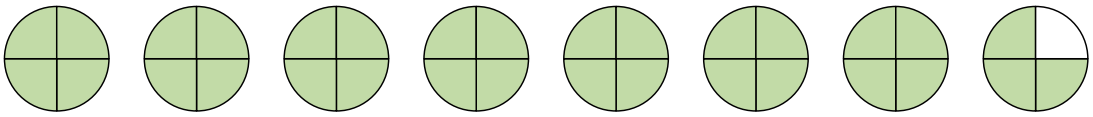

2) 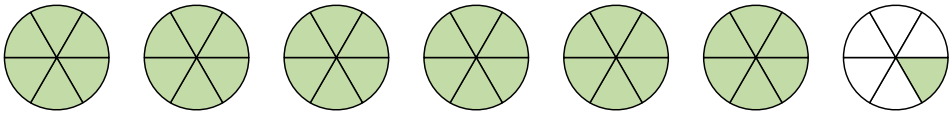

3) 

4) 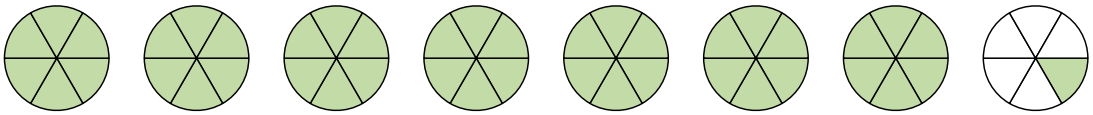

5) 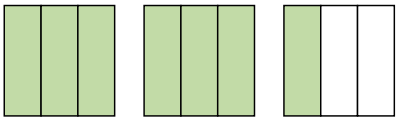

Exprimez chaque montant en une fraction impropre.

6) 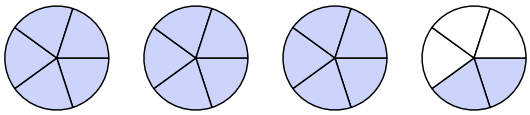

7) 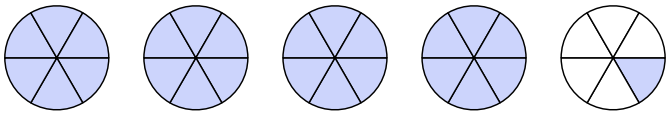

8) 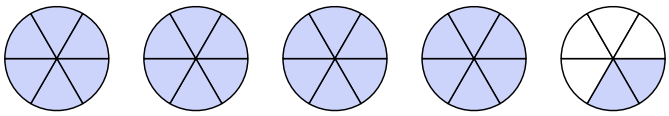

9) 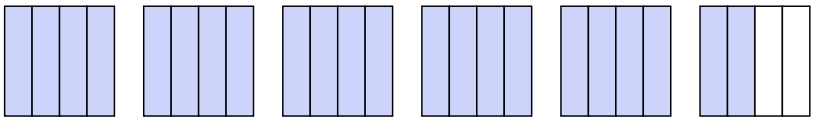

10) 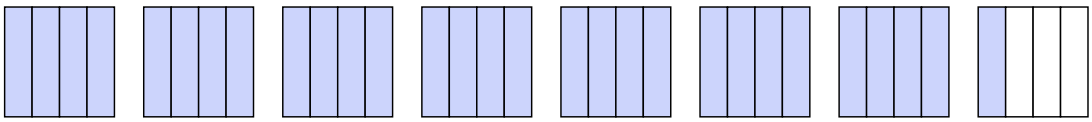

11) 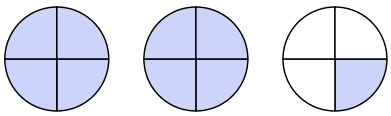

Réponses

1. _____
2. _____
3. _____
4. _____
5. _____
6. _____
7. _____
8. _____
9. _____
10. _____
11. _____

1-10	91	82	73	64	55	45	36	27	18	9
11	0									

Fractions Impropres et Nombres Mixtes (Visuel) Nom: **Clé**

Exprimez chaque montant en un nombre mixte.

1) 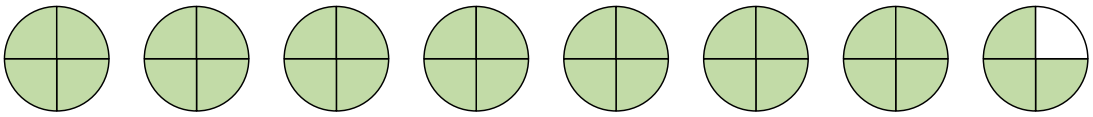

2) 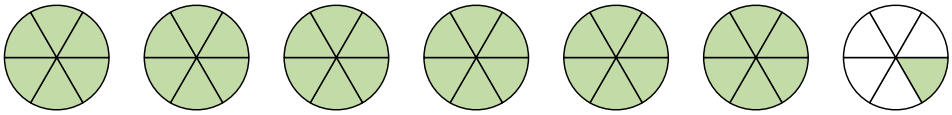

3) 

4) 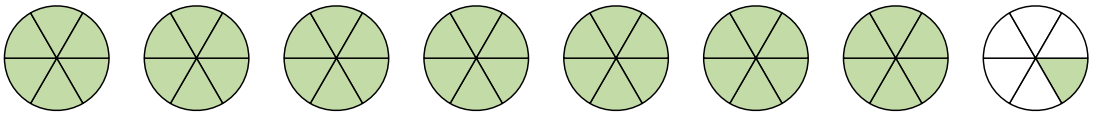

5) 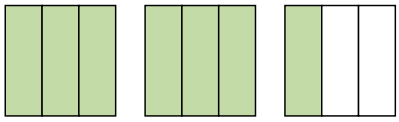

Exprimez chaque montant en une fraction impropre.

6) 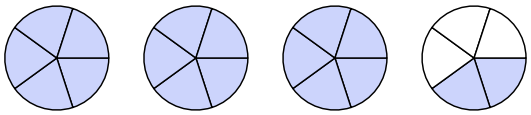

7) 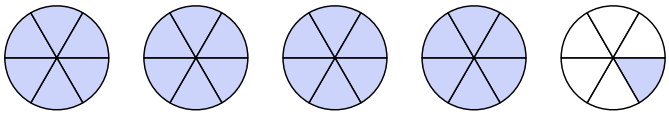

8) 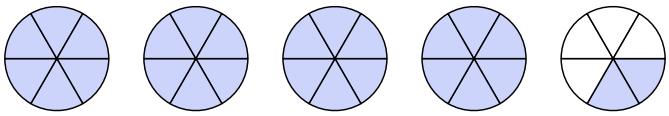

9) 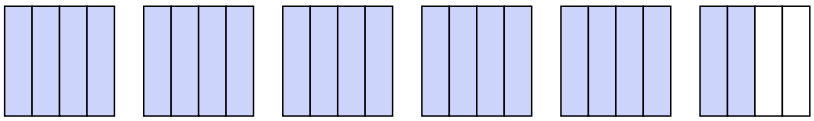

10) 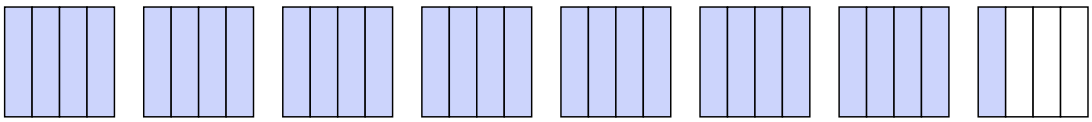

11) 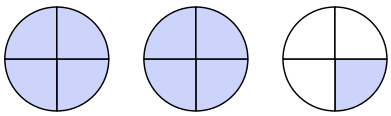

Réponses

1. $7\frac{3}{4}$
2. $6\frac{1}{6}$
3. $2\frac{5}{6}$
4. $7\frac{1}{6}$
5. $2\frac{1}{3}$
6. $\frac{17}{5}$
7. $\frac{25}{6}$
8. $\frac{26}{6}$
9. $\frac{22}{4}$
10. $\frac{29}{4}$
11. $\frac{9}{4}$

1-10	91	82	73	64	55	45	36	27	18	9
11	0									