Multiplication de Fractions (visuelle) Nom:

Utilisez la grille comme exemple afin de multiplier les deux fractions.

Ex) $\frac{3}{5} \times \frac{2}{3} =$

1) $\frac{4}{8} \times \frac{2}{3} =$

2) $\frac{5}{6} \times \frac{1}{3} =$

3) $\frac{2}{5} \times \frac{3}{8} =$

4) $\frac{3}{5} \times \frac{8}{9} =$

5) $\frac{1}{3} \times \frac{1}{2} =$

6) $\frac{3}{4} \times \frac{8}{9} =$

7) $\frac{1}{2} \times \frac{3}{6} =$

8) $\frac{4}{6} \times \frac{4}{6} =$

9) $\frac{2}{7} \times \frac{5}{6} =$

10) $\frac{4}{8} \times \frac{5}{8} =$

11) $\frac{1}{2} \times \frac{1}{3} =$

Réponses

Ex. $\frac{6}{15}$

1. _____
2. _____
3. _____
4. _____
5. _____
6. _____
7. _____
8. _____
9. _____
10. _____
11. _____

1-10	91	82	73	64	55	45	36	27	18	9
11	0									

Multiplication de Fractions (visuelle) Nom: **Clé**

Utilisez la grille comme exemple afin de multiplier les deux fractions.

Ex) $\frac{3}{5} \times \frac{2}{3} =$

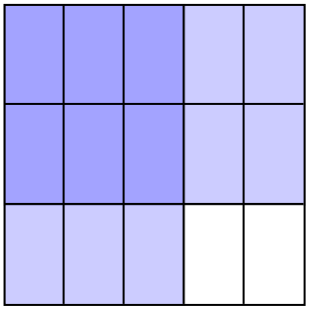

1) $\frac{4}{8} \times \frac{2}{3} =$

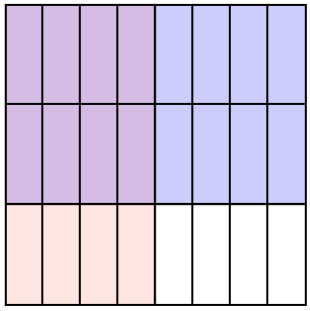

2) $\frac{5}{6} \times \frac{1}{3} =$

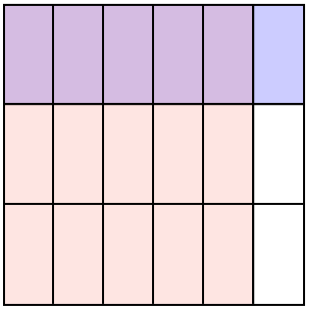

3) $\frac{2}{5} \times \frac{3}{8} =$

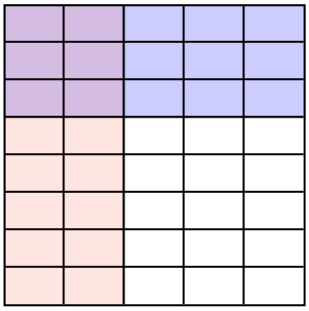

4) $\frac{3}{5} \times \frac{8}{9} =$

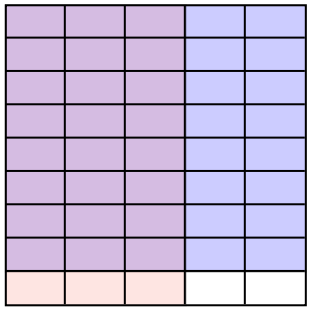

5) $\frac{1}{3} \times \frac{1}{2} =$



6) $\frac{3}{4} \times \frac{8}{9} =$

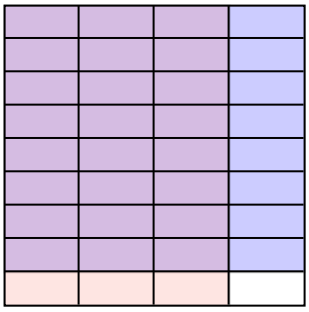

7) $\frac{1}{2} \times \frac{3}{6} =$

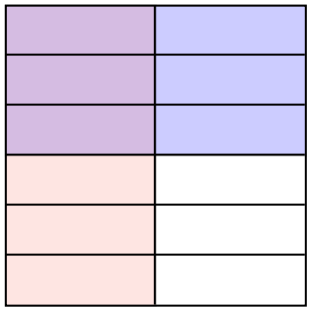

8) $\frac{4}{6} \times \frac{4}{6} =$

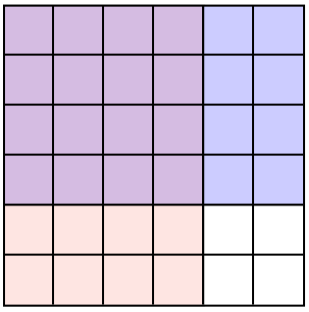

9) $\frac{2}{7} \times \frac{5}{6} =$

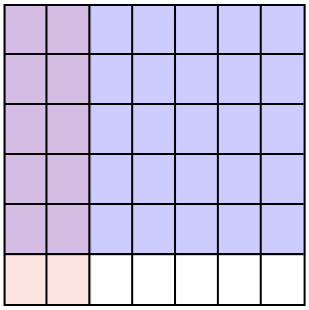

10) $\frac{4}{8} \times \frac{5}{8} =$



11) $\frac{1}{2} \times \frac{1}{3} =$



Réponses

Ex. $\frac{6}{15}$

1. $\frac{8}{24}$
2. $\frac{5}{18}$
3. $\frac{6}{40}$
4. $\frac{24}{45}$
5. $\frac{1}{6}$
6. $\frac{24}{36}$
7. $\frac{3}{12}$
8. $\frac{16}{36}$
9. $\frac{10}{42}$
10. $\frac{20}{64}$
11. $\frac{1}{6}$

1-10	91	82	73	64	55	45	36	27	18	9
11	0									