Diviser avec une Droite Numérique

Nom:

Avec la droite numérique, résoudre chaque problème. Le premier vous est donné.

1) $7 \div \frac{3}{5}$

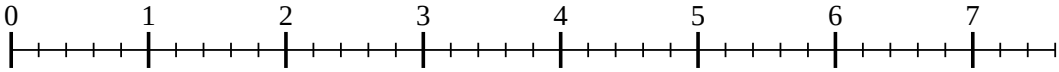

2) $6 \div \frac{2}{6}$

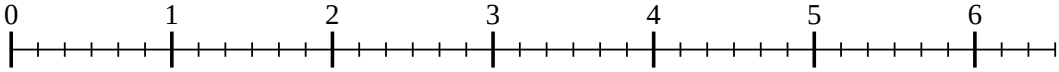

3) $6 \div \frac{2}{4}$

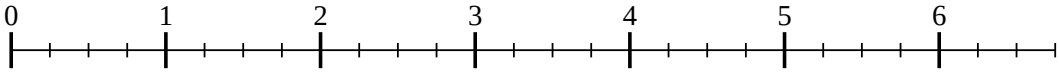

4) $6 \div \frac{2}{3}$

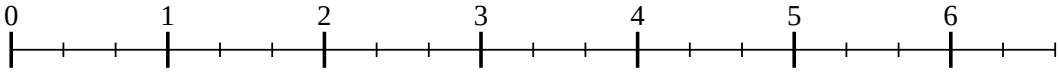

5) $7 \div \frac{2}{6}$

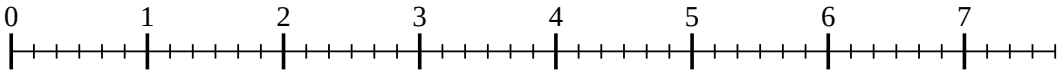

6) $2 \div \frac{3}{5}$

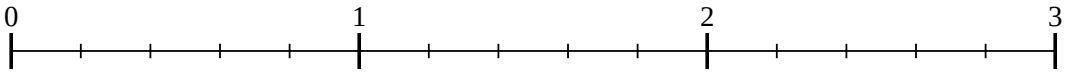

7) $4 \div \frac{2}{4}$

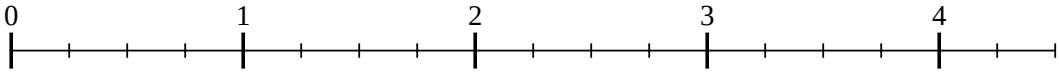

8) $2 \div \frac{3}{6}$

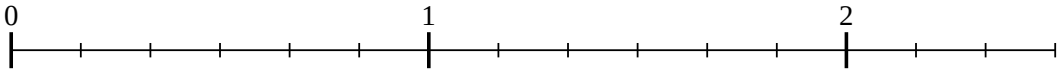

9) $5 \div \frac{3}{5}$

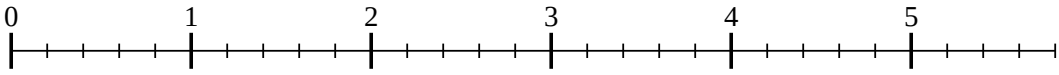

Réponses

1. _____
2. _____
3. _____
4. _____
5. _____
6. _____
7. _____
8. _____
9. _____

1-9	89	78	67	56	44	33	22	11	0

Diviser avec une Droite Numérique Nom: **Clé**

Avec la droite numérique, résoudre chaque problème. Le premier vous est donné.

1) $7 \div {}^{3}/_{5}$

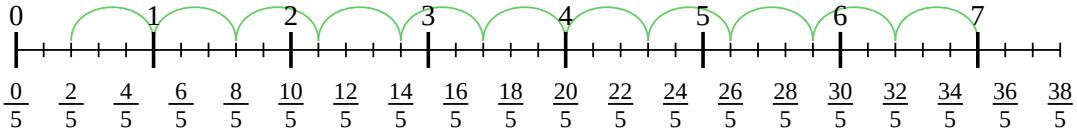

2) $6 \div {}^{2}/_{6}$

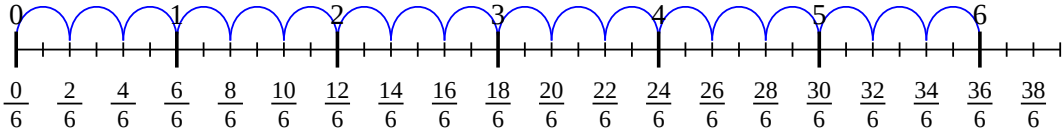

3) $6 \div {}^{2}/_{4}$

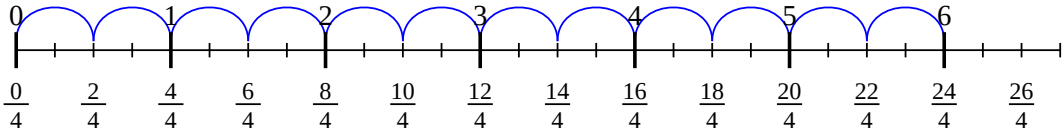

4) $6 \div {}^{2}/_{3}$

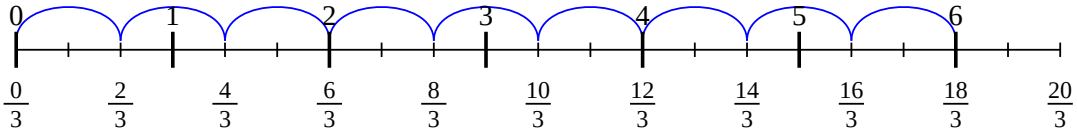

5) $7 \div {}^{2}/_{6}$

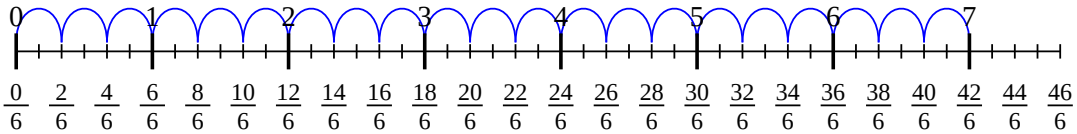

6) $2 \div {}^{3}/_{5}$

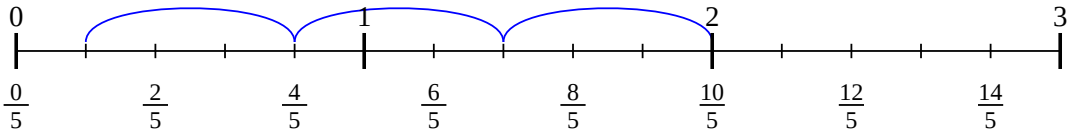

7) $4 \div {}^{2}/_{4}$

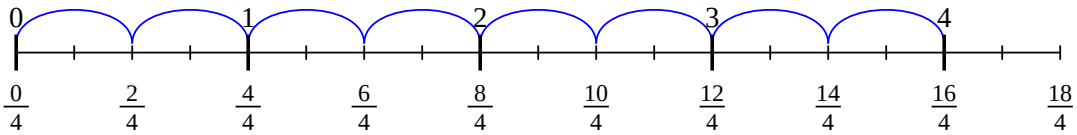

8) $2 \div {}^{3}/_{6}$

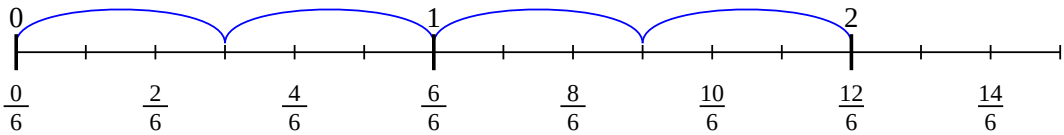

9) $5 \div {}^{3}/_{5}$

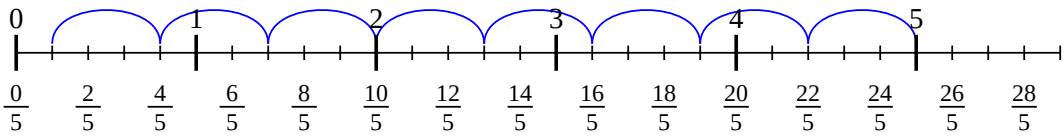

Réponses

1. $^{35}/_{3}$
2. $^{36}/_{2}$
3. $^{24}/_{2}$
4. $^{18}/_{2}$
5. $^{42}/_{2}$
6. $^{10}/_{3}$
7. $^{16}/_{2}$
8. $^{12}/_{3}$
9. $^{25}/_{3}$

1-9	89	78	67	56	44	33	22	11	0