Diviser avec une Droite Numérique Nom:

Utilisez la droite numérique pour résoudre chaque problème. Le premier est résolu.

1) $4 \div \frac{1}{6}$

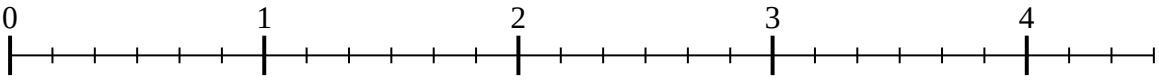

2) $3 \div \frac{1}{6}$

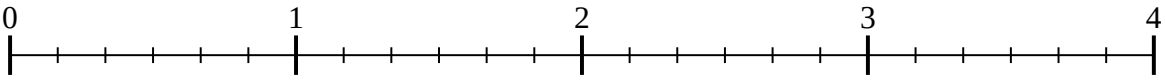

3) $2 \div \frac{1}{6}$

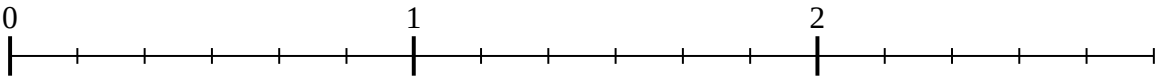

4) $2 \div \frac{1}{4}$



5) $6 \div \frac{1}{4}$

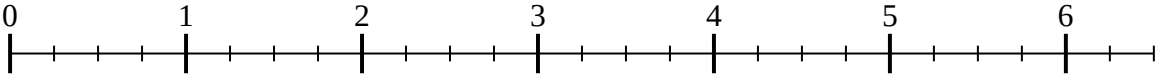

6) $7 \div \frac{1}{5}$

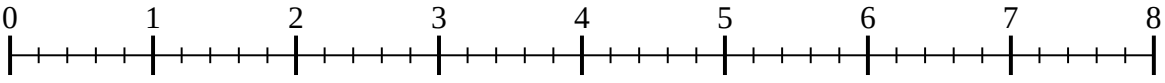

7) $7 \div \frac{1}{6}$

8) $4 \div \frac{1}{4}$

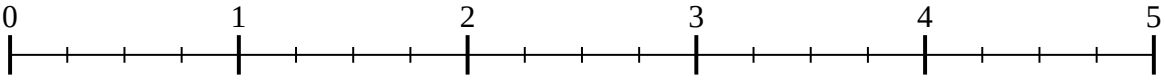

9) $4 \div \frac{1}{5}$

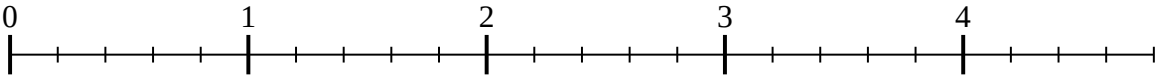

Réponses

1. _____
2. _____
3. _____
4. _____
5. _____
6. _____
7. _____
8. _____
9. _____

1-9	89	78	67	56	44	33	22	11	0

Diviser avec une Droite Numérique Nom: **Clé**

Utilisez la droite numérique pour résoudre chaque problème. Le premier est résolu.

1) $4 \div \frac{1}{6}$

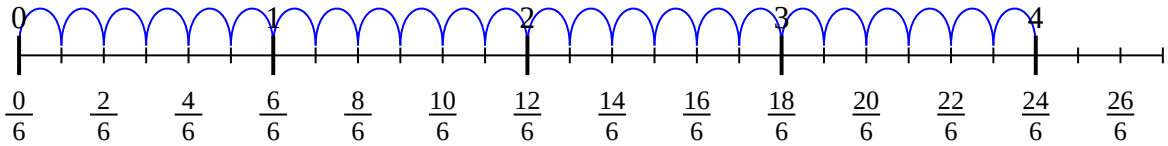

2) $3 \div \frac{1}{6}$

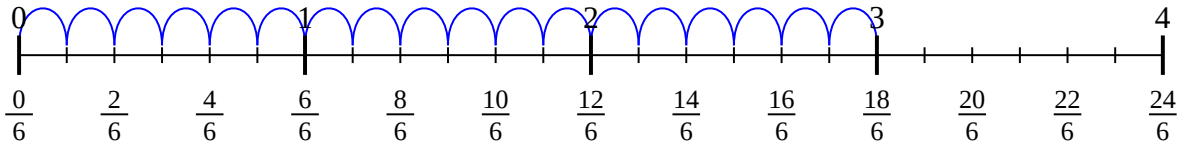

3) $2 \div \frac{1}{6}$

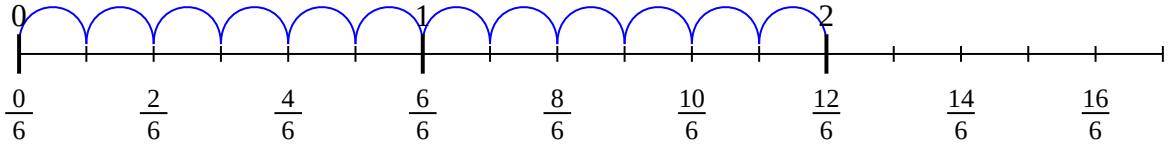

4) $2 \div \frac{1}{4}$

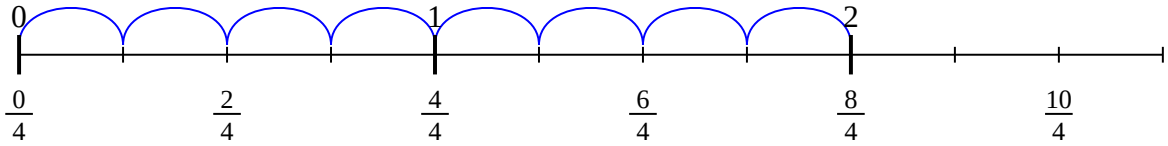

5) $6 \div \frac{1}{4}$

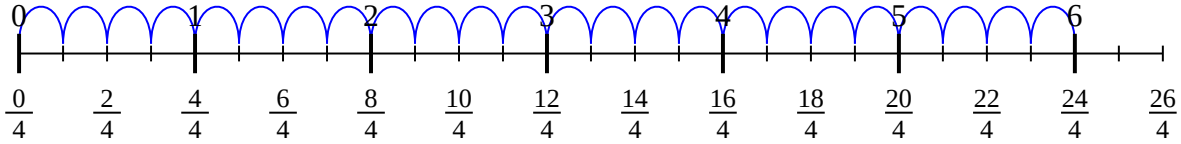

6) $7 \div \frac{1}{5}$

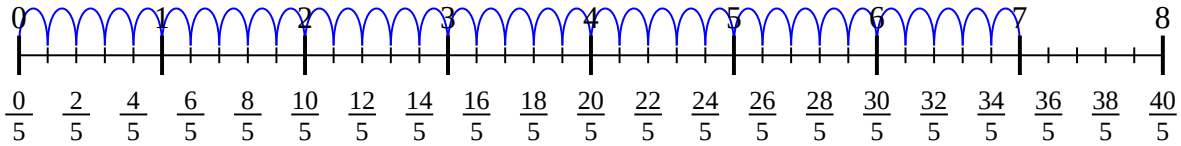

7) $7 \div \frac{1}{6}$

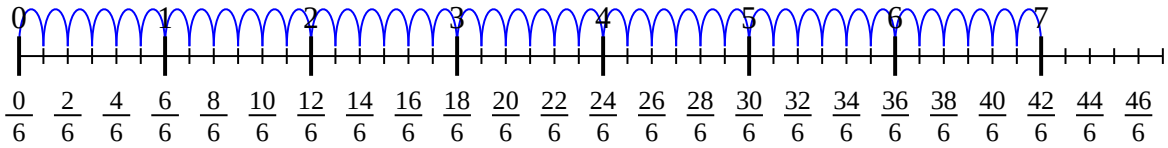

8) $4 \div \frac{1}{4}$

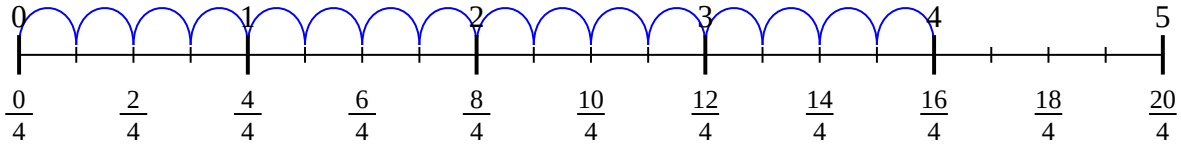

9) $4 \div \frac{1}{5}$

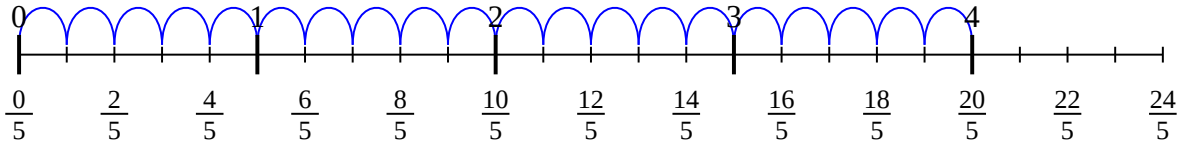

Réponses

1. 24/1
2. 18/1
3. 12/1
4. 8/1
5. 24/1
6. 35/1
7. 42/1
8. 16/1
9. 20/1

1-9	89	78	67	56	44	33	22	11	0

Diviser avec une Droite Numérique Nom:

Utilisez la droite numérique pour résoudre chaque problème. Le premier est résolu.

$^{12}/_{1}$	$^{20}/_{1}$	$^{8}/_{1}$	$^{24}/_{1}$
$^{35}/_{1}$	$^{42}/_{1}$	$^{18}/_{1}$	$^{16}/_{1}$
$^{24}/_{1}$			

1) $4 \div {}^{1}/_{6}$

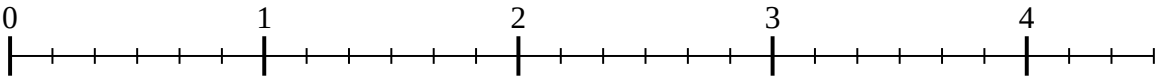

2) $3 \div {}^{1}/_{6}$

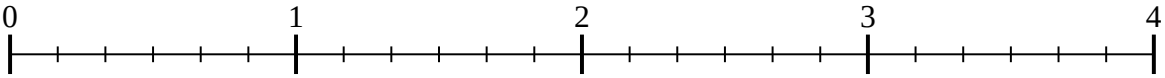

3) $2 \div {}^{1}/_{6}$

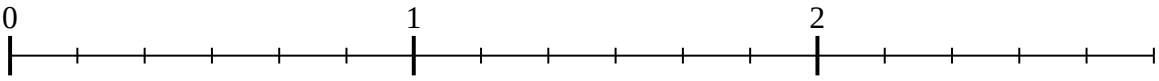

4) $2 \div {}^{1}/_{4}$



5) $6 \div {}^{1}/_{4}$

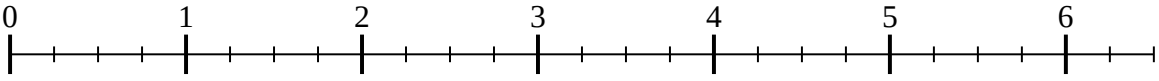

6) $7 \div {}^{1}/_{5}$

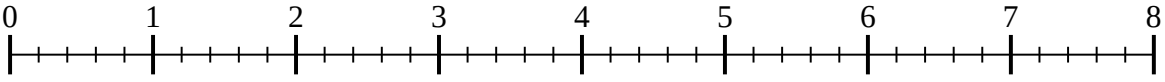

7) $7 \div {}^{1}/_{6}$

8) $4 \div {}^{1}/_{4}$

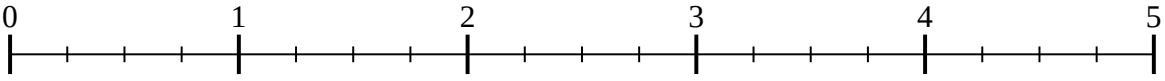

9) $4 \div {}^{1}/_{5}$

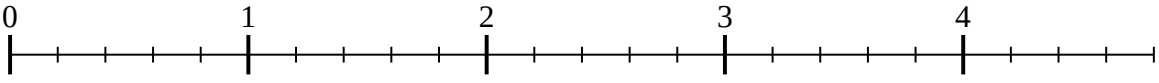

Réponses

1. _____
2. _____
3. _____
4. _____
5. _____
6. _____
7. _____
8. _____
9. _____

1-9	89	78	67	56	44	33	22	11	0