Diviser avec une Droite Numérique

Nom:

Utilisez la droite numérique pour résoudre chaque problème. Le premier est résolu.

1) $7 \div \frac{1}{3}$

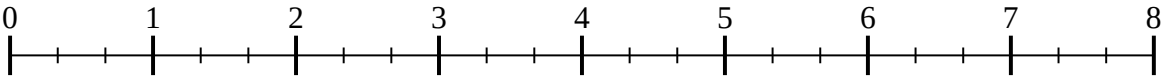

2) $2 \div \frac{1}{6}$

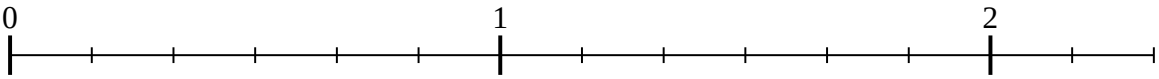

3) $5 \div \frac{1}{5}$

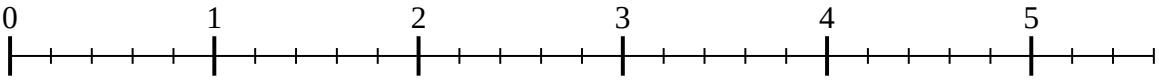

4) $7 \div \frac{1}{4}$

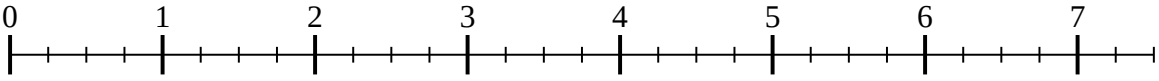

5) $5 \div \frac{1}{3}$

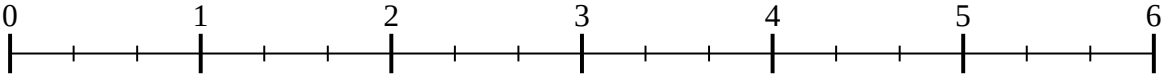

6) $4 \div \frac{1}{5}$

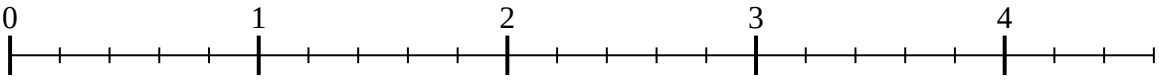

7) $3 \div \frac{1}{5}$

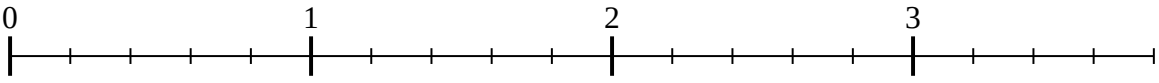

8) $2 \div \frac{1}{4}$



9) $3 \div \frac{1}{6}$

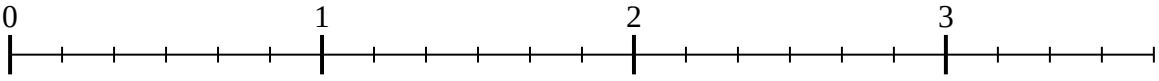

Réponses

1. _____
2. _____
3. _____
4. _____
5. _____
6. _____
7. _____
8. _____
9. _____

1-9	89	78	67	56	44	33	22	11	0

Diviser avec une Droite Numérique Nom: **Clé**

Utilisez la droite numérique pour résoudre chaque problème. Le premier est résolu.

1) $7 \div \frac{1}{3}$

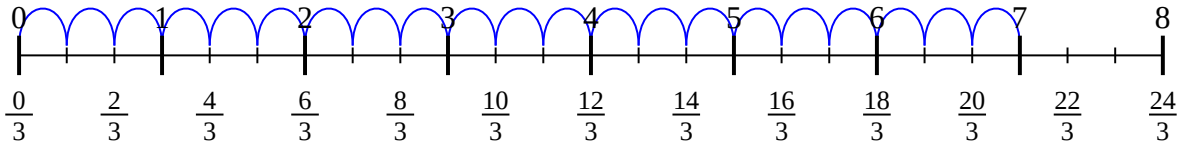

2) $2 \div \frac{1}{6}$

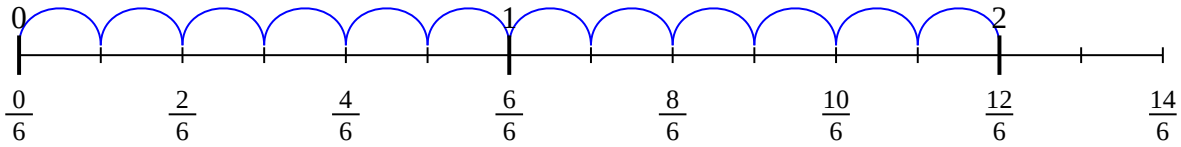

3) $5 \div \frac{1}{5}$

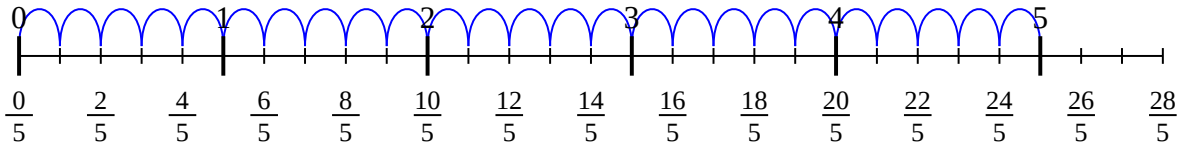

4) $7 \div \frac{1}{4}$

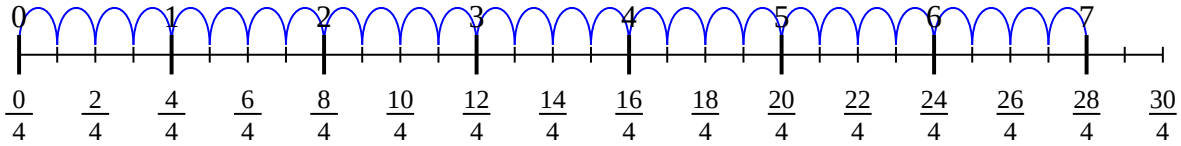

5) $5 \div \frac{1}{3}$

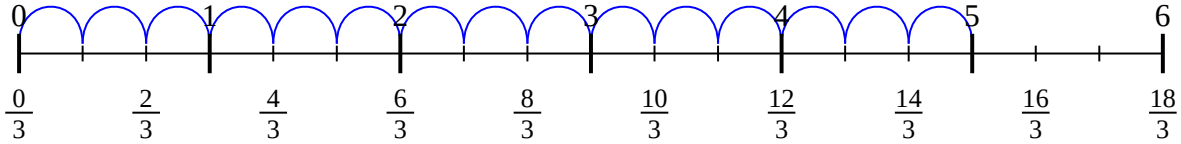

6) $4 \div \frac{1}{5}$

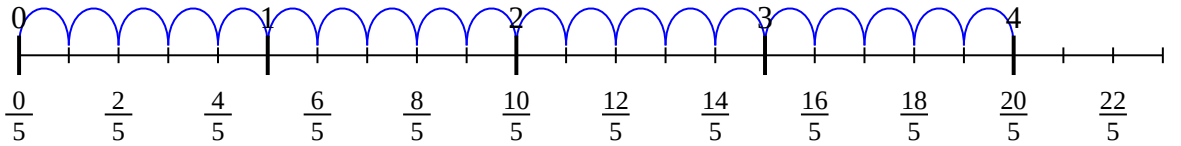

7) $3 \div \frac{1}{5}$

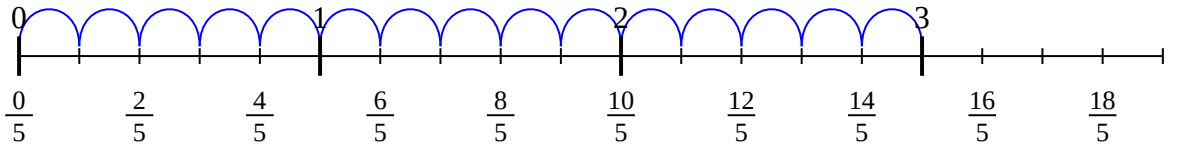

8) $2 \div \frac{1}{4}$

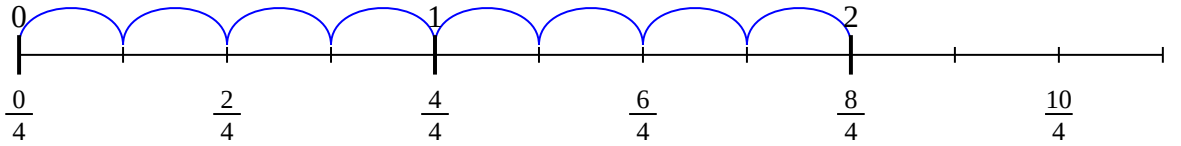

9) $3 \div \frac{1}{6}$

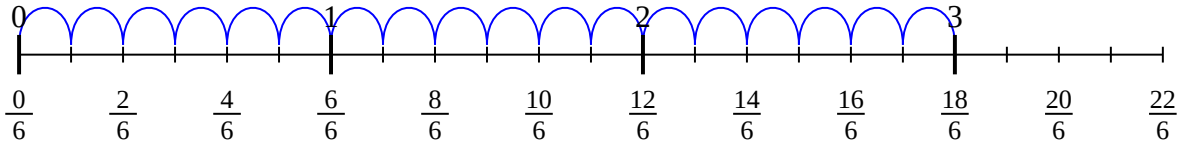

Réponses

1. 21/1
2. 12/1
3. 25/1
4. 28/1
5. 15/1
6. 20/1
7. 15/1
8. 8/1
9. 18/1

1-9	89	78	67	56	44	33	22	11	0

Diviser avec une Droite Numérique

Nom:

Utilisez la droite numérique pour résoudre chaque problème. Le premier est résolu.

$^{15}/_{1}$	$^{18}/_{1}$	$^{15}/_{1}$	$^{8}/_{1}$
$^{25}/_{1}$	$^{28}/_{1}$	$^{21}/_{1}$	$^{12}/_{1}$
$^{20}/_{1}$			

1) $7 \div {}^{1}/_{3}$

2) $2 \div {}^{1}/_{6}$

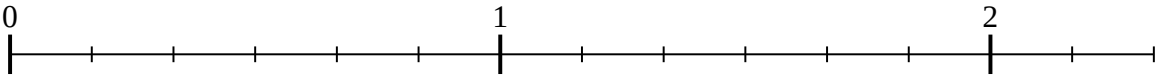

3) $5 \div {}^{1}/_{5}$

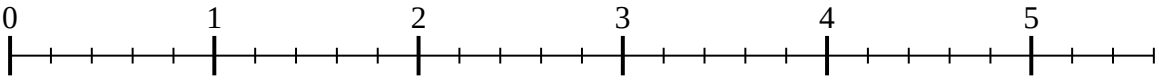

4) $7 \div {}^{1}/_{4}$

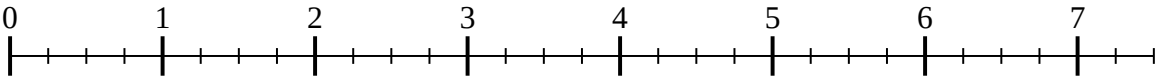

5) $5 \div {}^{1}/_{3}$

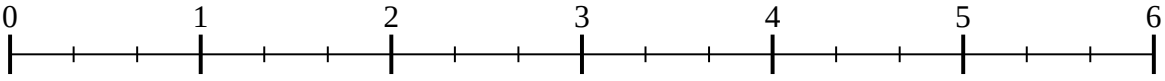

6) $4 \div {}^{1}/_{5}$

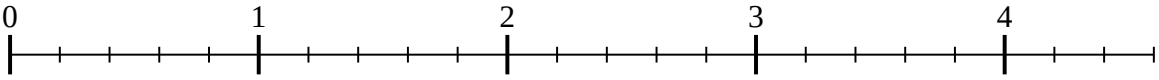

7) $3 \div {}^{1}/_{5}$

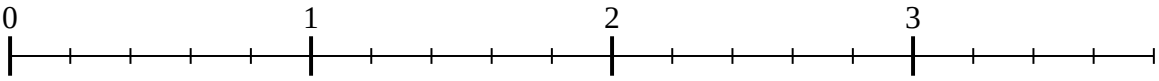

8) $2 \div {}^{1}/_{4}$

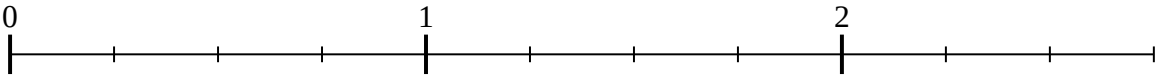

9) $3 \div {}^{1}/_{6}$

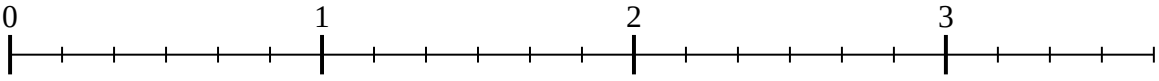

Réponses

1. _____
2. _____
3. _____
4. _____
5. _____
6. _____
7. _____
8. _____
9. _____

1-9	89	78	67	56	44	33	22	11	0