Exprimer des Inégalités sur une Droite Numérique

Nom:

Utilisez la droite numérique pour exprimer l'inégalité.

Ex) $X > -110$

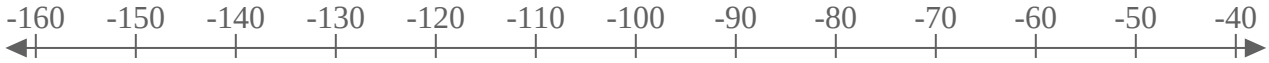

1) $X < 20$

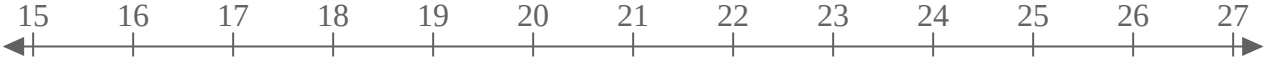

2) $X \geq -96$

3) $X \leq -100$

4) $X > -30$

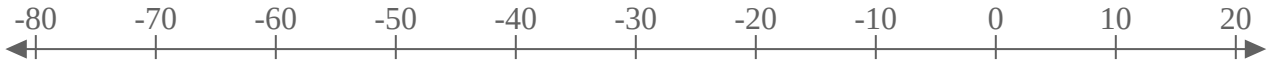

5) $X \geq 183$

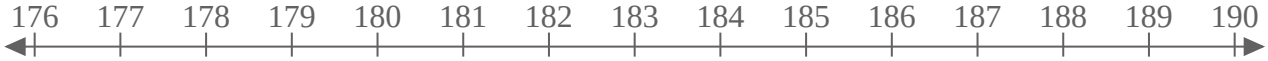

6) $X < 31$

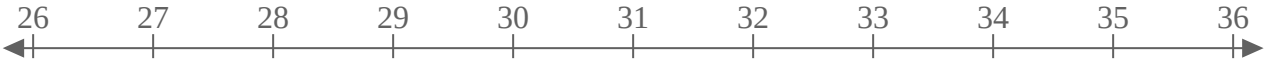

7) $X \leq -184$

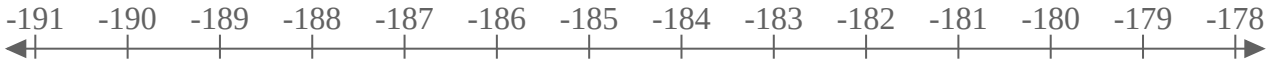

8) $X < -33$

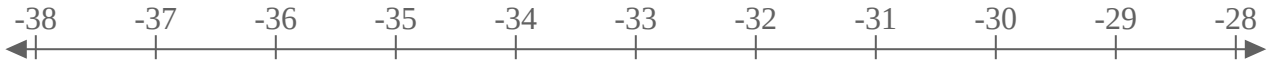

9) $X > 170$



10) $X \leq 110$

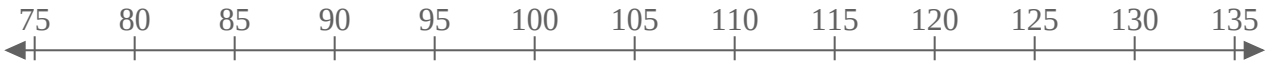

11) $X < -167$

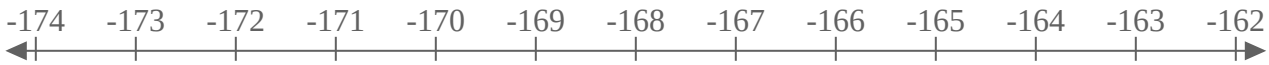

12) $X > -170$

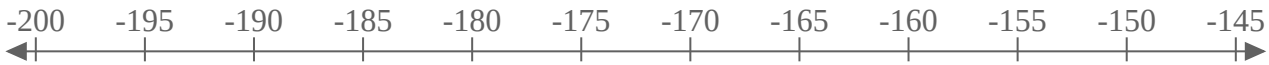

13) $X \leq 50$

1-10	92	85	77	69	62	54	46	38	31	23
11-13	15	8	0							

Exprimer des Inégalités sur une Droite Numérique Nom: **Clé**

Utilisez la droite numérique pour exprimer l'inégalité.

Ex) X > -110

1) X < 20

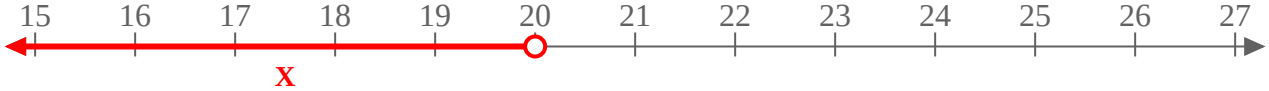

2) X ≥ -96

3) X ≤ -100

4) X > -30

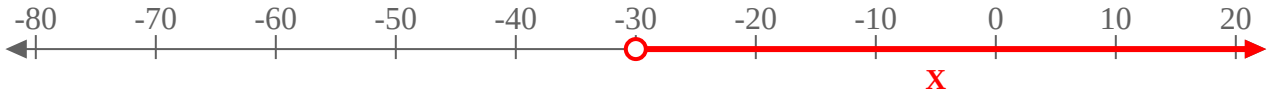

5) X ≥ 183

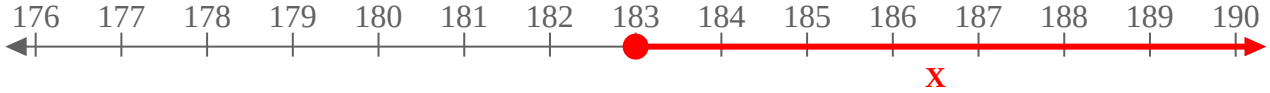

6) X < 31

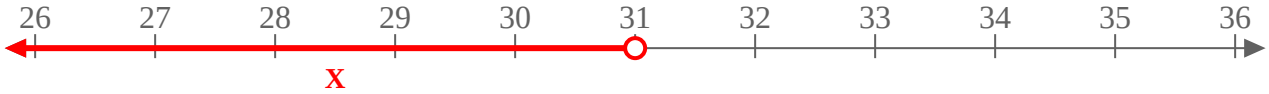

7) X ≤ -184

8) X < -33

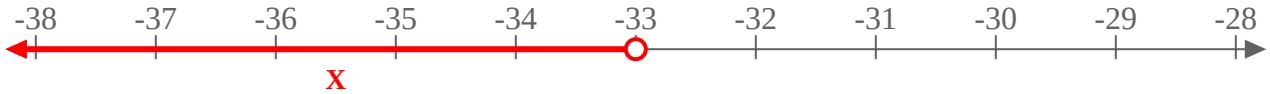

9) X > 170

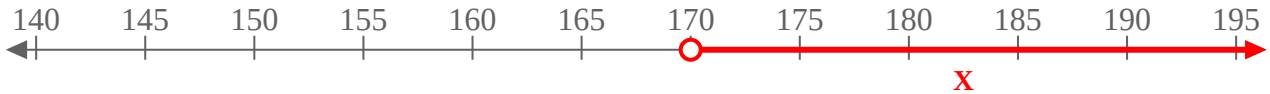

10) X ≤ 110

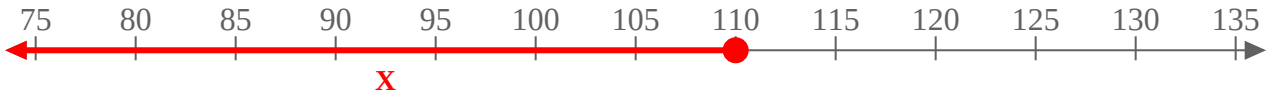

11) X < -167

12) X > -170

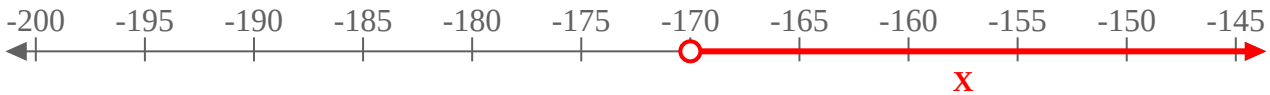

13) X ≤ 50

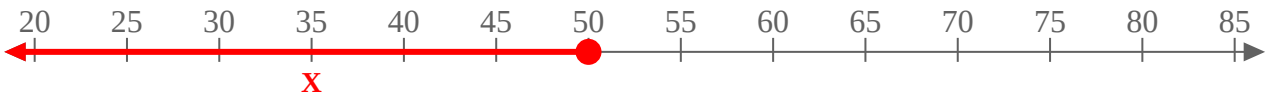

1-10	92	85	77	69	62	54	46	38	31	23
11-13	15	8	0							