Exprimer des Inégalités sur une Droite Numérique

Nom:

Utilisez la droite numérique pour exprimer l'inégalité.

Ex) $X \geq 50$

1) $X > 150$

2) $X \leq -65$

3) $X \geq 60$

4) $X > 120$



5) $X < -123$

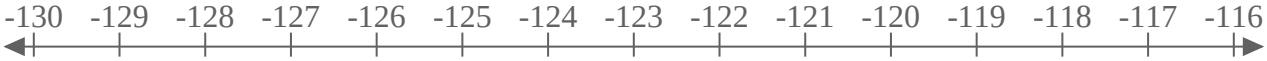

6) $X < -110$

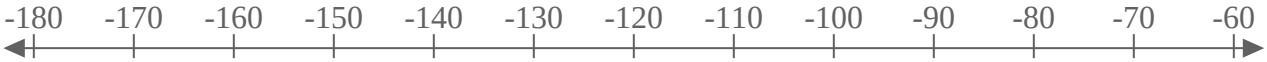

7) $X \leq 0$



8) $X < 40$

9) $X > 141$



10) $X < 190$

11) $X > -5$

12) $X \geq 178$

13) $X \leq 97$

1-10	92	85	77	69	62	54	46	38	31	23
11-13	15	8	0							

Exprimer des Inégalités sur une Droite Numérique Nom: **Clé**

Utilisez la droite numérique pour exprimer l'inégalité.

Ex) $X \geq 50$

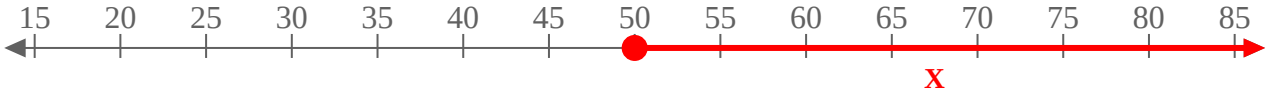

1) $X > 150$

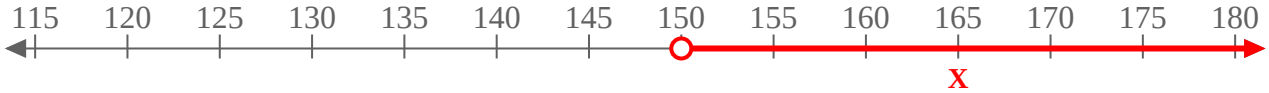

2) $X \leq -65$

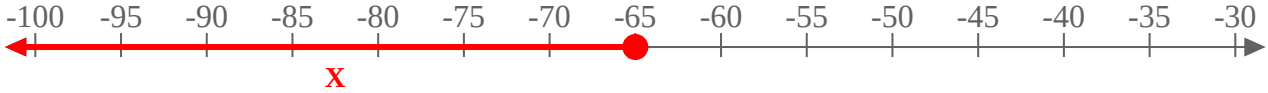

3) $X \geq 60$

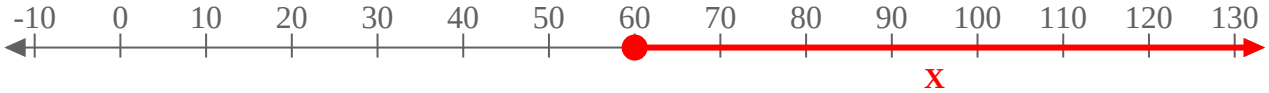

4) $X > 120$

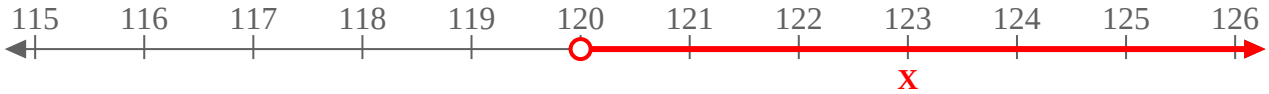

5) $X < -123$

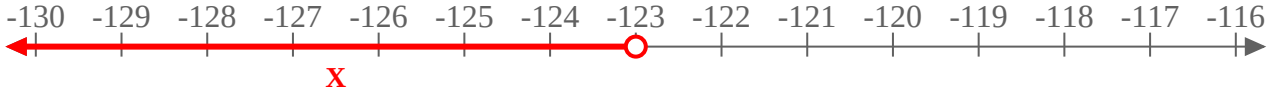

6) $X < -110$

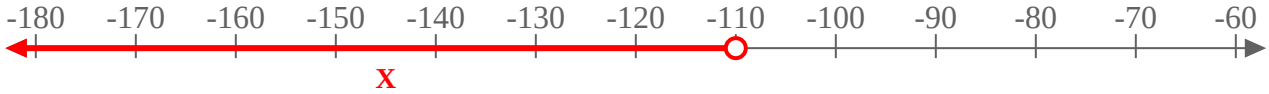

7) $X \leq 0$

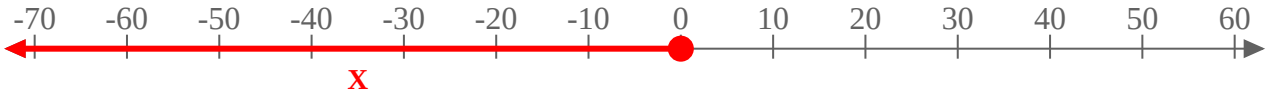

8) $X < 40$

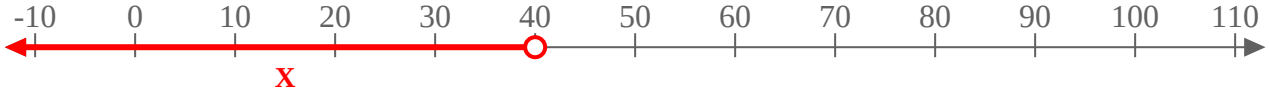

9) $X > 141$

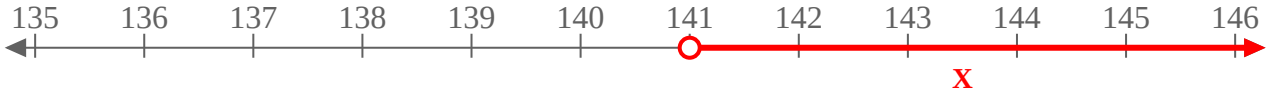

10) $X < 190$

11) $X > -5$

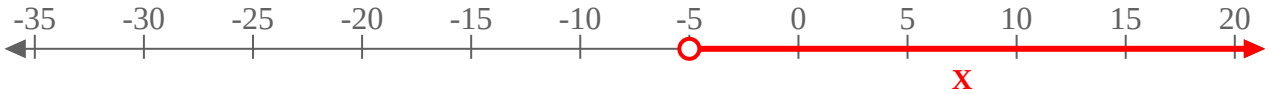

12) $X \geq 178$

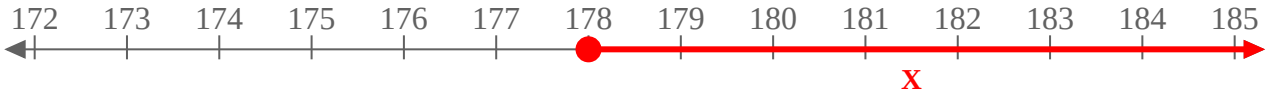

13) $X \leq 97$

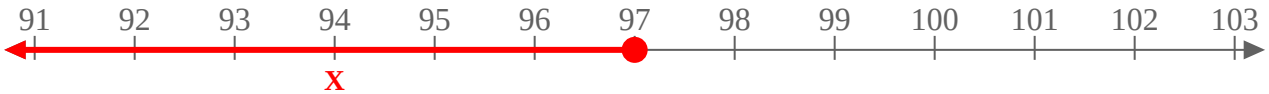

1-10	92	85	77	69	62	54	46	38	31	23
11-13	15	8	0							