Compter la monnaie (à moins d'un dollar) Nom:

Déterminez le montant d'argent indiqué.

1) 

2)

3)

4)

5)

6)

7)

8) 

9)

10) 

Réponses

1. _____
2. _____
3. _____
4. _____
5. _____
6. _____
7. _____
8. _____
9. _____
10. _____

1-10	90	80	70	60	50	40	30	20	10	0

Compter la monnaie (à moins d'un dollar) Nom: **Clé**

Déterminez le montant d'argent indiqué.

1) 

2)

3)

4)

5)

6)

7)

8) 

9)

10) 

Réponses

1. **$0,81**
2. **$0,95**
3. **$0,98**
4. **$0,99**
5. **$0,96**
6. **$0,92**
7. **$0,98**
8. **$0,99**
9. **$0,98**
10. **$0,68**

1-10	90	80	70	60	50	40	30	20	10	0