Multiplication avec Droites Numériques

Nom:

A l'aide de la droite numérique résoudre chaque problème.

1) $3 \times 3 =$

$3 \times 3 =$

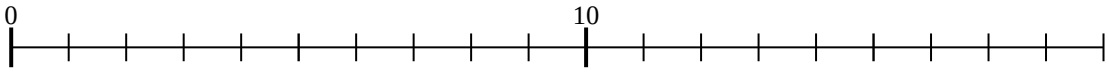

2) $2 \times 5 =$

$5 \times 2 =$

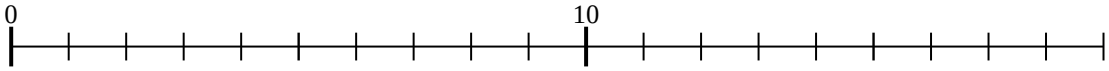

3) $4 \times 8 =$

$8 \times 4 =$

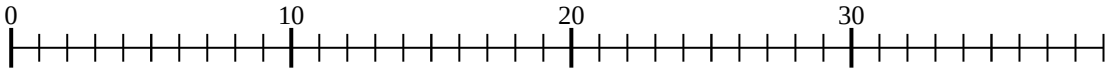

4) $4 \times 2 =$

$2 \times 4 =$

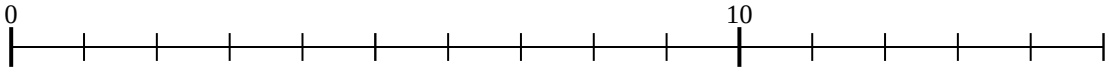

5) $4 \times 6 =$

$6 \times 4 =$

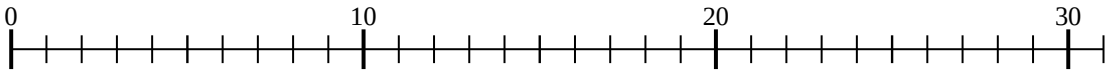

6) $3 \times 7 =$

$7 \times 3 =$

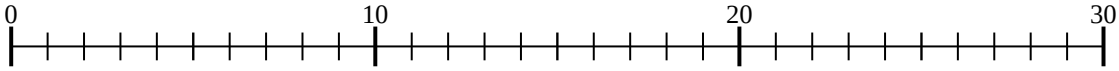

7) $2 \times 2 =$

$2 \times 2 =$

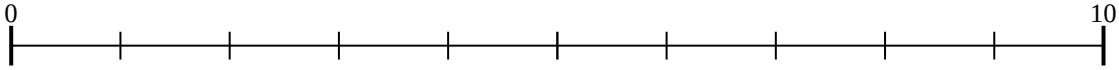

8) $5 \times 6 =$

$6 \times 5 =$

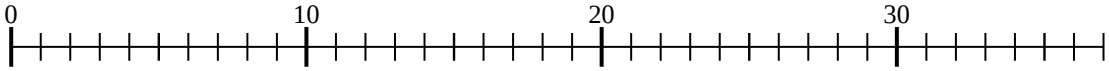

9) $5 \times 4 =$

$4 \times 5 =$

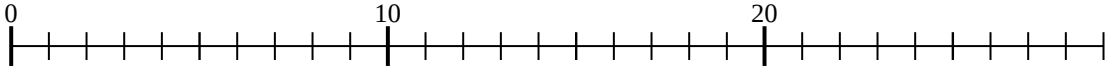

10) $5 \times 3 =$

$3 \times 5 =$

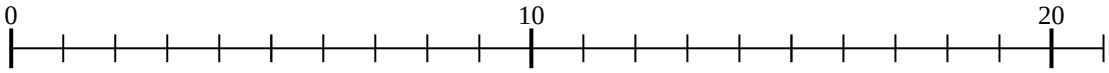

11) $3 \times 4 =$

$4 \times 3 =$

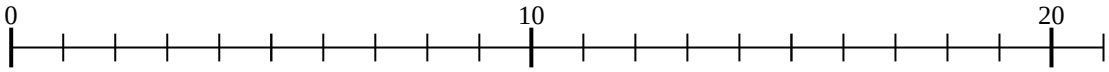

Réponses

1. _____
2. _____
3. _____
4. _____
5. _____
6. _____
7. _____
8. _____
9. _____
10. _____
11. _____

1-10	91	82	73	64	55	45	36	27	18	9
11	0									

Multiplication avec Droites Numériques Nom: **Clé**

A l'aide de la droite numérique résoudre chaque problème.

1) 3 × 3 =
3 × 3 =

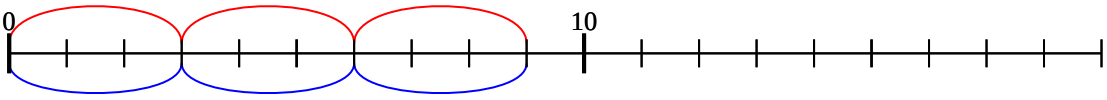

2) 2 × 5 =
5 × 2 =

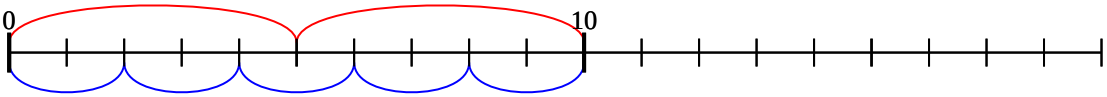

3) 4 × 8 =
8 × 4 =

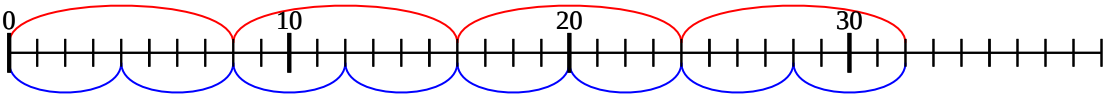

4) 4 × 2 =
2 × 4 =

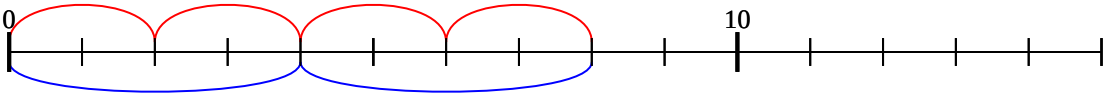

5) 4 × 6 =
6 × 4 =

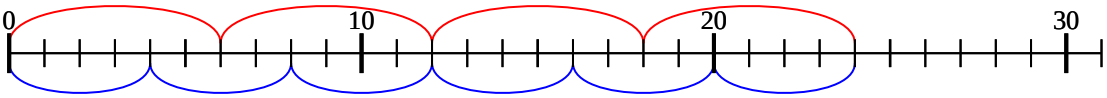

6) 3 × 7 =
7 × 3 =

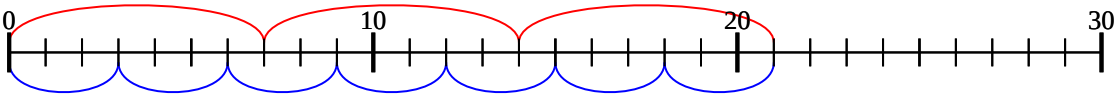

7) 2 × 2 =
2 × 2 =

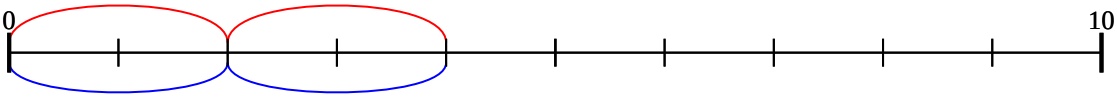

8) 5 × 6 =
6 × 5 =

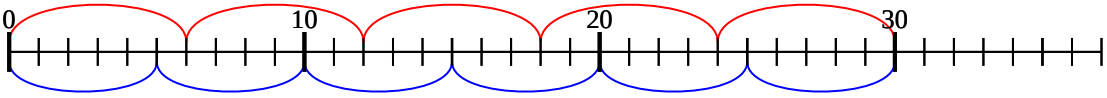

9) 5 × 4 =
4 × 5 =

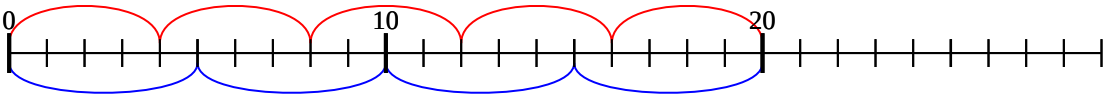

10) 5 × 3 =
3 × 5 =

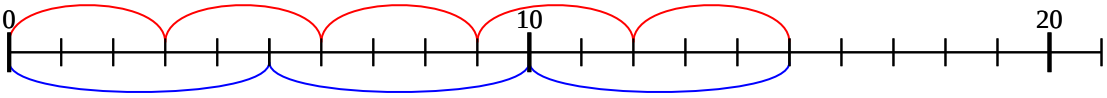

11) 3 × 4 =
4 × 3 =

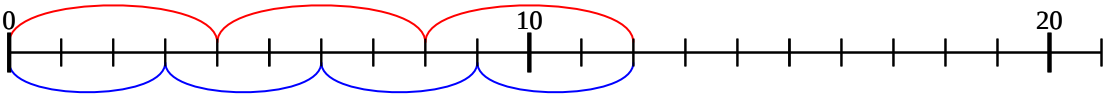

Réponses

1. **9**
2. **10**
3. **32**
4. **8**
5. **24**
6. **21**
7. **4**
8. **30**
9. **20**
10. **15**
11. **12**

1-10	91	82	73	64	55	45	36	27	18	9
11	0									