Multiplication avec Droites Numériques

Nom:

A l'aide de la droite numérique résoudre chaque problème.

1) 5 × 10 =

10 × 5 =

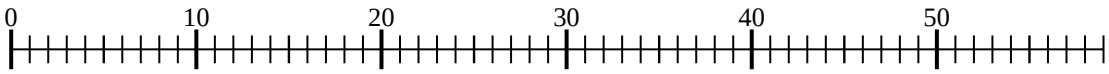

2) 4 × 4 =

4 × 4 =

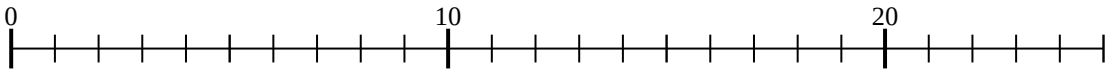

3) 2 × 7 =

7 × 2 =

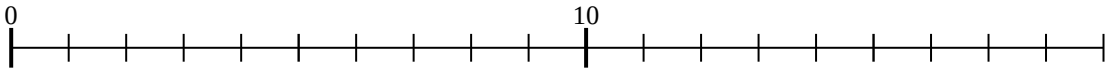

4) 4 × 7 =

7 × 4 =

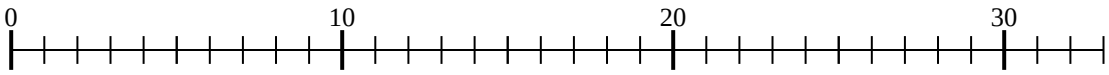

5) 5 × 4 =

4 × 5 =

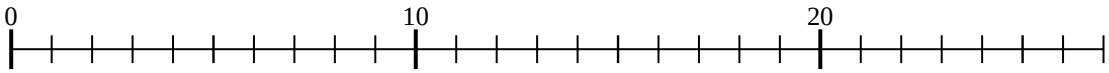

6) 5 × 9 =

9 × 5 =

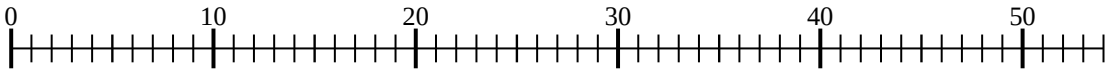

7) 2 × 10 =

10 × 2 =

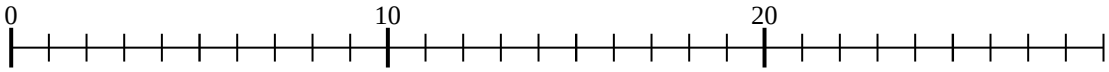

8) 2 × 8 =

8 × 2 =

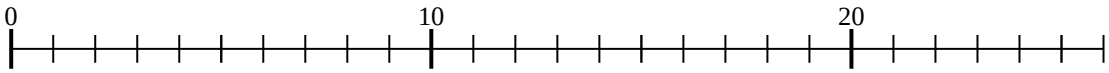

9) 5 × 3 =

3 × 5 =

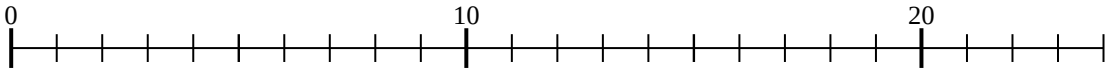

10) 3 × 5 =

5 × 3 =

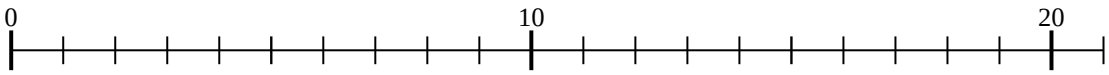

11) 4 × 9 =

9 × 4 =

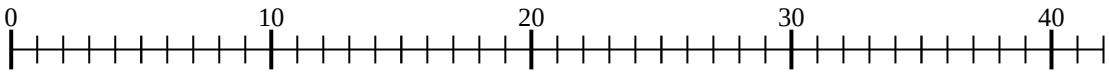

Réponses

1. _____
2. _____
3. _____
4. _____
5. _____
6. _____
7. _____
8. _____
9. _____
10. _____
11. _____

1-10	91	82	73	64	55	45	36	27	18	9
11	0									

Multiplication avec Droites Numériques Nom: **Clé**

A l'aide de la droite numérique résoudre chaque problème.

1) 5 × 10 =
10 × 5 =

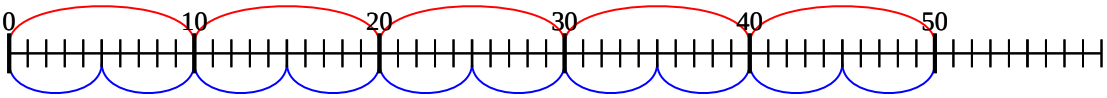

2) 4 × 4 =
4 × 4 =

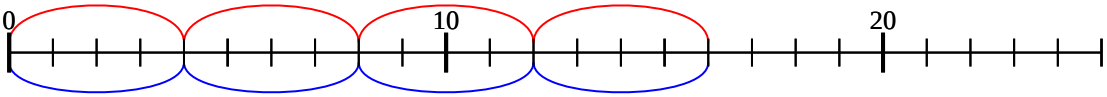

3) 2 × 7 =
7 × 2 =

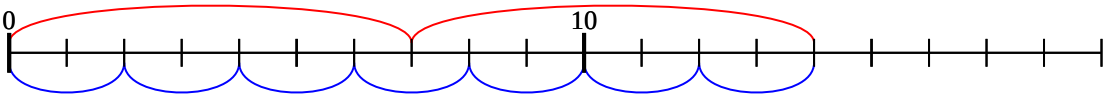

4) 4 × 7 =
7 × 4 =

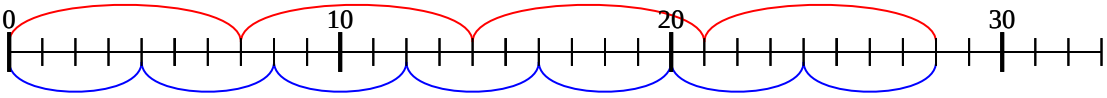

5) 5 × 4 =
4 × 5 =

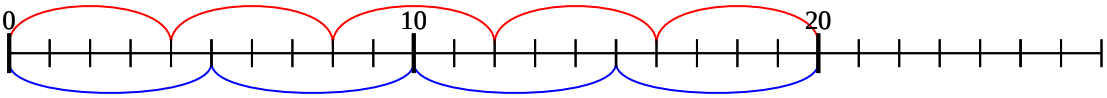

6) 5 × 9 =
9 × 5 =

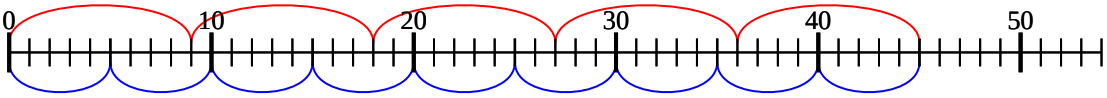

7) 2 × 10 =
10 × 2 =

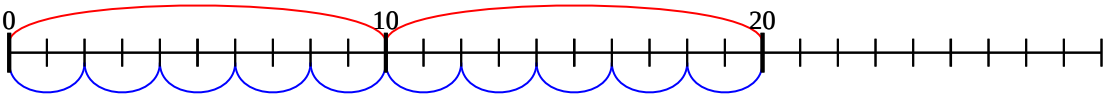

8) 2 × 8 =
8 × 2 =

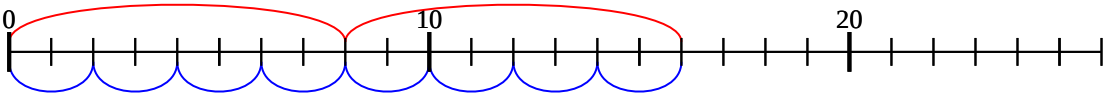

9) 5 × 3 =
3 × 5 =

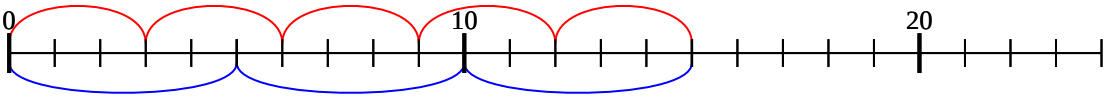

10) 3 × 5 =
5 × 3 =

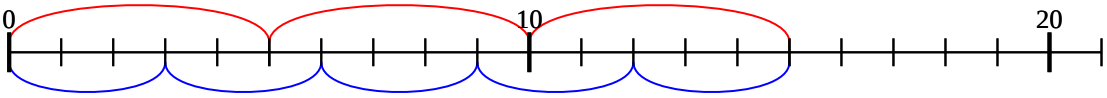

11) 4 × 9 =
9 × 4 =

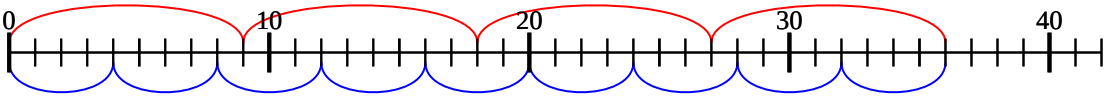

Réponses

1. **50**
2. **16**
3. **14**
4. **28**
5. **20**
6. **45**
7. **20**
8. **16**
9. **15**
10. **15**
11. **36**

1-10	91	82	73	64	55	45	36	27	18	9
11	0									