Réécriture de Multiplication (Visuelle)

Nom:

Interpréter chaque figure en multiplication.

Ex) 

1)

2) 

3)

4) 

5) 

6) 

7) 

8) 

9)

10) 

11)

Réponses

Ex. 7 × 7 = 49

1. _____
2. _____
3. _____
4. _____
5. _____
6. _____
7. _____
8. _____
9. _____
10. _____
11. _____

1-10	91	82	73	64	55	45	36	27	18	9
11	0									

Réécriture de Multiplication (Visuelle)

Nom: **Clé**

Interpréter chaque figure en multiplication.

Ex)



1)

2)



3)

4)



5)



6)



7)



8)



9)

10)



11)

Réponses

Ex. **7 × 7 = 49**

1. **8 × 6 = 48**
2. **6 × 8 = 48**
3. **5 × 2 = 10**
4. **10 × 8 = 80**
5. **8 × 2 = 16**
6. **9 × 10 = 90**
7. **3 × 8 = 24**
8. **8 × 9 = 72**
9. **3 × 9 = 27**
10. **9 × 9 = 81**
11. **6 × 4 = 24**

1-10	91	82	73	64	55	45	36	27	18	9
11	0									