Réécriture de Multiplication (Visuelle)

Nom:

Interpréter chaque figure en multiplication.

Ex)

1)



2)



3)



4)



5)



6)



7)



8)



9)

10)

11)

Réponses

Ex. 7 × 5 = 35

1. _____
2. _____
3. _____
4. _____
5. _____
6. _____
7. _____
8. _____
9. _____
10. _____
11. _____

Réécriture de Multiplication (Visuelle)

Nom: **Clé**

Interpréter chaque figure en multiplication.

Ex)

1)



2)



3)



4)



5)



6)



7)



8)



9)

10)

11)

Réponses

Ex. **7 × 5 = 35**

1. **5 × 5 = 25**
2. **10 × 9 = 90**
3. **6 × 7 = 42**
4. **2 × 6 = 12**
5. **2 × 7 = 14**
6. **10 × 4 = 40**
7. **4 × 4 = 16**
8. **6 × 5 = 30**
9. **3 × 8 = 24**
10. **3 × 7 = 21**
11. **5 × 3 = 15**