Machine à Fonctions (Addition & Soustraction) Nom:

Déterminez la règle appliquée à chaque machine à fonctions.

1) 14 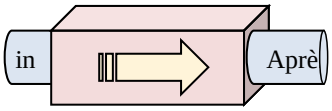

44

A. Ajouter 27
B. Ajouter 30
C. Ajouter 25
D. Soustraire 32

2) 11 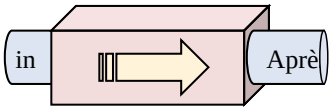

19

A. Ajouter 8
B. Ajouter 6
C. Soustraire 3
D. Ajouter 4

3) 18 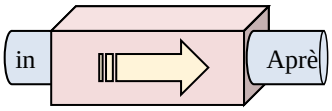

48

A. Soustraire 25
B. Ajouter 30
C. Ajouter 29
D. Ajouter 34

4) 9 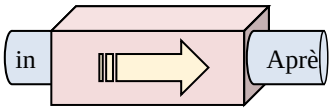

35

A. Ajouter 28
B. Ajouter 26
C. Soustraire 30
D. Soustraire 22

5) 16 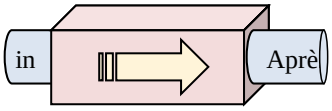

38

A. Ajouter 22
B. Ajouter 27
C. Ajouter 24
D. Soustraire 17

6) 39 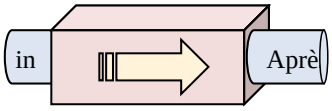

18

A. Soustraire 20
B. Soustraire 23
C. Soustraire 16
D. Soustraire 21

7) 35 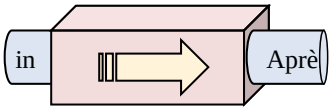

17

A. Soustraire 17
B. Ajouter 21
C. Soustraire 14
D. Soustraire 18

8) 22 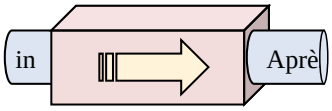

17

A. Soustraire 10
B. Ajouter 2
C. Soustraire 6
D. Soustraire 5

9) 24 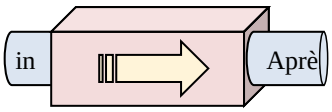

36

A. Soustraire 17
B. Soustraire 12
C. Ajouter 12
D. Ajouter 9

10) 43 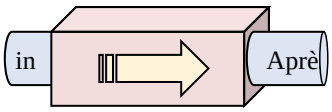

25

A. Ajouter 15
B. Soustraire 16
C. Ajouter 13
D. Soustraire 18

Réponses

1. _____
2. _____
3. _____
4. _____
5. _____
6. _____
7. _____
8. _____
9. _____
10. _____

1-10	90	80	70	60	50	40	30	20	10	0

Machine à Fonctions (Addition & Soustraction) Nom: **Clé**

Déterminez la règle appliquée à chaque machine à fonctions.

1) 14 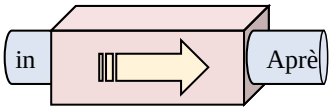

44

A. Ajouter 27
B. Ajouter 30
C. Ajouter 25
D. Soustraire 32

2) 11 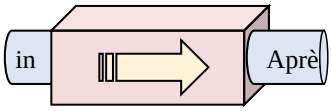

19

A. Ajouter 8
B. Ajouter 6
C. Soustraire 3
D. Ajouter 4

3) 18 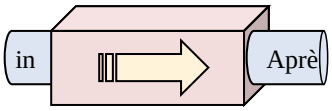

48

A. Soustraire 25
B. Ajouter 30
C. Ajouter 29
D. Ajouter 34

4) 9 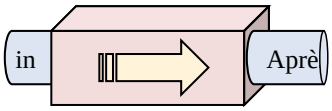

35

A. Ajouter 28
B. Ajouter 26
C. Soustraire 30
D. Soustraire 22

5) 16 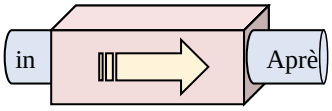

38

A. Ajouter 22
B. Ajouter 27
C. Ajouter 24
D. Soustraire 17

6) 39 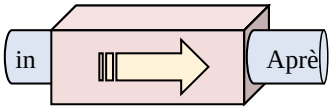

18

A. Soustraire 20
B. Soustraire 23
C. Soustraire 16
D. Soustraire 21

7) 35 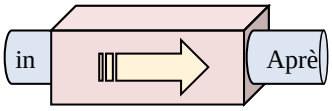

17

A. Soustraire 17
B. Ajouter 21
C. Soustraire 14
D. Soustraire 18

8) 22 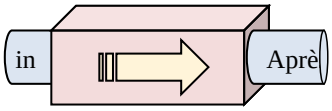

17

A. Soustraire 10
B. Ajouter 2
C. Soustraire 6
D. Soustraire 5

9) 24 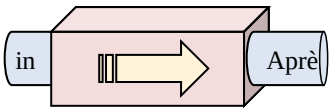

36

A. Soustraire 17
B. Soustraire 12
C. Ajouter 12
D. Ajouter 9

10) 43 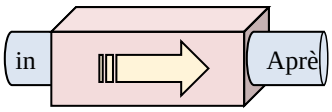

25

A. Ajouter 15
B. Soustraire 16
C. Ajouter 13
D. Soustraire 18

Réponses

1. B
2. A
3. B
4. B
5. A
6. D
7. D
8. D
9. C
10. D

1-10	90	80	70	60	50	40	30	20	10	0