Machines à Fonctions (Additions & Soustractions) Nom:

Déterminez la règle appliquée à chaque machine à fonctions.

Ex)

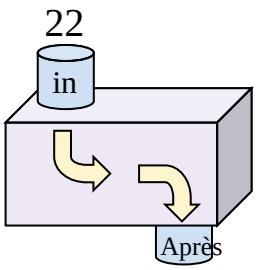

Ajouter 6

1)

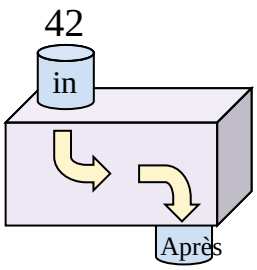

2)

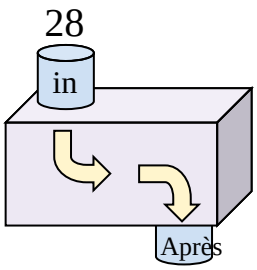

3)

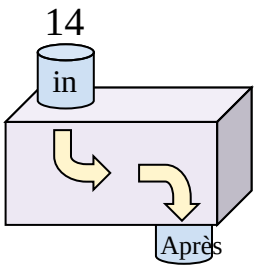

4)

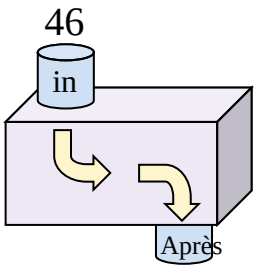

5)

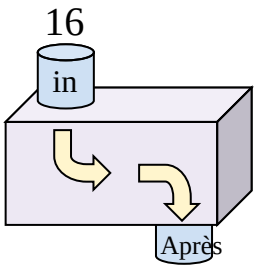

6)

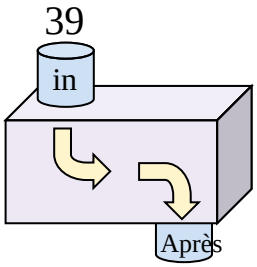

7)

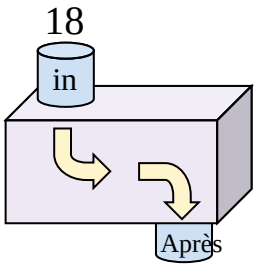

8)

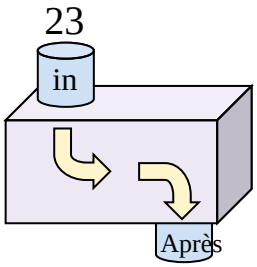

9)

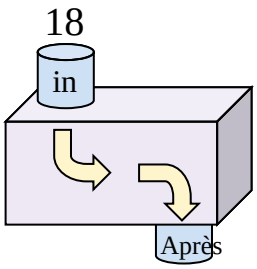

10)

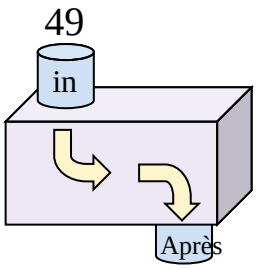

11)

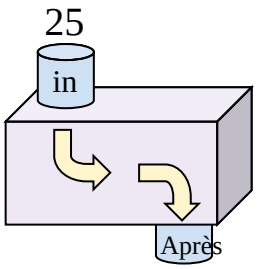

Réponses

Ex. Ajouter 6

1. _____
2. _____
3. _____
4. _____
5. _____
6. _____
7. _____
8. _____
9. _____
10. _____
11. _____

Machines à Fonctions (Additions & Soustractions) Nom: **Clé**

Déterminez la règle appliquée à chaque machine à fonctions.

Ex)

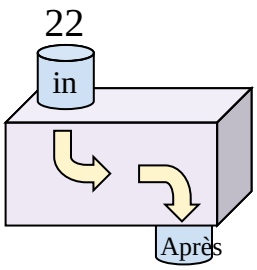

Ajouter 6

1)

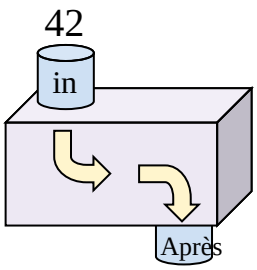

Soustraire 33

2)

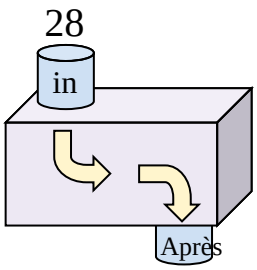

Soustraire 19

3)

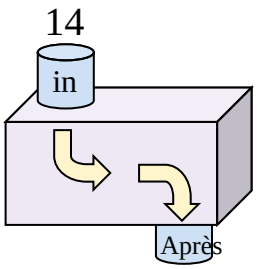

Soustraire 8

4)

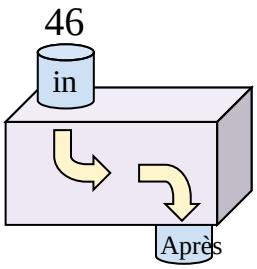

Soustraire 33

5)

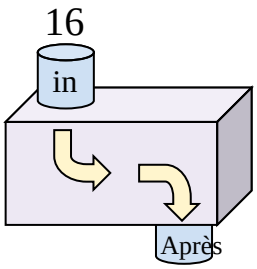

Ajouter 14

6)

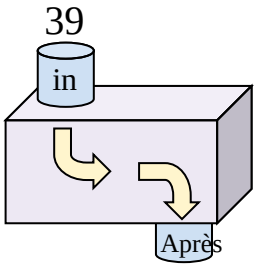

Soustraire 27

7)

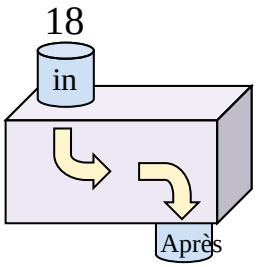

Ajouter 24

8)

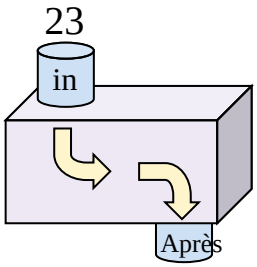

Soustraire 8

9)

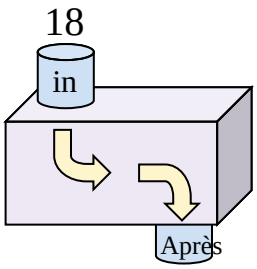

Ajouter 12

10)

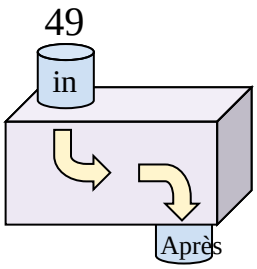

Soustraire 31

11)

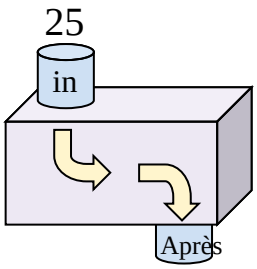

Ajouter 19

Réponses

Ex.	Ajouter 6
1.	Soustraire 33
2.	Soustraire 19
3.	Soustraire 8
4.	Soustraire 33
5.	Ajouter 14
6.	Soustraire 27
7.	Ajouter 24
8.	Soustraire 8
9.	Ajouter 12
10.	Soustraire 31
11.	Ajouter 19