**Déterminez ce que la valeur de A signifie dans chaque problème.**

**1)**

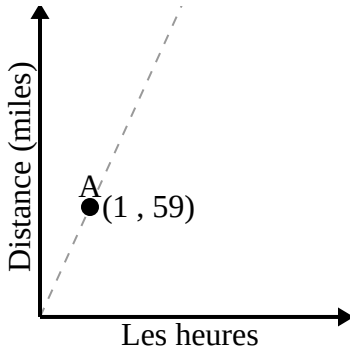


**2)**

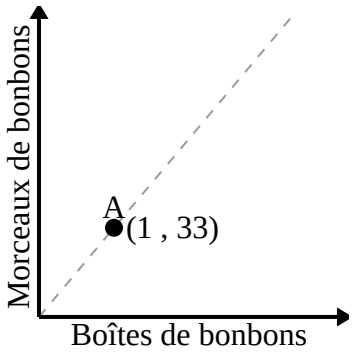


**3)**

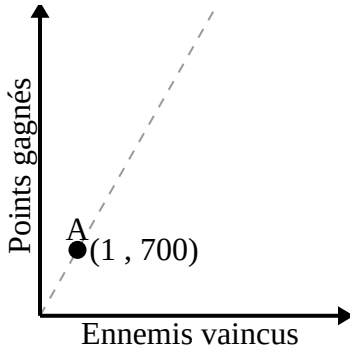


**4)**

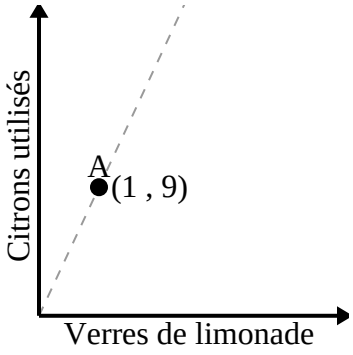


**5)**

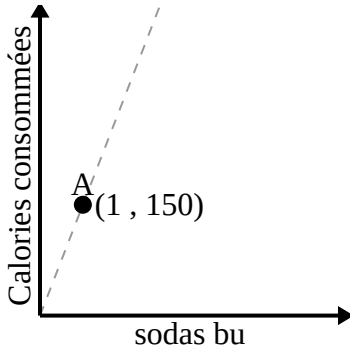


**6)**

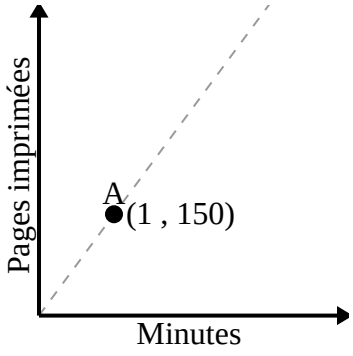




| 1-6 | 83 | 67 | 50 | 33 | 17 | 0 |
|---|---|---|---|---|---|---|

**Déterminez ce que la valeur de A signifie dans chaque problème.**

**1)**

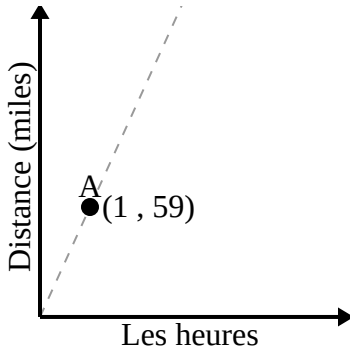


Toutes les heures, 59 miles sont parcourus.

**2)**

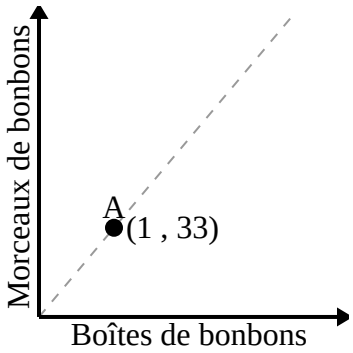


Chaque boîte de bonbons contient 33 morceaux de bonbons.

**3)**

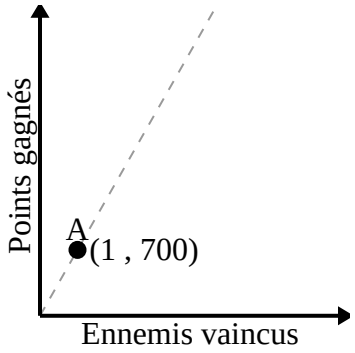


Pour chaque ennemi vaincu 700 points sont gagnés.

**4)**

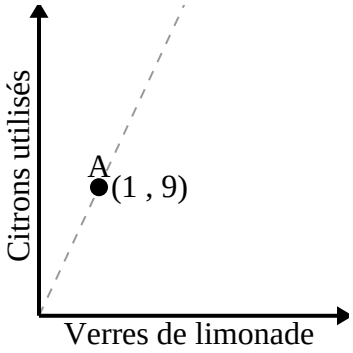


Chaque verre de limonade nécessite 9 citrons.

**5)**

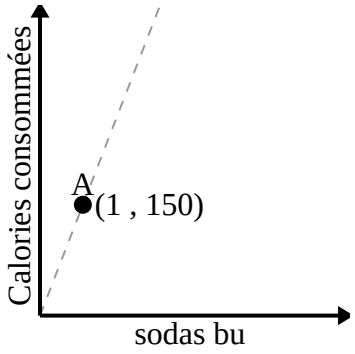


Pour chaque soda bu 150 calories sont consommées.

**6)**

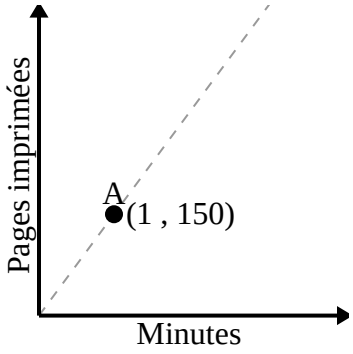


Chaque minute 150 pages sont imprimées.



| 1-6 | 83 | 67 | 50 | 33 | 17 | 0 |
|---|---|---|---|---|---|---|