Déterminez ce que la valeur de A signifie dans chaque problème.

1)

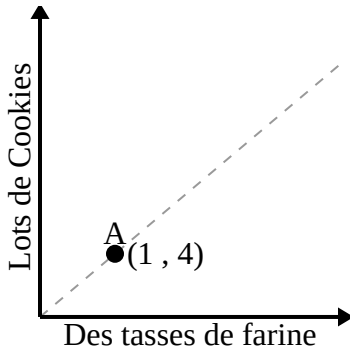

2)

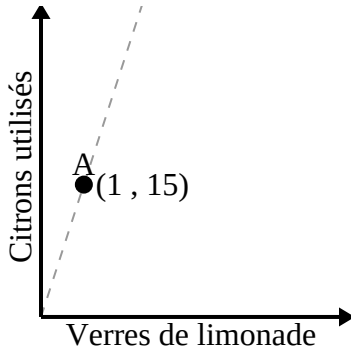

3)

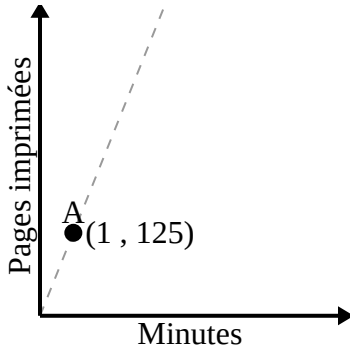

4)

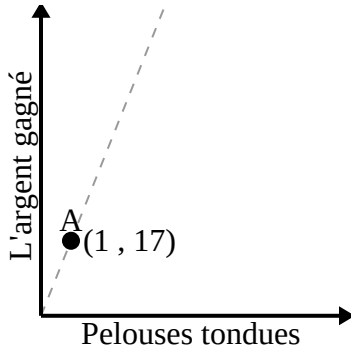

5)

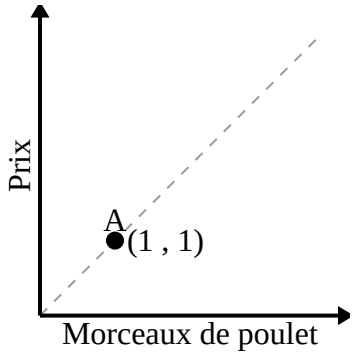

6)

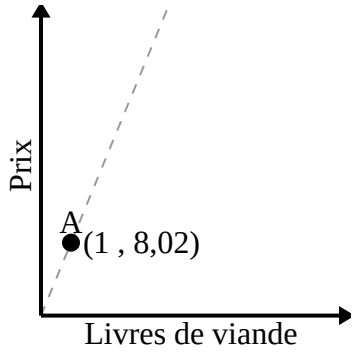

1-6	83	67	50	33	17	0

Déterminez ce que la valeur de A signifie dans chaque problème.

1)

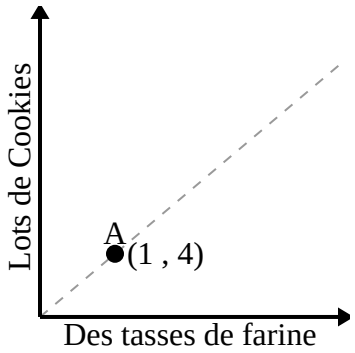

Pour chaque tasse de farine 4, des lots de biscuits peuvent être préparés.

2)

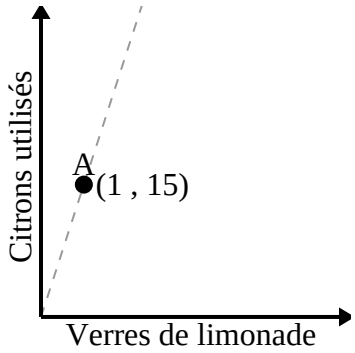

Chaque verre de limonade nécessite 15 citrons.

3)

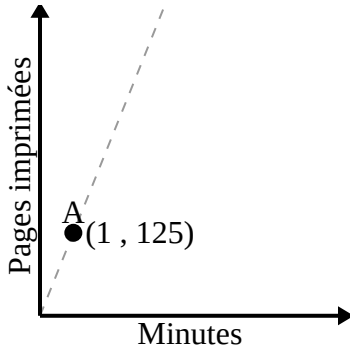

Chaque minute 125 pages sont imprimées.

4)

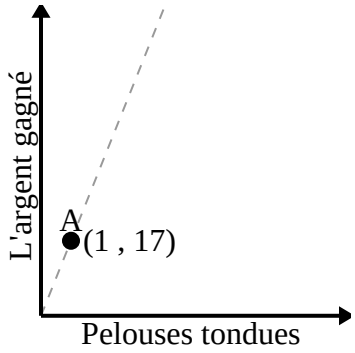

Pour chaque pelouse tondue, vous gagnez 17 $.

5)

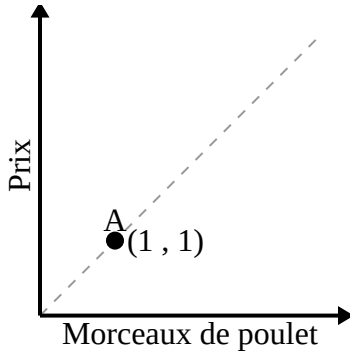

Chaque morceau de poulet coûte 1 $.

6)

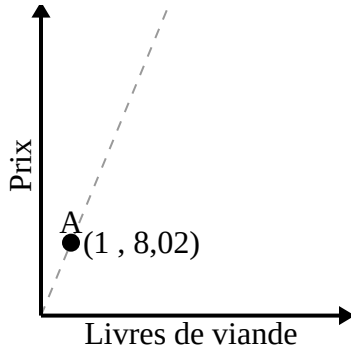

Chaque livre de viande coûte 8.02 $.

1-6	83	67	50	33	17	0