Déterminez ce que la valeur de A signifie dans chaque problème.

1)

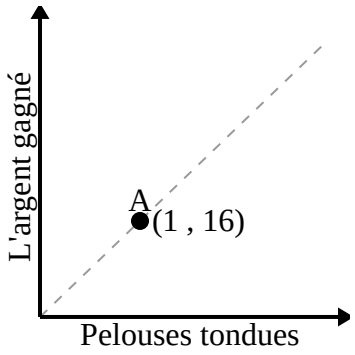

2)

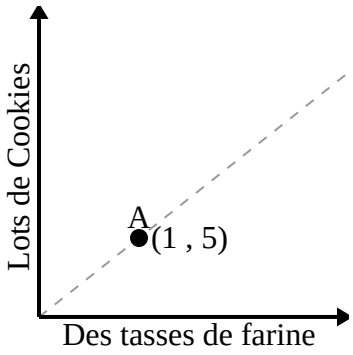

3)

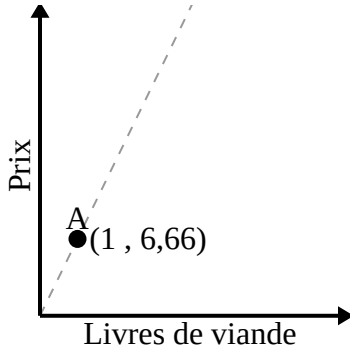

4)

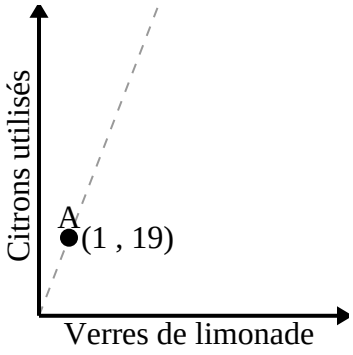

5)

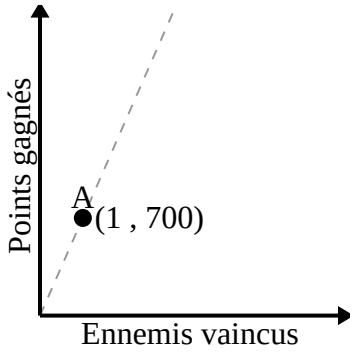

6)

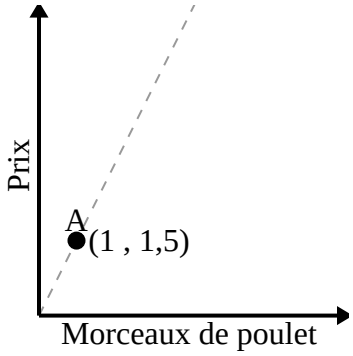

1-6	83	67	50	33	17	0

Déterminez ce que la valeur de A signifie dans chaque problème.

1)

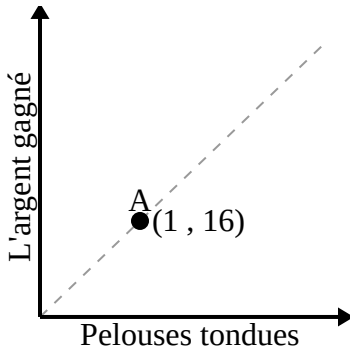

Pour chaque pelouse tondue, vous gagnez 16 $.

2)

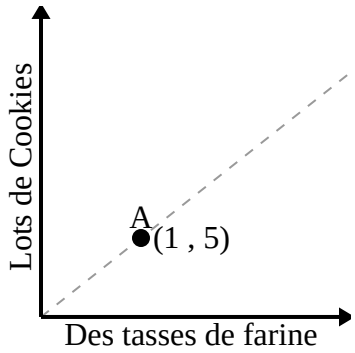

Pour chaque tasse de farine 5, des lots de biscuits peuvent être préparés.

3)

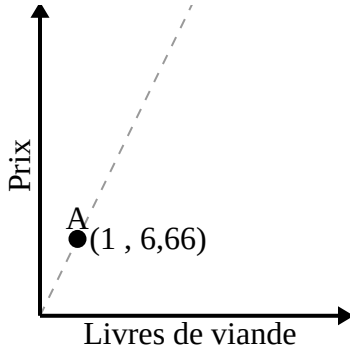

Chaque livre de viande coûte 6.66 $.

4)

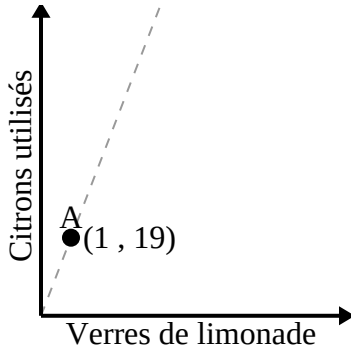

Chaque verre de limonade nécessite 19 citrons.

5)

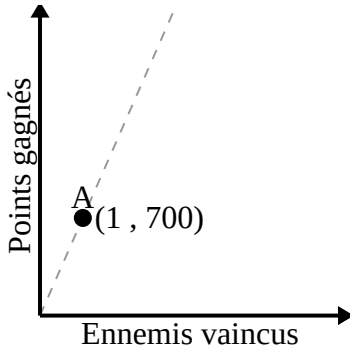

Pour chaque ennemi vaincu 700 points sont gagnés.

6)

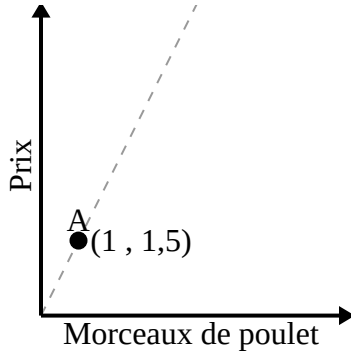

Chaque morceau de poulet coûte 1.5 $.

1-6	83	67	50	33	17	0