Classification des formes Nom:

Déterminer si la forme représentée est un Q uadrilateral, K ite, T rapezoid, P arallelogram, R h ombus, R ectangle ou S Quare (peut être plus d'un).

1)

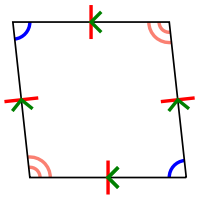

2)

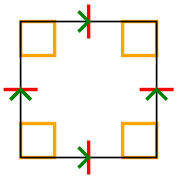

3)

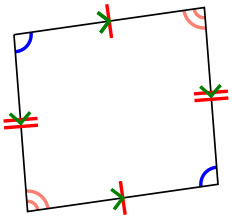

4)



5)

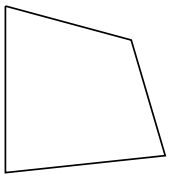

6)

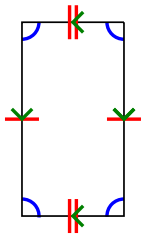

7)

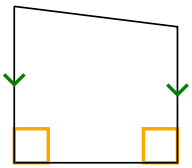

8)

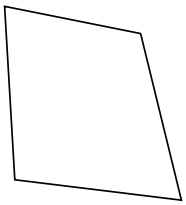

9)

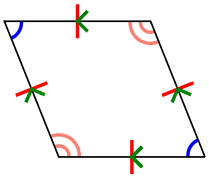

10)

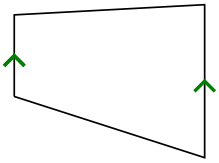

11)

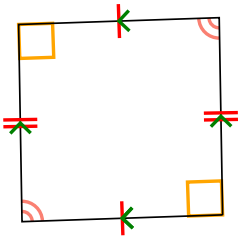

12)

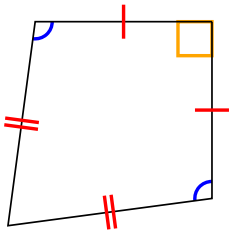

Réponses

1. _____
2. _____
3. _____
4. _____
5. _____
6. _____
7. _____
8. _____
9. _____
10. _____
11. _____
12. _____

1-10	92	83	75	67	58	50	42	33	25	17
11-12	8	0								

Classification des formes Nom: **Clé**

Déterminer si la forme représentée est un Q uadrilateral, K ite, T rapezoid, P arallelogram, R h ombus, R ectangle ou S Quare (peut être plus d'un).

1)

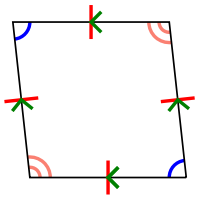

2)

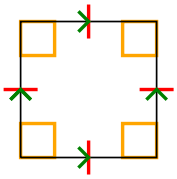

3)

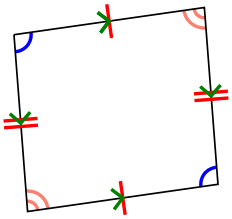

4)



5)

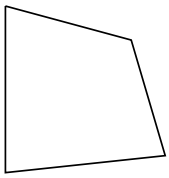

6)

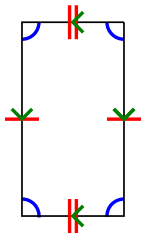

7)

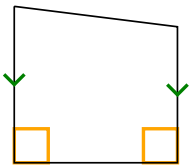

8)

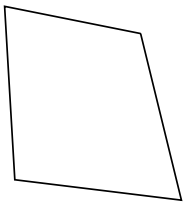

9)

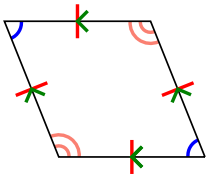

10)

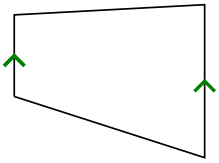

11)

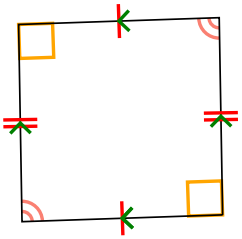

12)

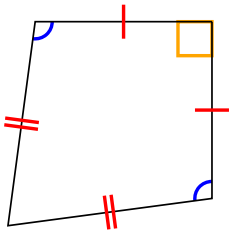

Réponses

1. Q,P,H
2. Q,P,H,R,S
3. Q,P
4. Q
5. Q
6. Q,P
7. Q,T
8. Q
9. Q,P,H
10. Q,T
11. Q,P
12. Q,K

1-10	92	83	75	67	58	50	42	33	25	17
11-12	8	0								