Identifier les triangles rectangles Nom:

Déterminez si la figure est un triangle rectangle (oui ou non).

1)

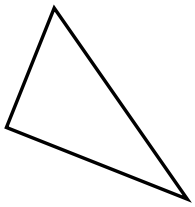

2)

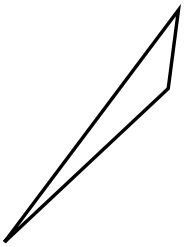

3)

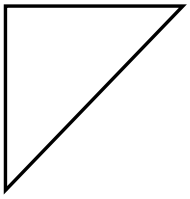

4)

5)

6)

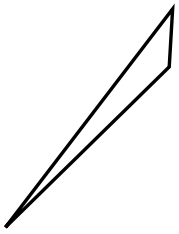

7)

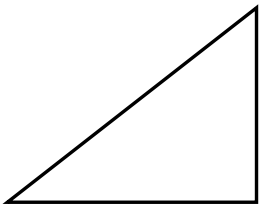

8)

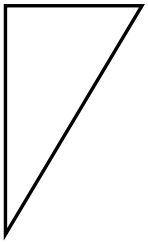

9)

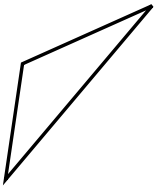

10)



11)

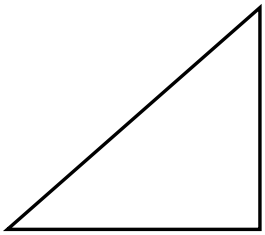

12)

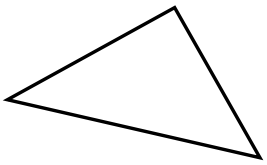

13)

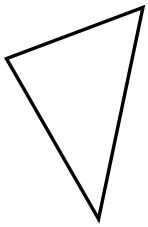

14)

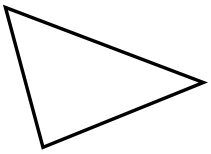

15)

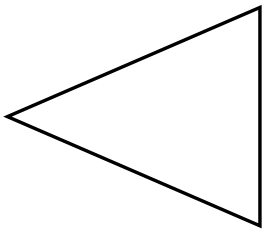

Réponses

1. _____
2. _____
3. _____
4. _____
5. _____
6. _____
7. _____
8. _____
9. _____
10. _____
11. _____
12. _____
13. _____
14. _____
15. _____

1-10	93	87	80	73	67	60	53	47	40	33
11-15	27	20	13	7	0					

Identifier les triangles rectangles Nom: **Clé**

Déterminez si la figure est un triangle rectangle (oui ou non).

1)
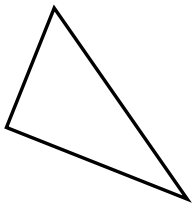

2)
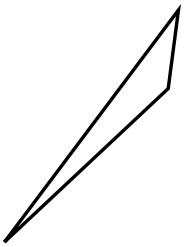

3)
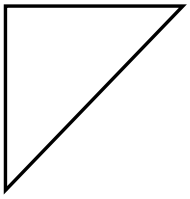

4)

5)

6)
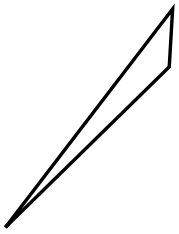

7)
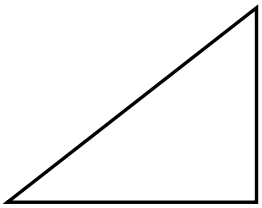

8)
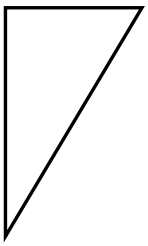

9)
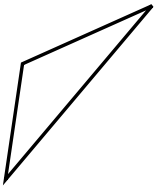

10)


11)
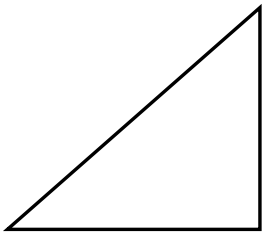

12)
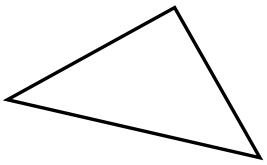

13)
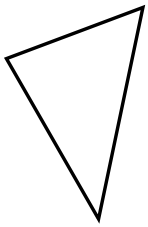

14)
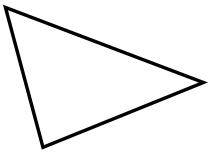

15)
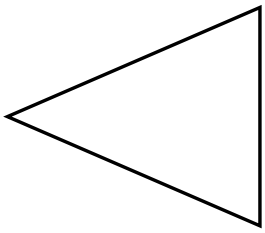

Réponses

1. oui
2. non
3. oui
4. oui
5. oui
6. non
7. oui
8. oui
9. non
10. non
11. oui
12. oui
13. non
14. non
15. non

1-10	93	87	80	73	67	60	53	47	40	33
11-15	27	20	13	7	0					