Déterminer la Symétrie

Nom:

Déterminez si la droite qui parcoure la figure est un axe de symétrie.

Ex)

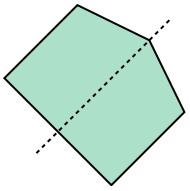

1)

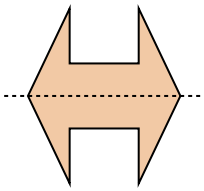

2)

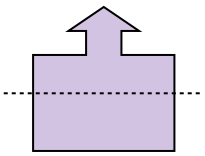

3)

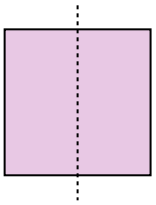

4)

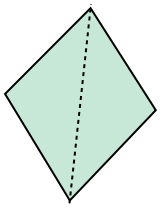

5)

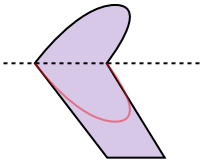

6)

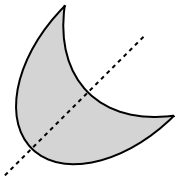

7)

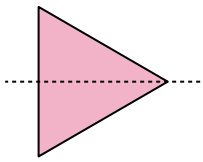

8)

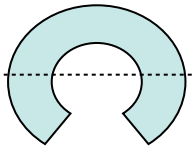

9)

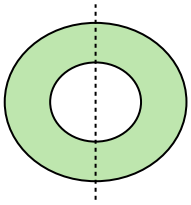

10)

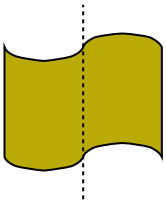

11)

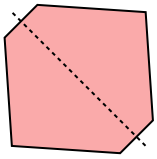

Réponses

Ex. oui

1. _____

2. _____

3. _____

4. _____

5. _____

6. _____

7. _____

8. _____

9. _____

10. _____

11. _____

1-10	91	82	73	64	55	45	36	27	18	9
11	0									

Déterminer la Symétrie

Nom: **Clé**

Déterminez si la droite qui parcoure la figure est un axe de symétrie.

Ex)

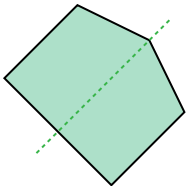

1)

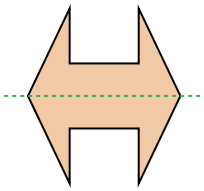

2)

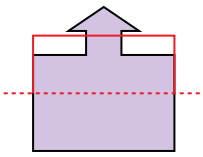

3)

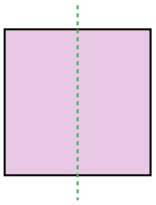

4)

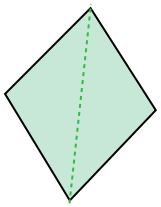

5)

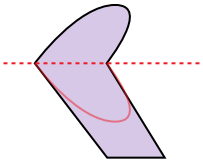

6)

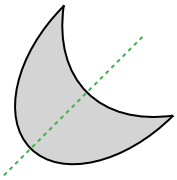

7)

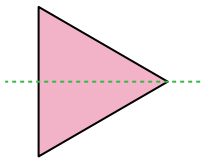

8)

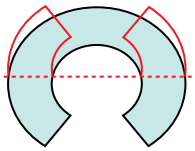

9)

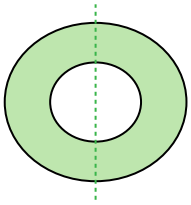

10)

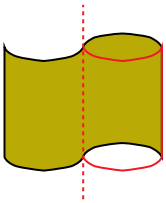

11)

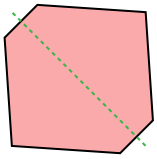

Réponses

Ex.	oui
1.	oui
2.	no
3.	oui
4.	oui
5.	no
6.	oui
7.	oui
8.	no
9.	oui
10.	no
11.	oui

1-10	91	82	73	64	55	45	36	27	18	9
11	0									