Déterminer la Symétrie

Nom:

Déterminez si la droite qui parcoure la figure est un axe de symétrie.

Ex)

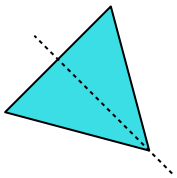

1)

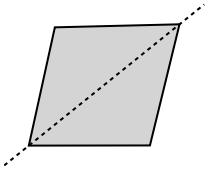

2)

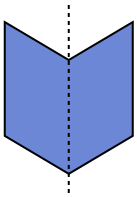

3)



4)

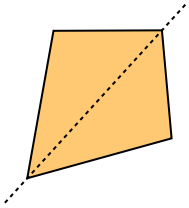

5)

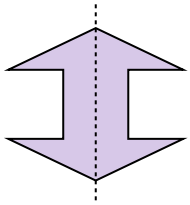

6)

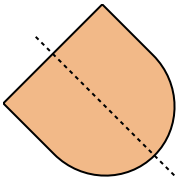

7)

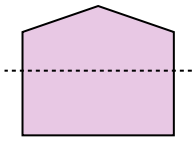

8)



9)

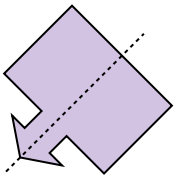

10)



11)

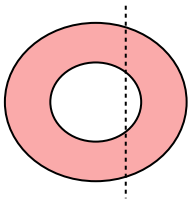

Réponses

Ex. **oui**

1. _____
2. _____
3. _____
4. _____
5. _____
6. _____
7. _____
8. _____
9. _____
10. _____
11. _____

Déterminer la Symétrie

Nom: **Clé**

Déterminez si la droite qui parcoure la figure est un axe de symétrie.

Ex)

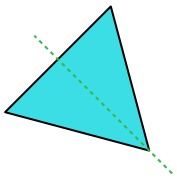

1)

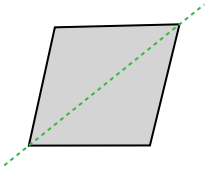

2)

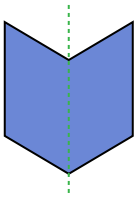

3)

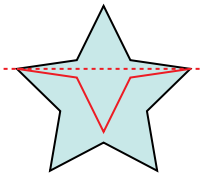

4)

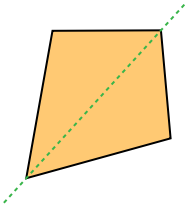

5)

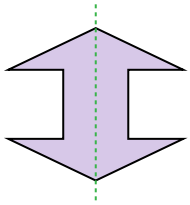

6)

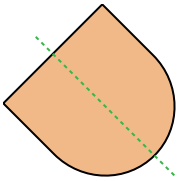

7)

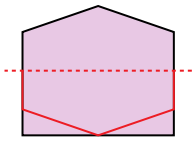

8)

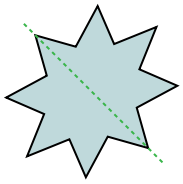

9)

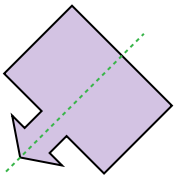

10)



11)

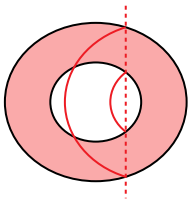

Réponses

Ex.	oui
1.	oui
2.	oui
3.	no
4.	oui
5.	oui
6.	oui
7.	no
8.	oui
9.	oui
10.	oui
11.	no