Trouver les différences de température Nom:

Déterminez la différence de température pour les thermomètres suivants.

1)

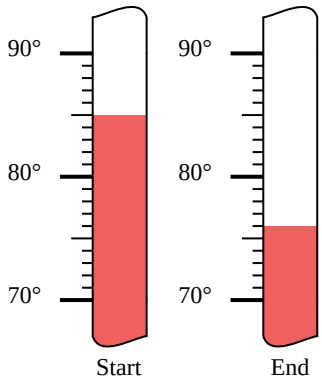

2)

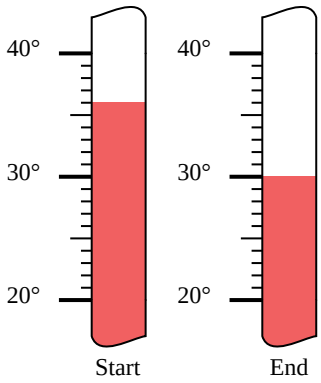

3)

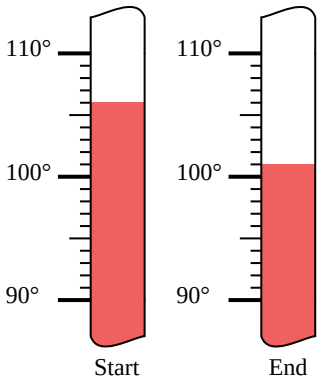

4)

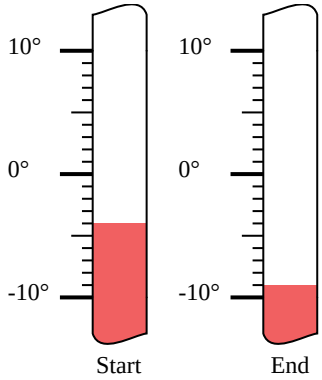

5)

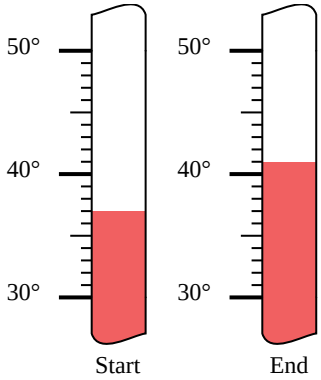

6)

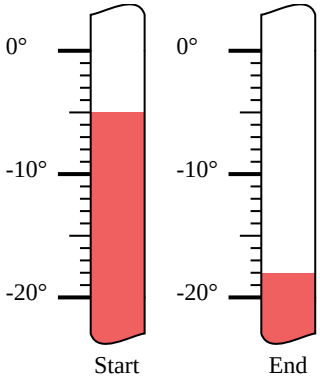

7)



8)

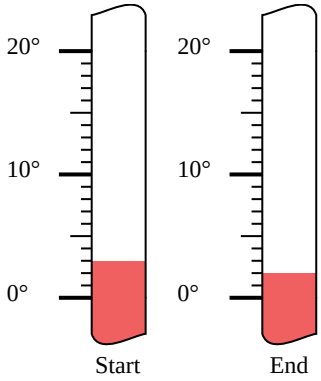

9)

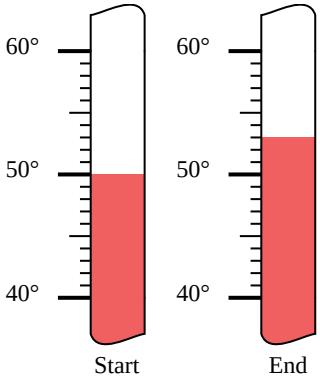

10)

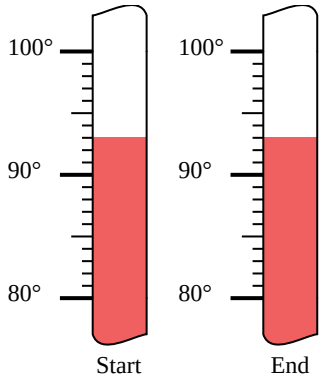

11)

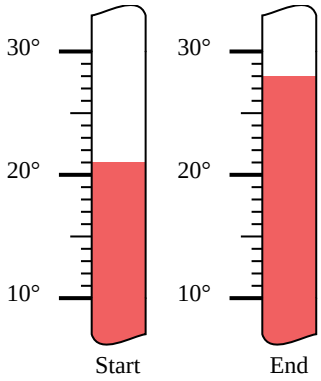

12)

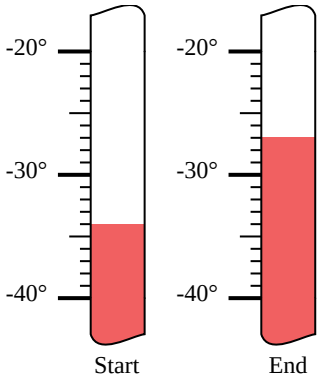

Réponses

1. _____
2. _____
3. _____
4. _____
5. _____
6. _____
7. _____
8. _____
9. _____
10. _____
11. _____
12. _____

1-10	92	83	75	67	58	50	42	33	25	17
11-12	8	0								

Trouver les différences de température Nom: **Clé**

Déterminez la différence de température pour les thermomètres suivants.

1)

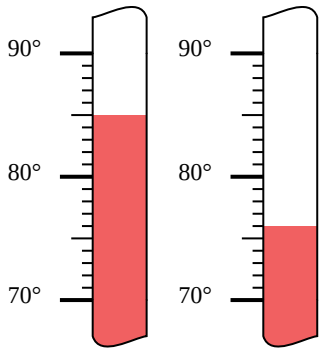

Start 85 End 76

2)

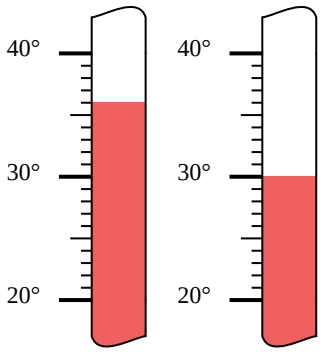

Start 36 End 30

3)

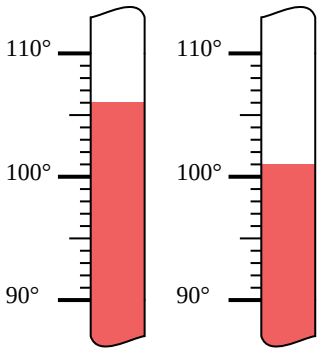

Start 106 End 101

4)

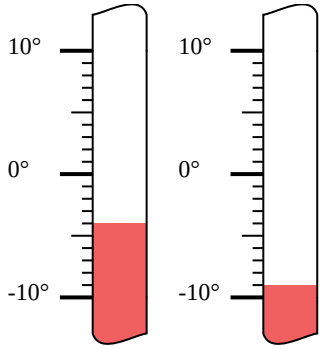

Start -4 End -9

5)

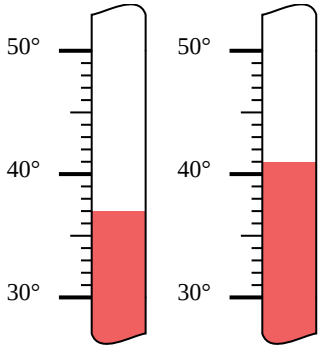

Start 37 End 41

6)

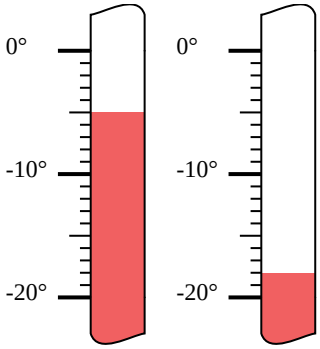

Start -5 End -18

7)

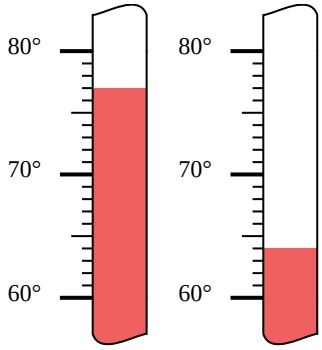

Start 77 End 64

8)

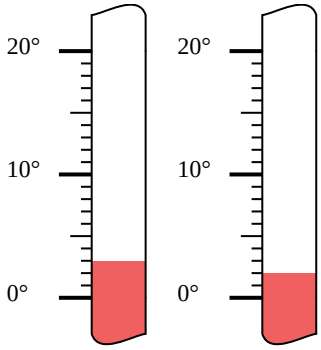

Start 3 End 2

9)

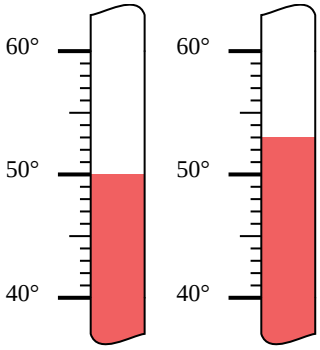

Start 50 End 53

10)

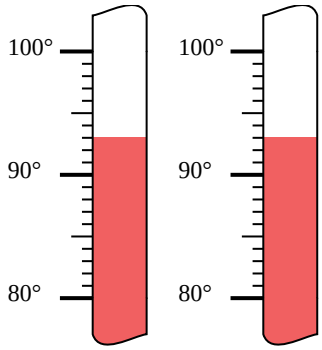

Start 93 End 93

11)

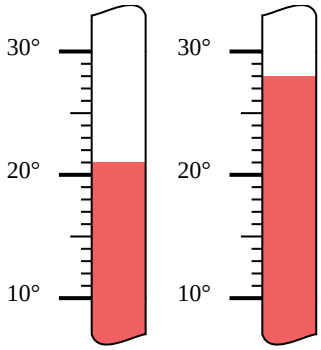

Start 21 End 28

12)

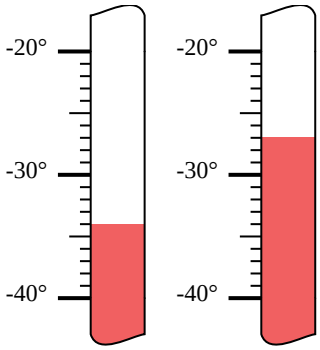

Start -34 End -27

Réponses

1. 9°
2. 6°
3. 5°
4. 5°
5. 4°
6. 13°
7. 13°
8. 1°
9. 3°
10. 0°
11. 7°
12. 7°

1-10	92	83	75	67	58	50	42	33	25	17
11-12	8	0								