Création d'horloges Nom:

**Dessinez l'aiguille des heures et des minutes sur l'horloge pour qu'elle représente l'heure indiquée.**

**1)** 11:30

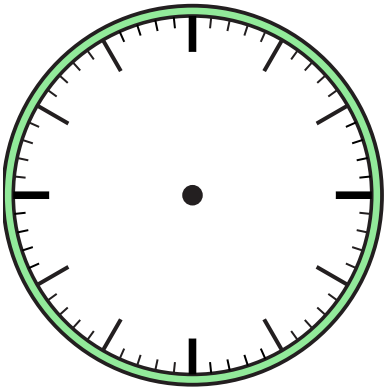

**2)** 7:00

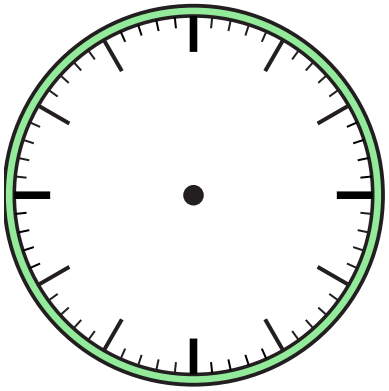

**3)** 8:00

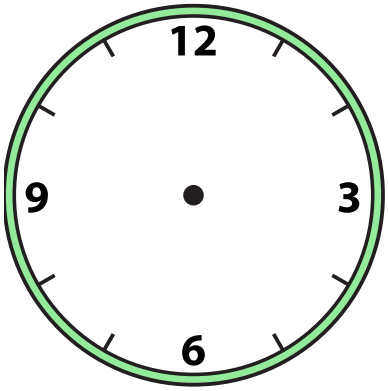


**4)** 10:00

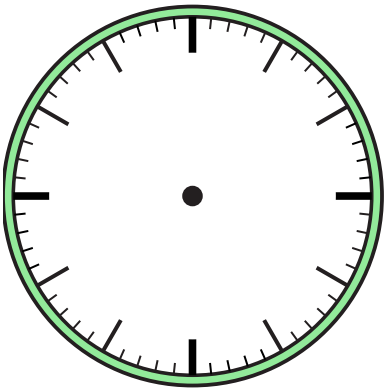

**5)** 2:30

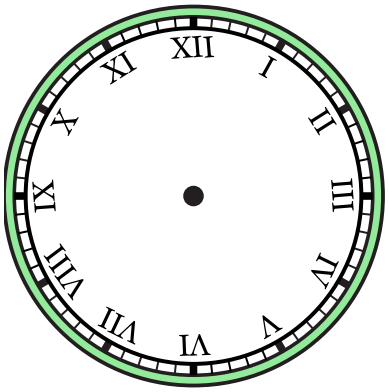


**6)** 2:00

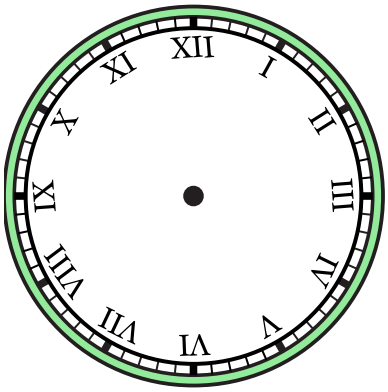


**7)** 12:30

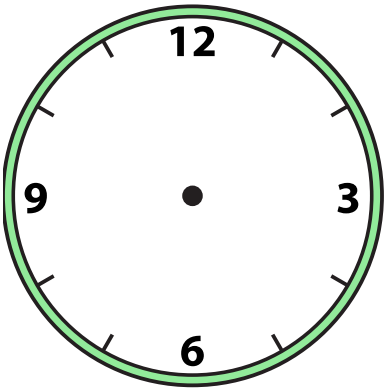


**8)** 4:00

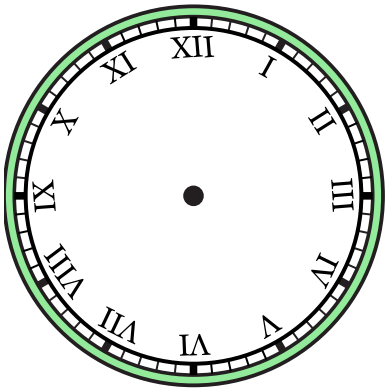


**9)** 12:30

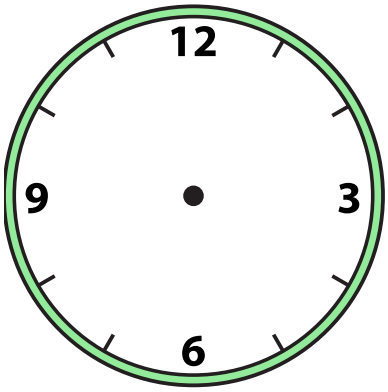




| 1-9 | 89 | 78 | 67 | 56 | 44 | 33 | 22 | 11 | 0 |
|---|---|---|---|---|---|---|---|---|---|

Création d'horloges Nom: **Clé**

**Dessinez l'aiguille des heures et des minutes sur l'horloge pour qu'elle représente l'heure indiquée.**

**1)** 11:30

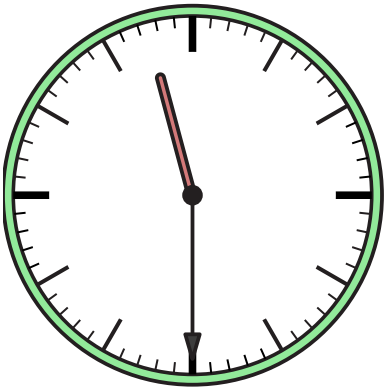

**2)** 7:00

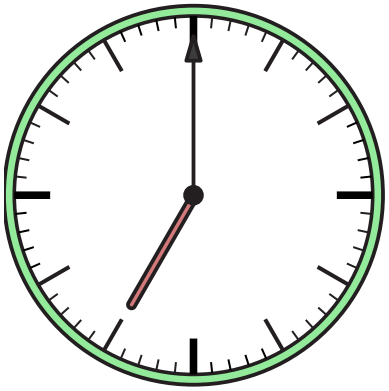

**3)** 8:00




**4)** 10:00

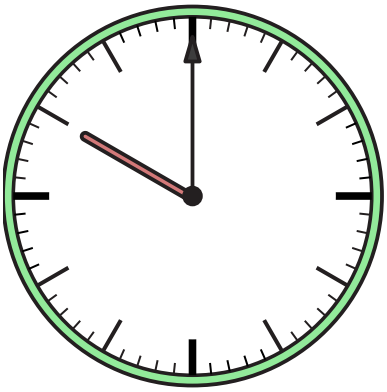

**5)** 2:30

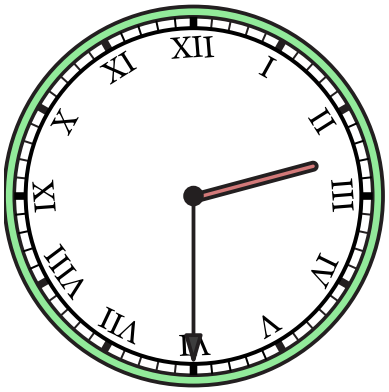


**6)** 2:00




**7)** 12:30




**8)** 4:00




**9)** 12:30






| 1-9 | 89 | 78 | 67 | 56 | 44 | 33 | 22 | 11 | 0 |
|---|---|---|---|---|---|---|---|---|---|