Dessinez l'aiguille des heures et des minutes sur l'horloge pour qu'elle représente l'heure indiquée.

1) 2:56

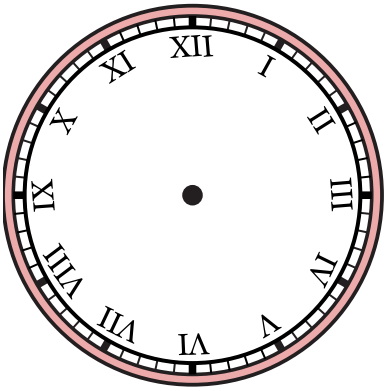

2) 2:20

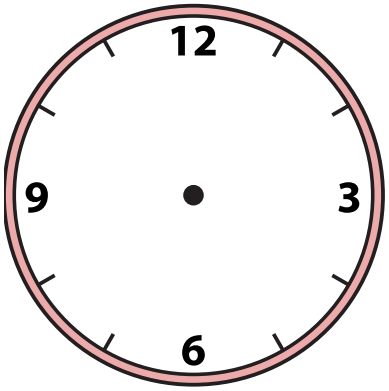

3) 8:01

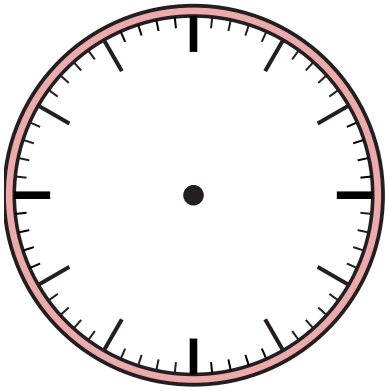

4) 4:27

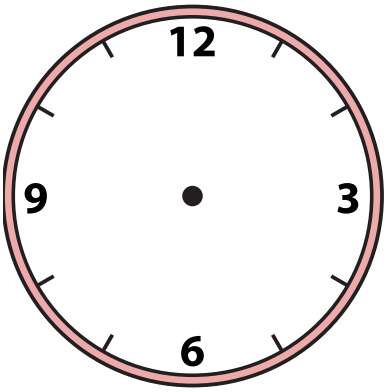

5) 10:52

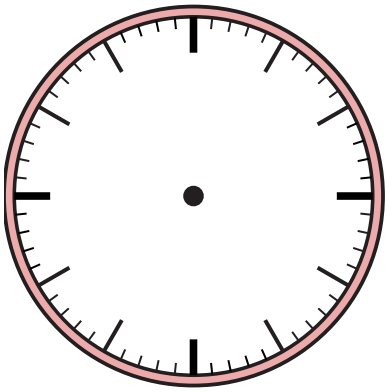

6) 11:24

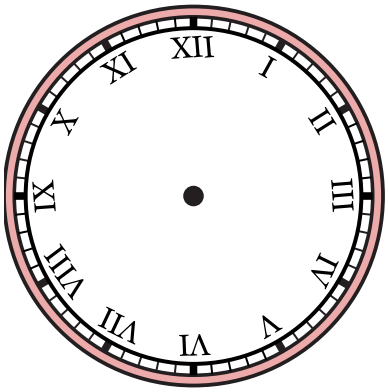

7) 4:22

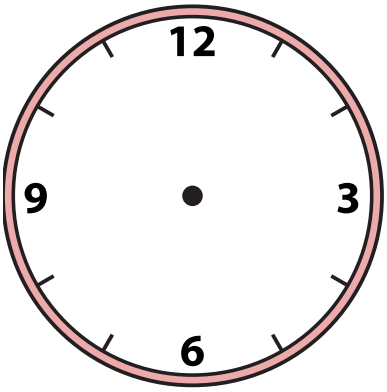

8) 5:44

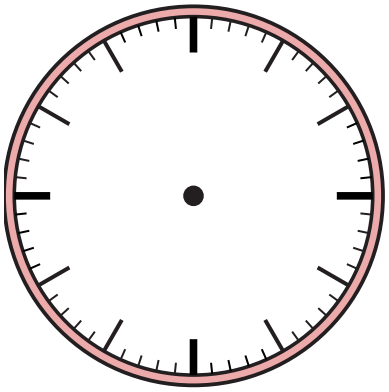

9) 12:25

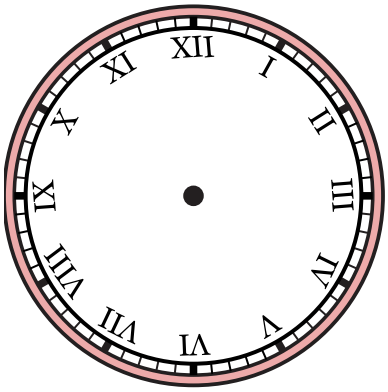

1-9	89	78	67	56	44	33	22	11	0

Dessinez l'aiguille des heures et des minutes sur l'horloge pour qu'elle représente l'heure indiquée.

1) 2:56



2) 2:20



3) 8:01



4) 4:27



5) 10:52

6) 11:24



7) 4:22



8) 5:44

9) 12:25



1-9	89	78	67	56	44	33	22	11	0