Dessinez l'aiguille des heures et des minutes sur l'horloge pour qu'elle représente l'heure indiquée.

1) 1:37

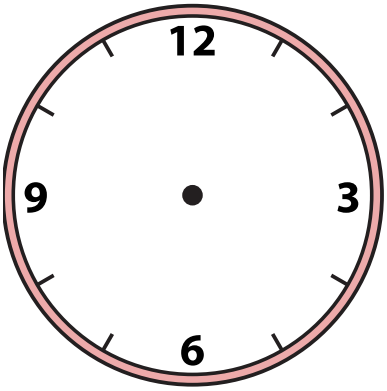

2) 8:21

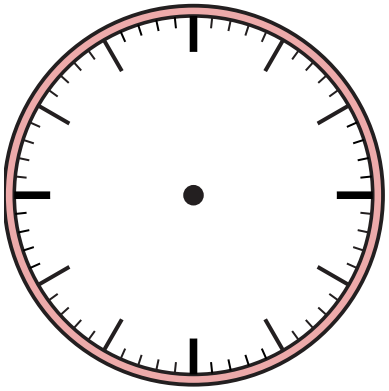

3) 1:12

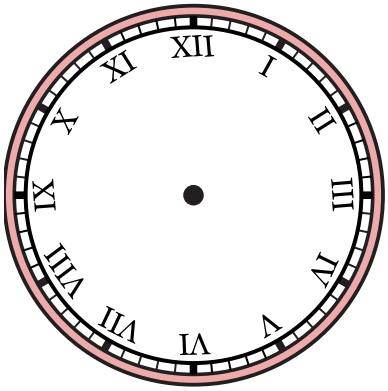

4) 12:42

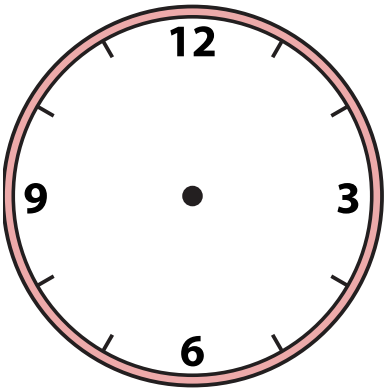

5) 4:16

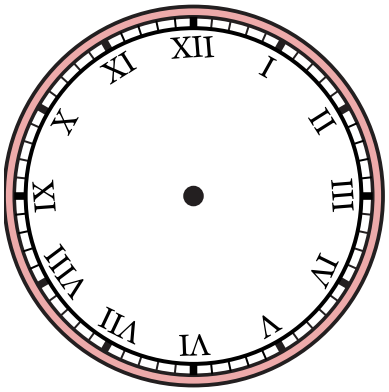

6) 10:18

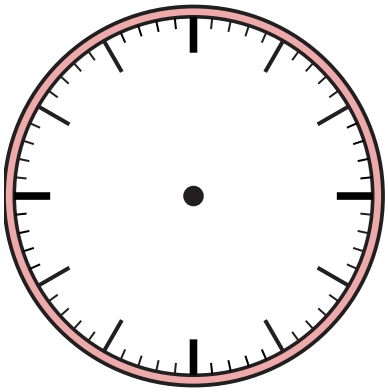

7) 6:57

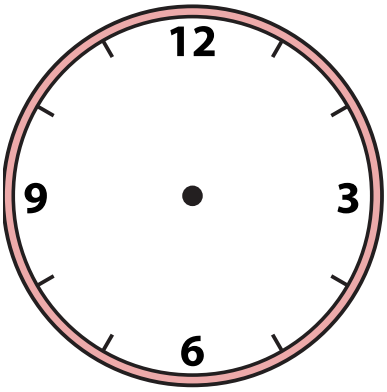

8) 2:58

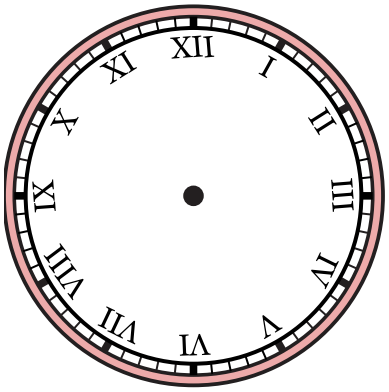

9) 4:29

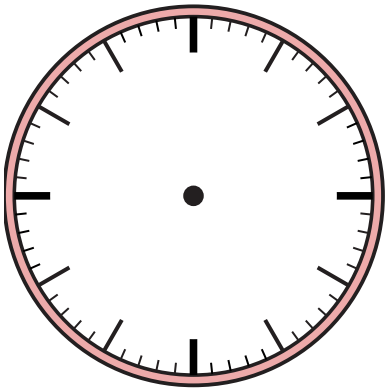

1-9	89	78	67	56	44	33	22	11	0

Dessinez l'aiguille des heures et des minutes sur l'horloge pour qu'elle représente l'heure indiquée.

1) 1:37



2) 8:21



3) 1:12



4) 12:42



5) 4:16

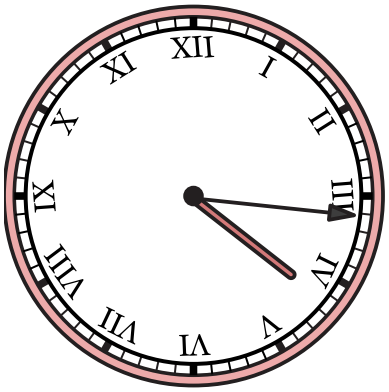

6) 10:18



7) 6:57



8) 2:58

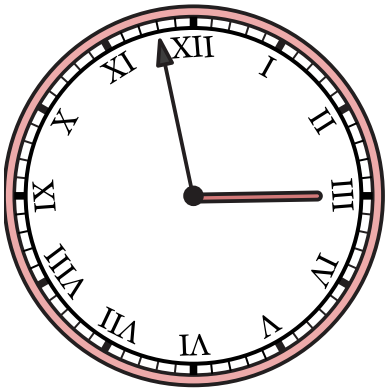

9) 4:29



1-9	89	78	67	56	44	33	22	11	0