Dessinez l'aiguille des heures et des minutes sur l'horloge pour qu'elle représente l'heure indiquée.

1) 3:04

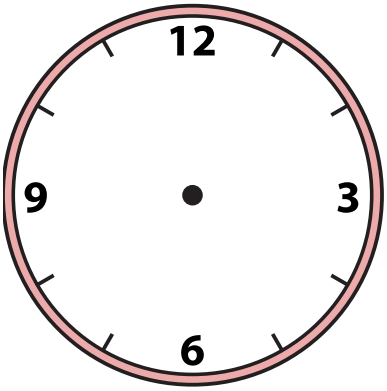

2) 10:24

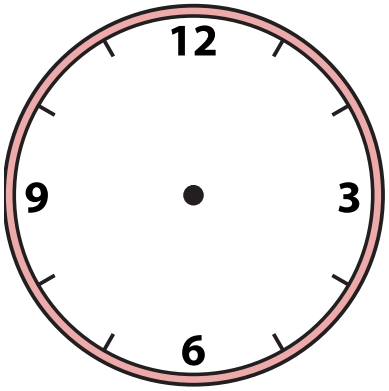

3) 5:57

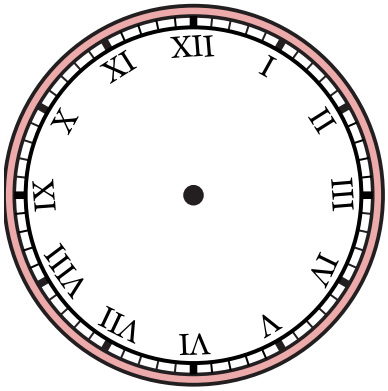

4) 7:54

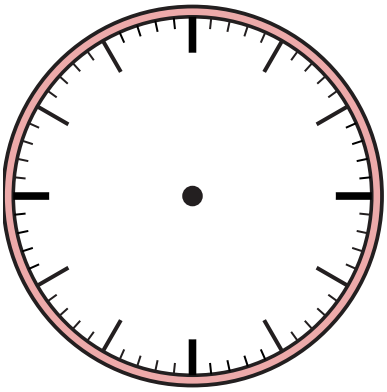

5) 10:12

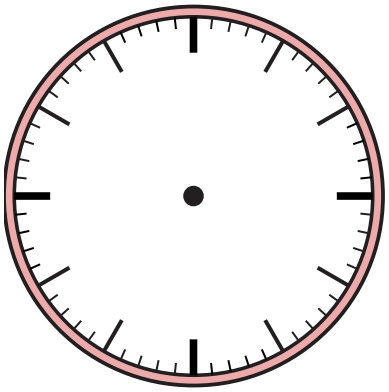

6) 2:29

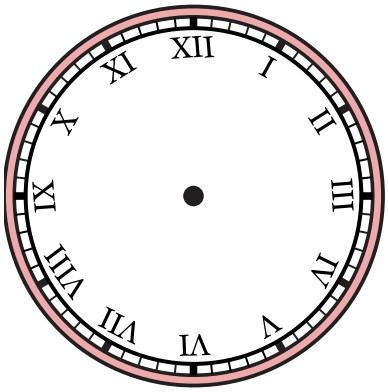

7) 7:00

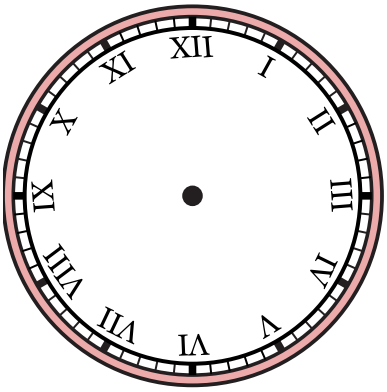

8) 9:28

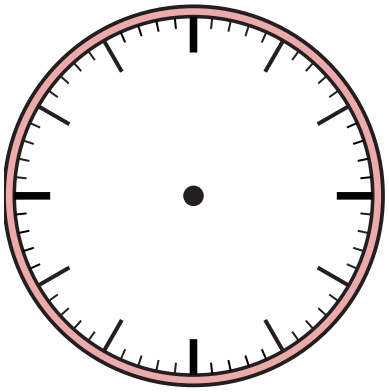

9) 1:13

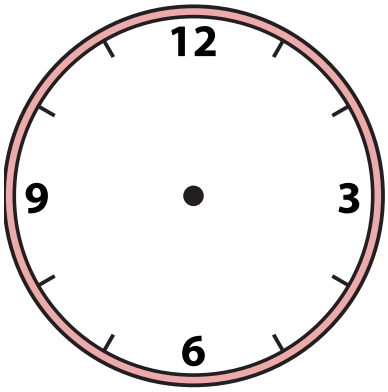

1-9	89	78	67	56	44	33	22	11	0

Dessinez l'aiguille des heures et des minutes sur l'horloge pour qu'elle représente l'heure indiquée.

1) 3:04



2) 10:24



3) 5:57

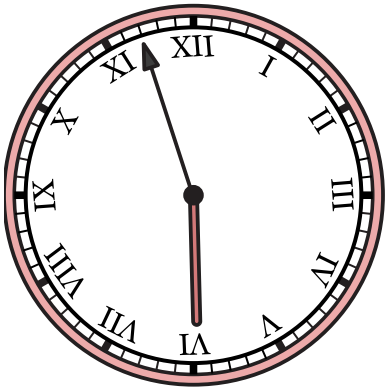

4) 7:54



5) 10:12



6) 2:29



7) 7:00

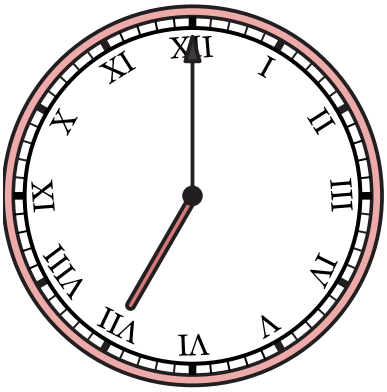

8) 9:28



9) 1:13



1-9	89	78	67	56	44	33	22	11	0