Dessinez l'aiguille des heures et des minutes sur l'horloge pour qu'elle représente l'heure indiquée.

1) 2:55

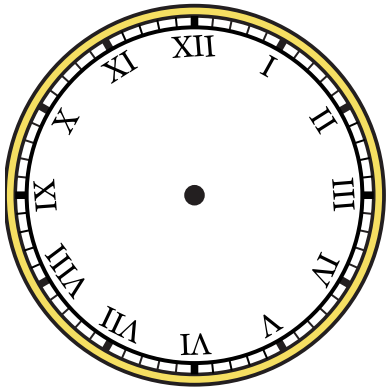

2) 2:20

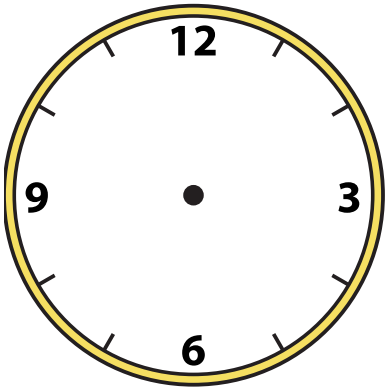

3) 8:00



4) 4:25

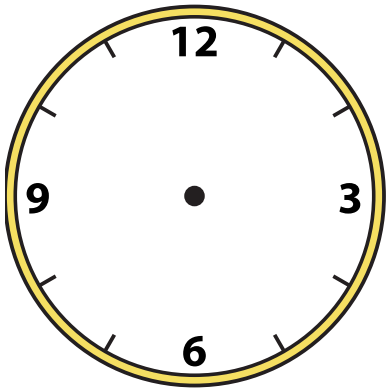

5) 10:50



6) 11:20

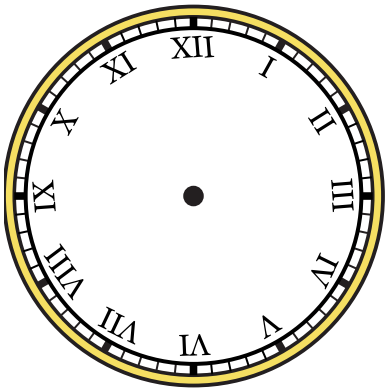

7) 4:20

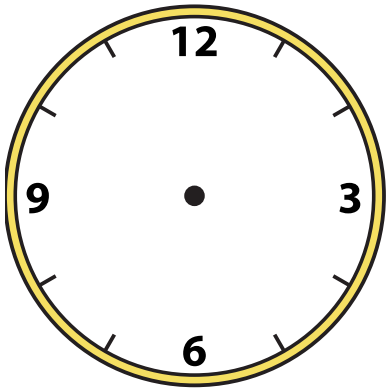

8) 5:40



9) 12:25

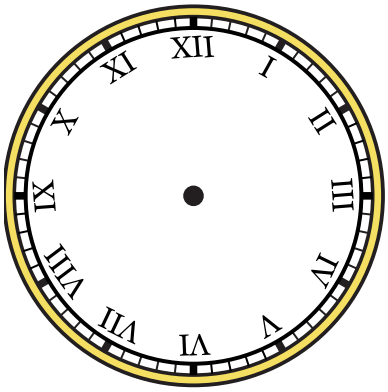

1-9	89	78	67	56	44	33	22	11	0

Dessinez l'aiguille des heures et des minutes sur l'horloge pour qu'elle représente l'heure indiquée.

1) 2:55



2) 2:20



3) 8:00

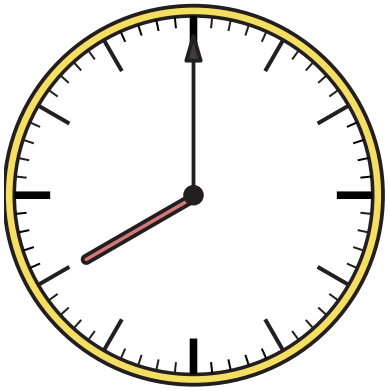

4) 4:25



5) 10:50

6) 11:20



7) 4:20



8) 5:40

9) 12:25



1-9	89	78	67	56	44	33	22	11	0