Dessinez l'aiguille des heures et des minutes sur l'horloge pour qu'elle représente l'heure indiquée.

1) 3:00

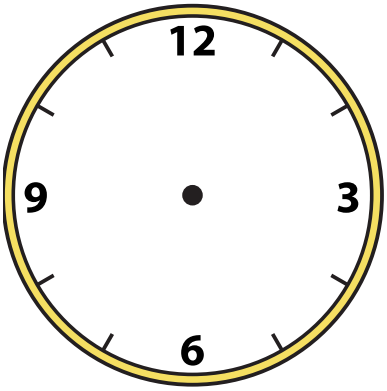

2) 10:20

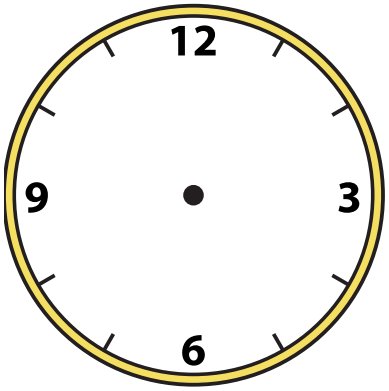

3) 5:55

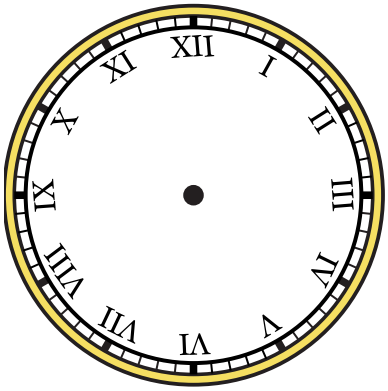

4) 7:50



5) 10:10



6) 2:25

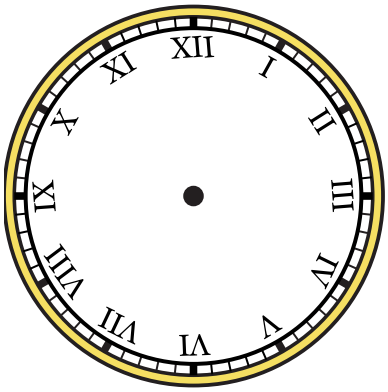

7) 7:00

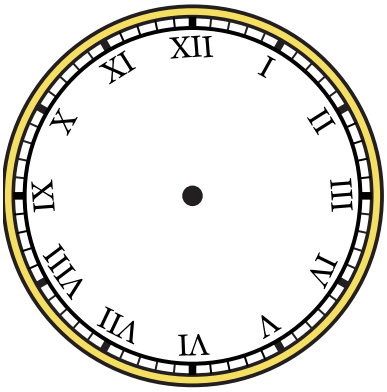

8) 9:25



9) 1:10

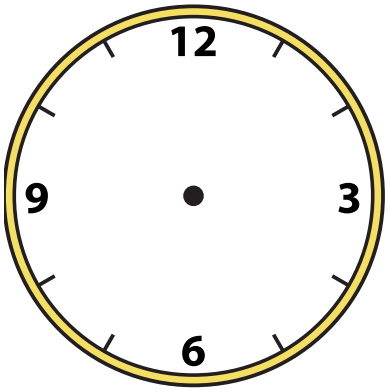

1-9	89	78	67	56	44	33	22	11	0

Création d'horloges Nom: **Clé**

Dessinez l'aiguille des heures et des minutes sur l'horloge pour qu'elle représente l'heure indiquée.

1) 3:00



2) 10:20



3) 5:55

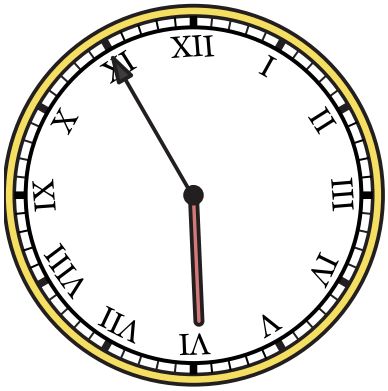

4) 7:50

5) 10:10



6) 2:25



7) 7:00

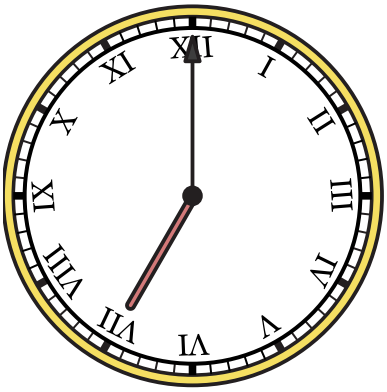

8) 9:25

9) 1:10