Lire une horloge analogique

Nom:

Déterminez l'heure indiquée sur l'horloge.

1) 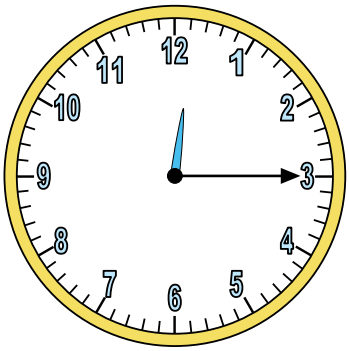

2) 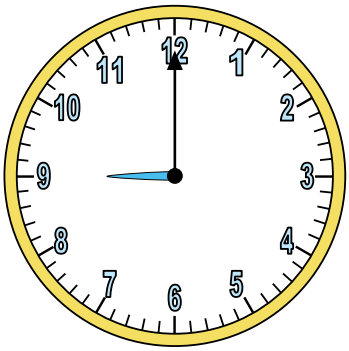

3) 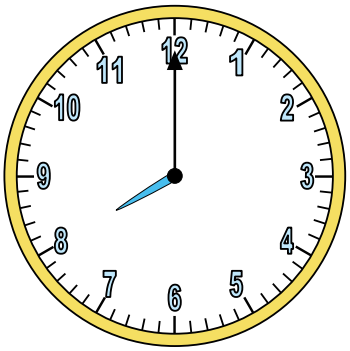

4) 

5) 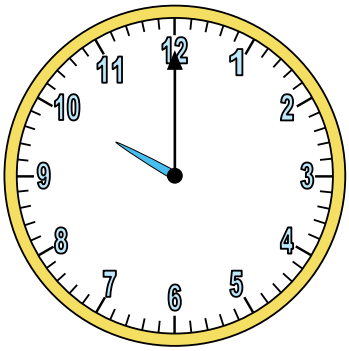

6) 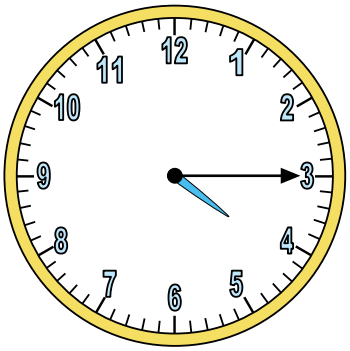

7) 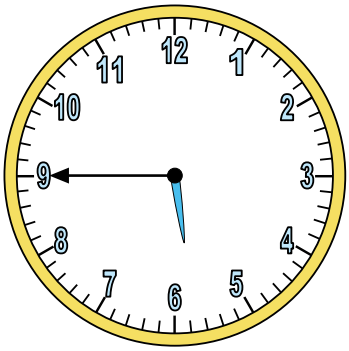

8) 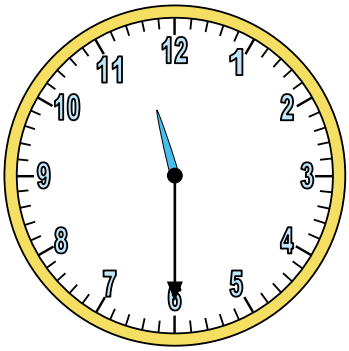

9) 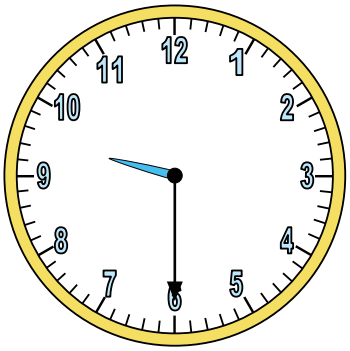

10) 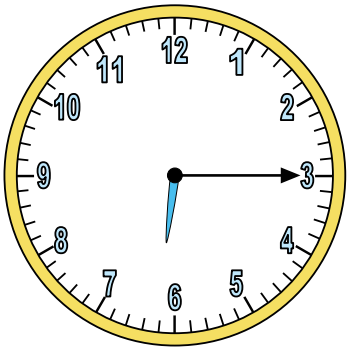

11) 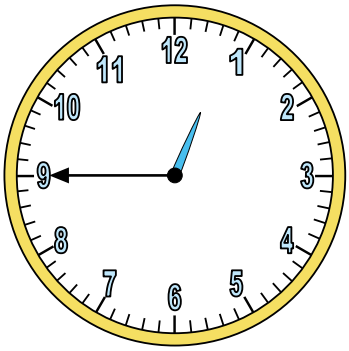

12) 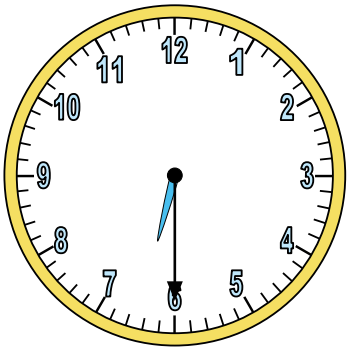

Réponses

1. _____
2. _____
3. _____
4. _____
5. _____
6. _____
7. _____
8. _____
9. _____
10. _____
11. _____
12. _____

1-10	92	83	75	67	58	50	42	33	25	17
11-12	8	0								

Lire une horloge analogique

Nom: **Clé**

Déterminez l'heure indiquée sur l'horloge.

1) 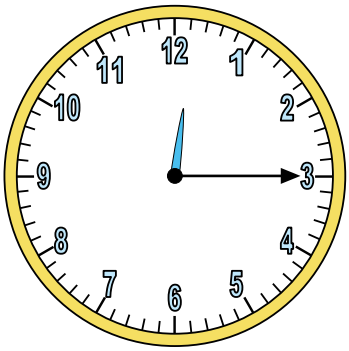

2) 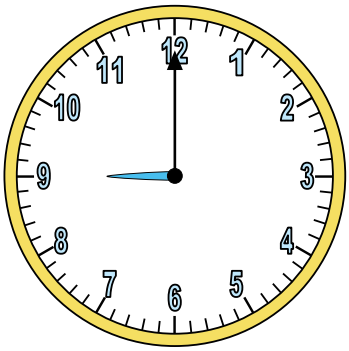

3) 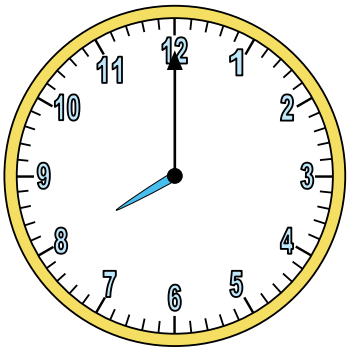

4) 

5) 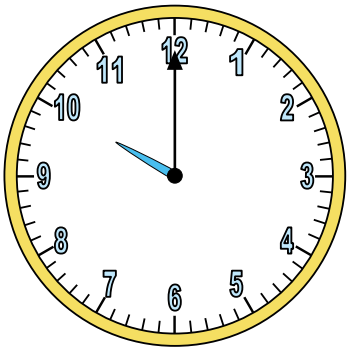

6) 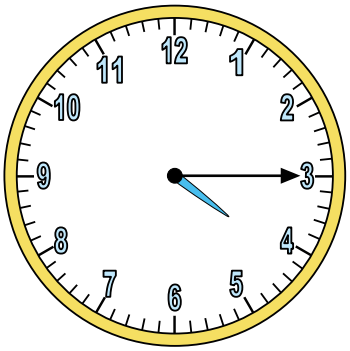

7) 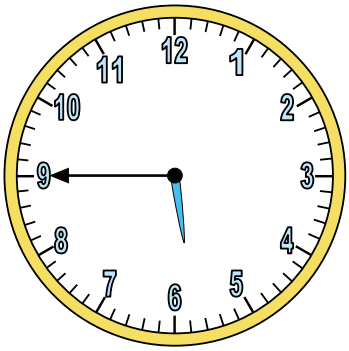

8) 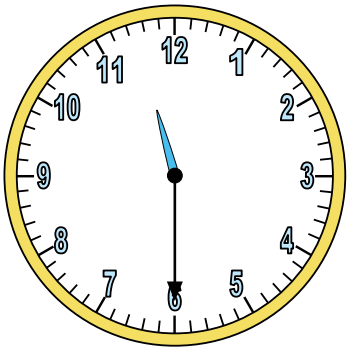

9) 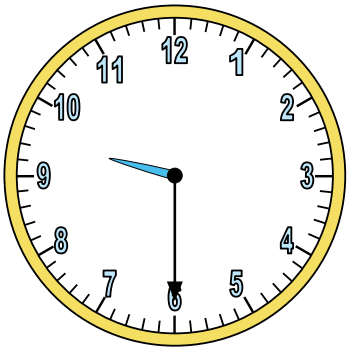

10) 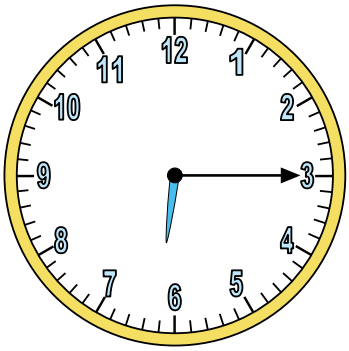

11) 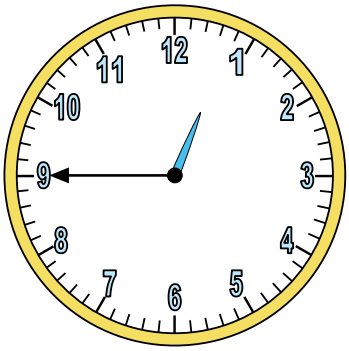

12) 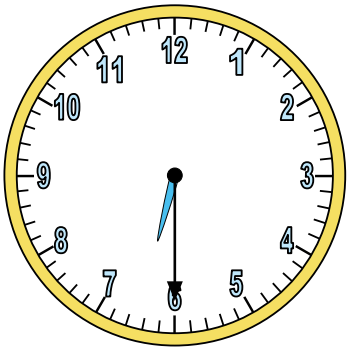

Réponses

1. 12:15
2. 9:00
3. 8:00
4. 2:00
5. 10:00
6. 4:15
7. 5:45
8. 11:30
9. 9:30
10. 6:15
11. 12:45
12. 6:30

1-10	92	83	75	67	58	50	42	33	25	17
11-12	8	0								