Compter des Figures Nom:

Comptez le nombre de figure de chaque boîte.



Ex) = 2

1) = _____

2) = _____

3) = _____



4) = _____

5) = _____

6) = _____

7) = _____

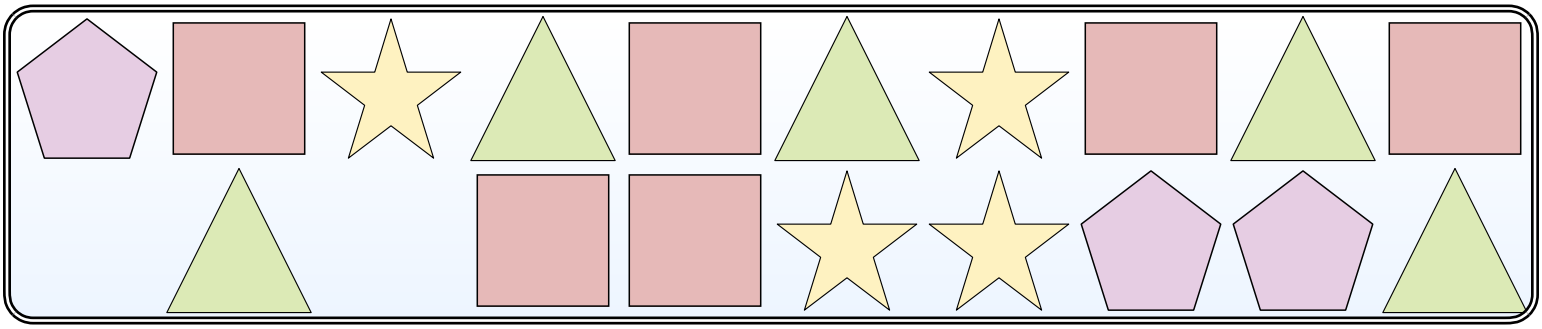

8) 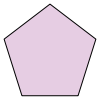 = _____

9) = _____

10) = _____

11) = _____

1-10	91	82	73	64	55	45	36	27	18	9
11	0									

Compter des Figures Nom: **Clé**

Comptez le nombre de figure de chaque boîte.



Ex) = 2

1) = 7

2) = 6

3) = 5



4) = 8

5) = 2

6) = 2

7) = 3

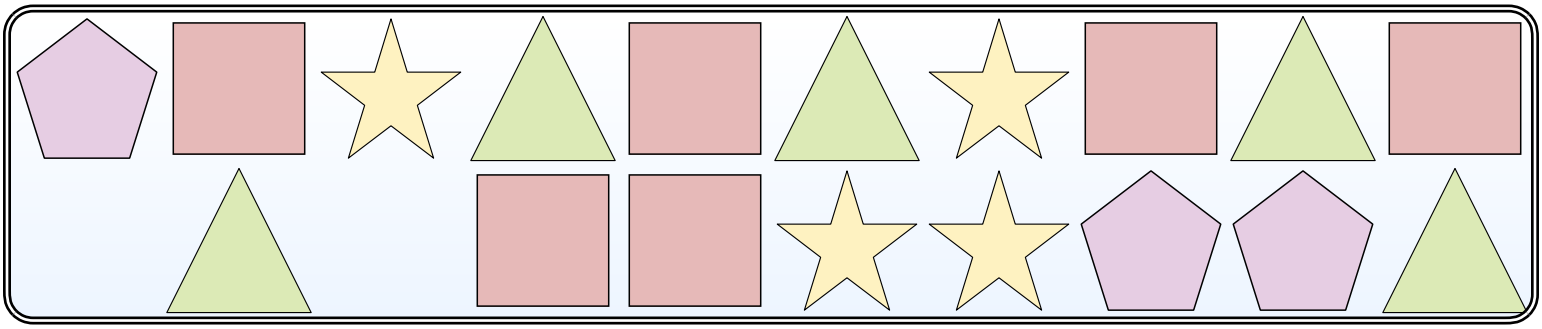

8) 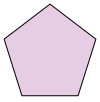 = 3

9) = 6

10) = 4

11) = 5

1-10	91	82	73	64	55	45	36	27	18	9
11	0									