Création de groupes de 100

Nom:

Déterminez combien de groupes de 100 peuvent être créés à partir des blocs affichés.

Ex)

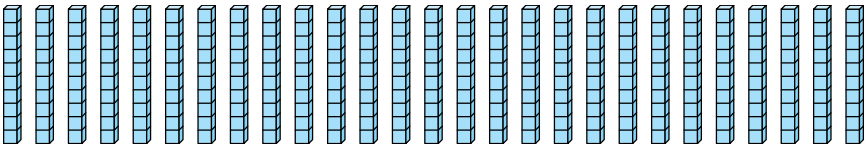

1)

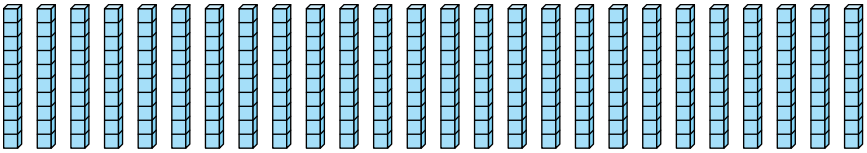

2)

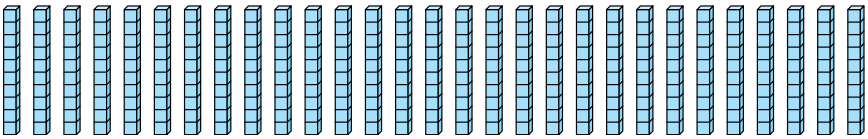

3)

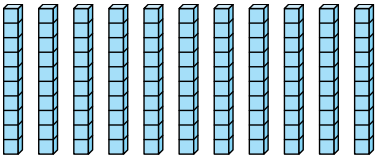

4)

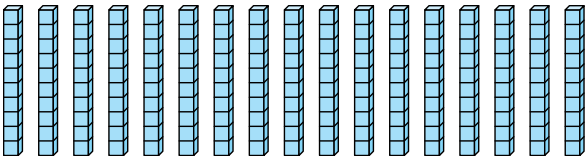

5)

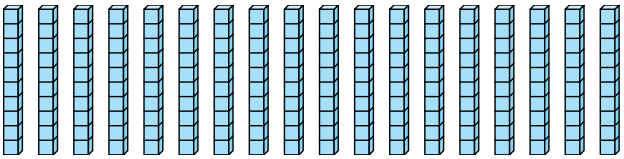

6)

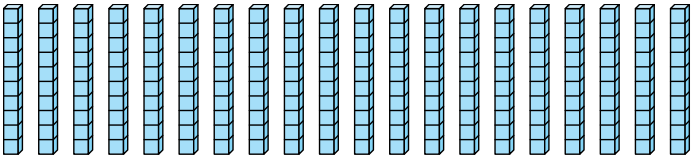

7)

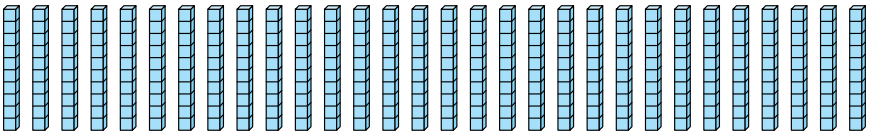

8)

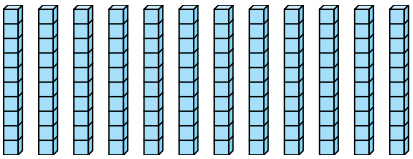

9)

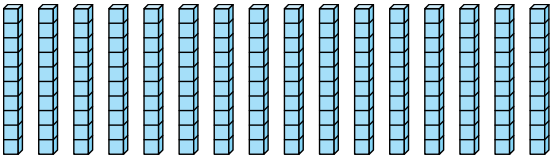

Réponses

Ex. 2

1. _____
2. _____
3. _____
4. _____
5. _____
6. _____
7. _____
8. _____
9. _____

1-9	89	78	67	56	44	33	22	11	0

Création de groupes de 100

Nom: **Clé**

Déterminez combien de groupes de 100 peuvent être créés à partir des blocs affichés.

Ex)

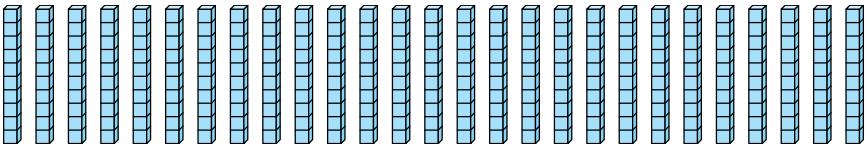

1)

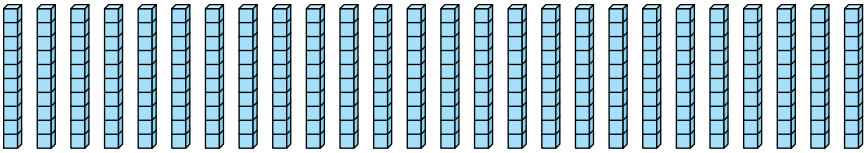

2)

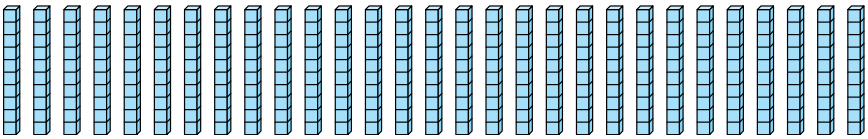

3)

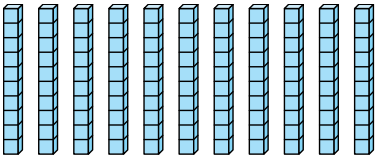

4)

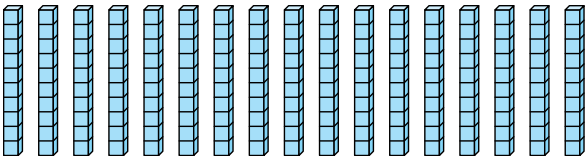

5)

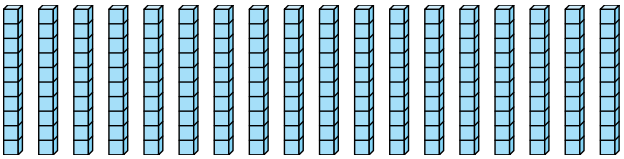

6)

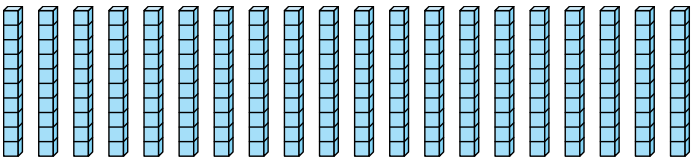

7)

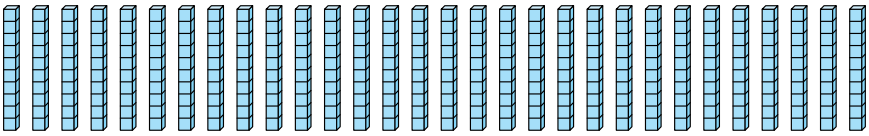

8)

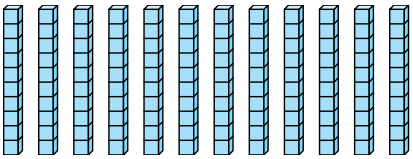

9)

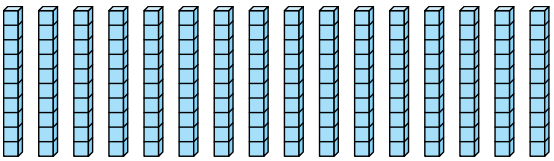

Réponses

Ex.	2
1.	2
2.	2
3.	1
4.	1
5.	1
6.	2
7.	3
8.	1
9.	1

1-9	89	78	67	56	44	33	22	11	0