# Ecrire des Inégalités à partir d'une Droite Numérique

Nom:

**Ecrivez une inégalité à partir d'une droite numérique.**

**Ex)**

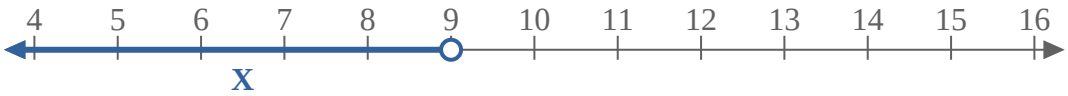


**1)**

**2)**

**3)**

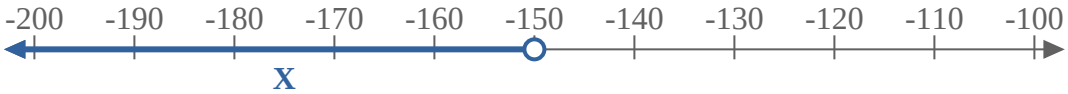


**4)**

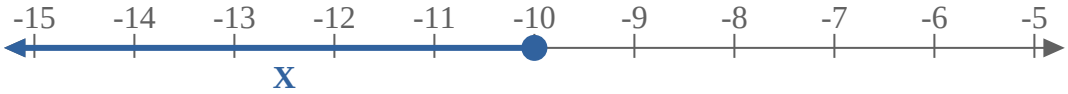


**5)**

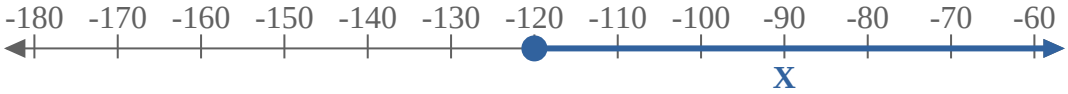


**6)**

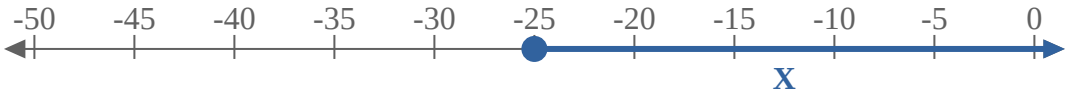


**7)**

**8)**

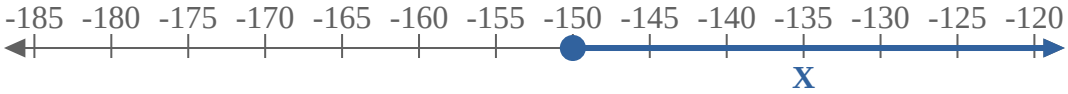


**9)**

**10)**

**11)**

**12)**

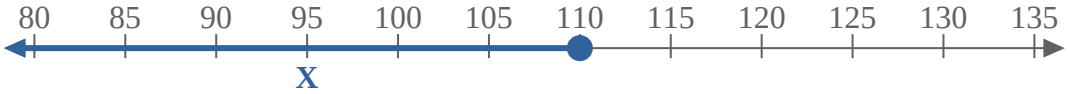


**13)**

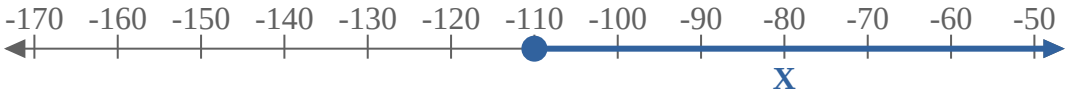


## Réponses

Ex. X < 9

1. _____
2. _____
3. _____
4. _____
5. _____
6. _____
7. _____
8. _____
9. _____
10. _____
11. _____
12. _____
13. _____



| | | | | | | | | | | |
|---|---|---|---|---|---|---|---|---|---|---|
| 1-10 | 92 | 85 | 77 | 69 | 62 | 54 | 46 | 38 | 31 | 23 |
| 11-13 | 15 | 8 | 0 | | | | | | | |

Ecrire des Inégalités à partir d'une Droite Numérique Nom: **Clé**

**Ecrivez une inégalité à partir d'une droite numérique.**

**Ex)**

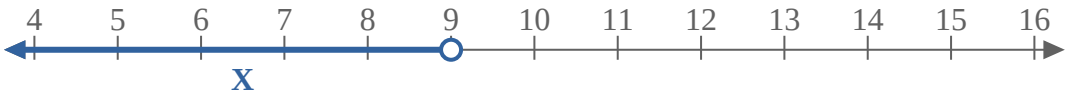


**1)**

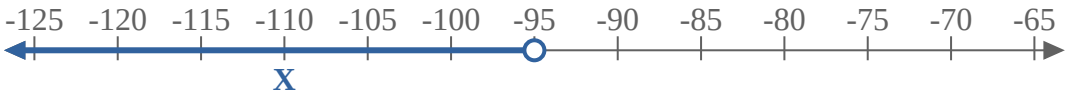


**2)**

**3)**

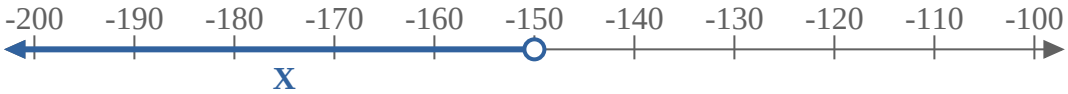


**4)**

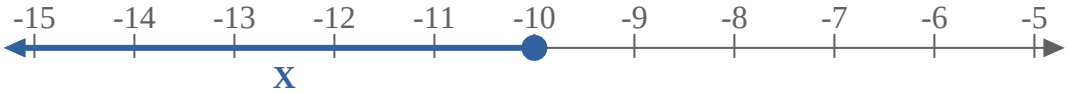


**5)**

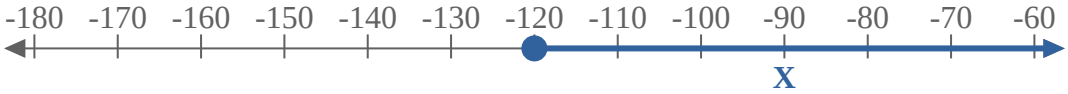


**6)**

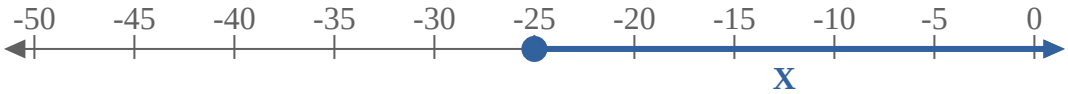


**7)**

**8)**

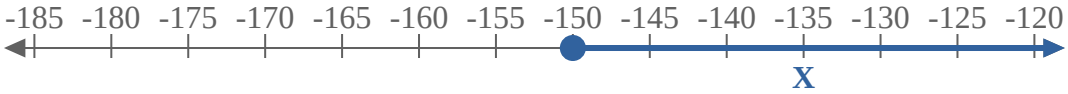


**9)**

**10)**

**11)**

**12)**

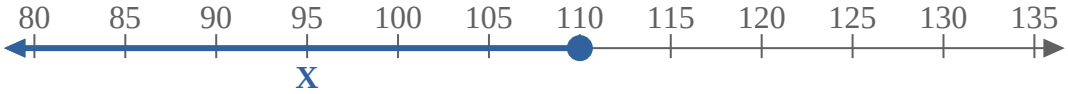


**13)**

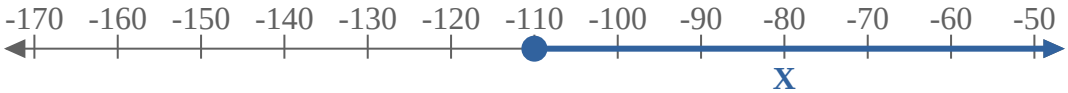


## Réponses

| | |
|---|---|
| Ex. | X < 9 |
| 1. | X < -95 |
| 2. | X ≤ -150 |
| 3. | X < -150 |
| 4. | X ≤ -10 |
| 5. | X ≥ -120 |
| 6. | X ≥ -25 |
| 7. | X < -180 |
| 8. | X ≥ -150 |
| 9. | X > -40 |
| 10. | X > 5 |
| 11. | X ≥ -160 |
| 12. | X ≤ 110 |
| 13. | X ≥ -110 |