Comptage Visuel (Inférieur à 20) Nom:

Remplir les blancs pour trouver les montants.

Ex)

0 4

dizaines unités

1)

dizaines unités

2)

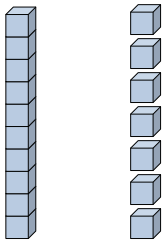

dizaines unités

3)

dizaines unités

4)

dizaines unités

5)

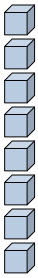

dizaines unités

6)

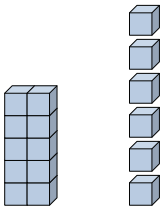

dizaines unités

7)

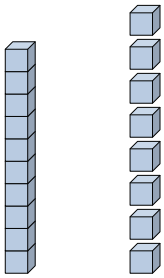

dizaines unités

8)

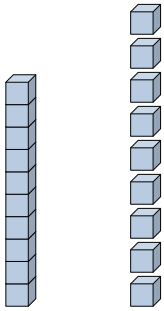

dizaines unités

9)

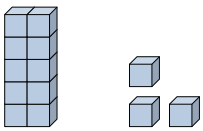

dizaines unités

10)

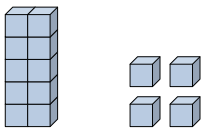

dizaines unités

11)

dizaines unités

Réponses

Ex. 4

1. _____
2. _____
3. _____
4. _____
5. _____
6. _____
7. _____
8. _____
9. _____
10. _____
11. _____

1-10	91	82	73	64	55	45	36	27	18	9
11	0									

Comptage Visuel (Inférieur à 20) Nom: **Clé**

Remplir les blancs pour trouver les montants.

Ex)

0 dizaines 4 unités

1)

0 dizaines 9 unités

2)

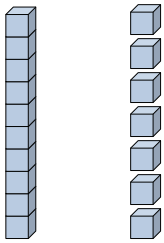

1 dizaines 7 unités

3)

0 dizaines 1 unités

4)

0 dizaines 5 unités

5)

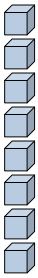

0 dizaines 8 unités

6)

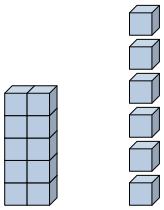

1 dizaines 6 unités

7)

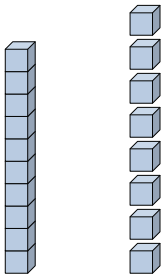

1 dizaines 8 unités

8)

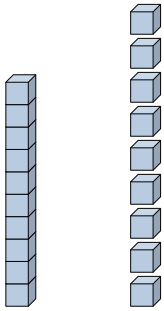

1 dizaines 9 unités

9)

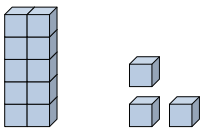

1 dizaines 3 unités

10)

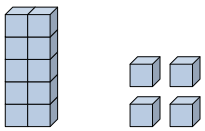

1 dizaines 4 unités

11)

0 dizaines 2 unités

Réponses

Ex.	4
1.	9
2.	17
3.	1
4.	5
5.	8
6.	16
7.	18
8.	19
9.	13
10.	14
11.	2

1-10	91	82	73	64	55	45	36	27	18	9
11	0									